Surface Area & Volume of Prisms (Mixed Review) · 1

Find the volume of a rectangular prism with length 4, width 4, and height 4.

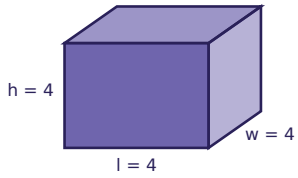

Surface Area & Volume of Prisms (Mixed Review) · 2

Find the surface area of a rectangular prism with length 5, width 3, and height 2.

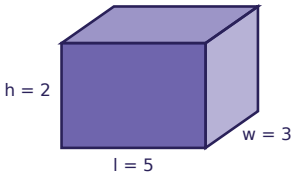

Surface Area & Volume of Prisms (Mixed Review) · 3

Find the volume of a triangular prism with a triangular base of base 3 and height 2, and a prism length of 3.

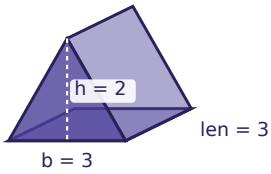

Surface Area & Volume of Prisms (Mixed Review) · 4

Find the volume of a rectangular prism with length 2, width 4, and height 4.

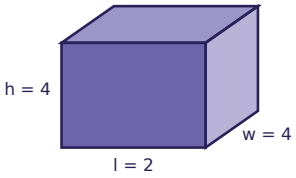

Surface Area & Volume of Prisms (Mixed Review) · 5

Find the surface area of a rectangular prism with length 4, width 3, and height 4.

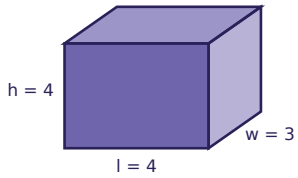

Surface Area & Volume of Prisms (Mixed Review) · 6

Find the volume of a triangular prism with a triangular base of base 3 and height 2, and a prism length of 4.

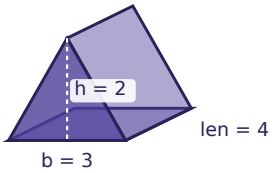

Surface Area & Volume of Prisms (Mixed Review) · 7

Find the volume of a rectangular prism with length 2, width 2, and height 2.

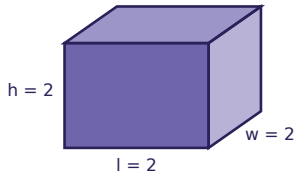

Surface Area & Volume of Prisms (Mixed Review) · 8

Find the surface area of a rectangular prism with length 3, width 2, and height 3.

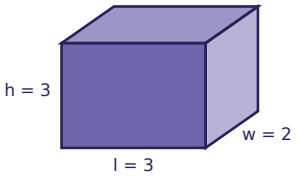

Surface Area & Volume of Prisms (Mixed Review) · 2

ANSWER

62

Surface Area & Volume of Prisms (Mixed Review) · 1

ANSWER

64

Surface Area & Volume of Prisms (Mixed Review) · 4

ANSWER

32

Surface Area & Volume of Prisms (Mixed Review) · 3

ANSWER

9

Surface Area & Volume of Prisms (Mixed Review) · 6

ANSWER

12

Surface Area & Volume of Prisms (Mixed Review) · 5

ANSWER

80

Surface Area & Volume of Prisms (Mixed Review) · 8

ANSWER

42

Surface Area & Volume of Prisms (Mixed Review) · 7

ANSWER

8

Surface Area & Volume of Prisms (Mixed Review) · 9

Find the volume of a rectangular prism with length 5, width 6, and height 2.

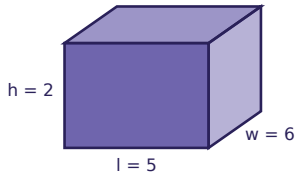

Surface Area & Volume of Prisms (Mixed Review) · 10

Find the surface area of a rectangular prism with length 3, width 4, and height 4.

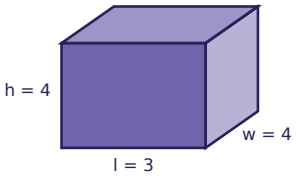

Surface Area & Volume of Prisms (Mixed Review) · 11

Find the volume of a triangular prism with a triangular base of base 6 and height 2, and a prism length of 2.

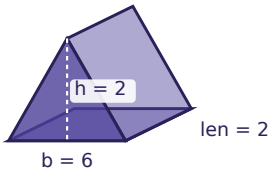

Surface Area & Volume of Prisms (Mixed Review) · 12

Find the volume of a rectangular prism with length 2, width 5, and height 3.

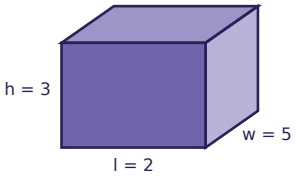

Surface Area & Volume of Prisms (Mixed Review) · 13

Find the surface area of a rectangular prism with length 6, width 3, and height 3.

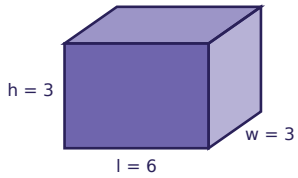

Surface Area & Volume of Prisms (Mixed Review) · 14

Find the volume of a triangular prism with a triangular base of base 5 and height 2, and a prism length of 4.

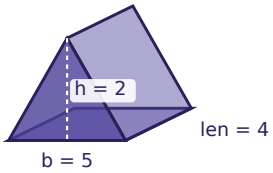

Surface Area & Volume of Prisms (Mixed Review) · 15

Find the volume of a rectangular prism with length 5, width 5, and height 3.

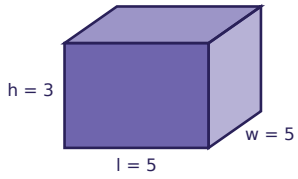

Surface Area & Volume of Prisms (Mixed Review) · 16

Find the surface area of a rectangular prism with length 2, width 4, and height 3.

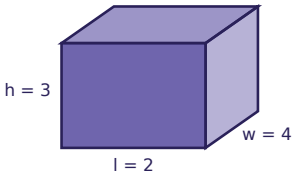

Surface Area & Volume of Prisms (Mixed Review) · 10

ANSWER

80

Surface Area & Volume of Prisms (Mixed Review) · 9

ANSWER

60

Surface Area & Volume of Prisms (Mixed Review) · 12

ANSWER

30

Surface Area & Volume of Prisms (Mixed Review) · 11

ANSWER

12

Surface Area & Volume of Prisms (Mixed Review) · 14

ANSWER

20

Surface Area & Volume of Prisms (Mixed Review) · 13

ANSWER

90

Surface Area & Volume of Prisms (Mixed Review) · 16

ANSWER

52

Surface Area & Volume of Prisms (Mixed Review) · 15

ANSWER

75

Surface Area & Volume of Prisms (Mixed Review) · 17

Find the volume of a rectangular prism with length 2, width 2, and height 7.

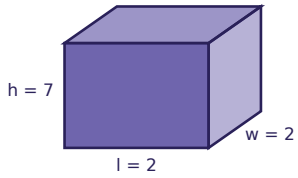

Surface Area & Volume of Prisms (Mixed Review) · 18

Find the surface area of a rectangular prism with length 4, width 4, and height 5.

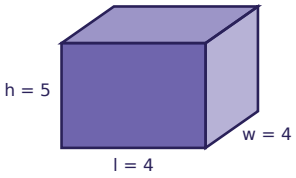

Surface Area & Volume of Prisms (Mixed Review) · 19

Find the volume of a triangular prism with a triangular base of base 4 and height 2, and a prism length of 7.

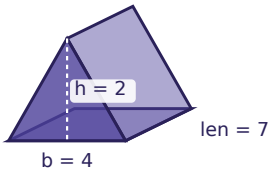

Surface Area & Volume of Prisms (Mixed Review) · 20

Find the volume of a rectangular prism with length 7, width 2, and height 6.

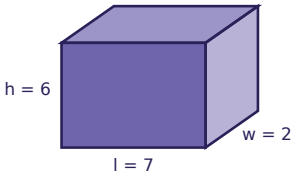

Surface Area & Volume of Prisms (Mixed Review) · 21

Find the surface area of a rectangular prism with length 5, width 3, and height 5.

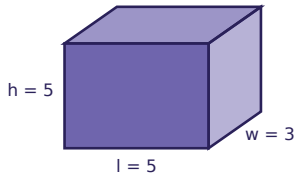

Surface Area & Volume of Prisms (Mixed Review) · 22

Find the volume of a triangular prism with a triangular base of base 3 and height 4, and a prism length of 5.

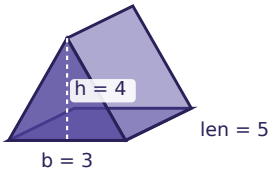

Surface Area & Volume of Prisms (Mixed Review) · 23

Find the volume of a rectangular prism with length 5, width 4, and height 3.

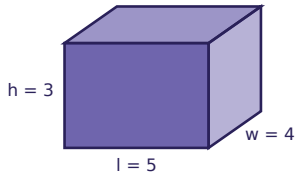

Surface Area & Volume of Prisms (Mixed Review) · 24

Find the surface area of a rectangular prism with length 3, width 4, and height 3.

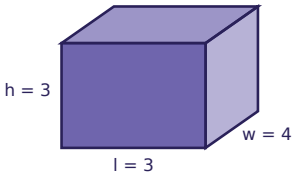

Surface Area & Volume of Prisms (Mixed Review) · 18

ANSWER

112

Surface Area & Volume of Prisms (Mixed Review) · 17

ANSWER

28

Surface Area & Volume of Prisms (Mixed Review) · 20

ANSWER

84

Surface Area & Volume of Prisms (Mixed Review) · 19

ANSWER

28

Surface Area & Volume of Prisms (Mixed Review) · 22

ANSWER

30

Surface Area & Volume of Prisms (Mixed Review) · 21

ANSWER

110

Surface Area & Volume of Prisms (Mixed Review) · 24

ANSWER

66

Surface Area & Volume of Prisms (Mixed Review) · 23

ANSWER

60