Task card 1 Surface Area of Square Pyramids

Find the surface area of the square pyramid in square meters.

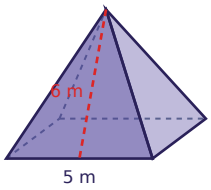

Task card 2 Surface Area of Square Pyramids

Find the surface area of the square pyramid in square feet.

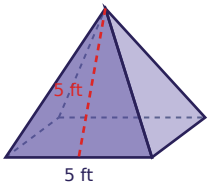

Task card 3 Surface Area of Square Pyramids

Find the surface area of the square pyramid in square centimeters.

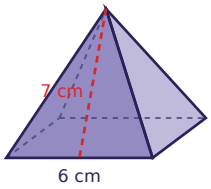

Task card 4 Surface Area of Square Pyramids

Find the surface area of the square pyramid in square feet.

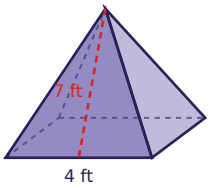

Task card 5 Surface Area of Square Pyramids

Find the surface area of the square pyramid in square inches.

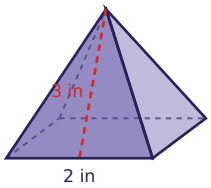

Task card 6 Surface Area of Square Pyramids

Find the surface area of the square pyramid in square centimeters.

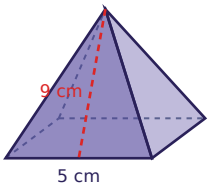

Task card 7 Surface Area of Square Pyramids

Find the surface area of the square pyramid in square meters.

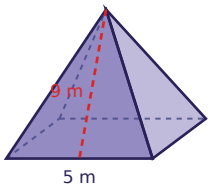

Task card 8 Surface Area of Square Pyramids

Find the surface area of the square pyramid in square feet.

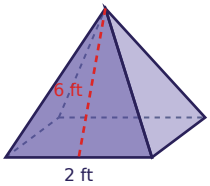

Task card 9 Surface Area of Square Pyramids

Find the surface area of the square pyramid in square inches.

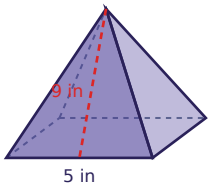

Task card 10 Surface Area of Square Pyramids

Find the surface area of the square pyramid in square feet.

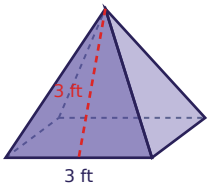

Task card 11 Surface Area of Square Pyramids

Find the surface area of the square pyramid in square inches.

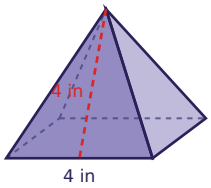

Task card 12 Surface Area of Square Pyramids

Find the surface area of the square pyramid in square meters.

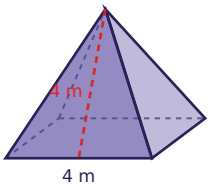

Task card 13 Surface Area of Square Pyramids

Find the surface area of the square pyramid in square inches.

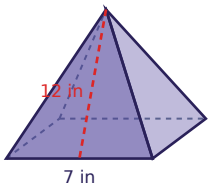

Task card 14 Surface Area of Square Pyramids

Find the surface area of the square pyramid in square meters.

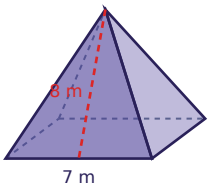

Task card 15 Surface Area of Square Pyramids

Find the surface area of the square pyramid in square inches.

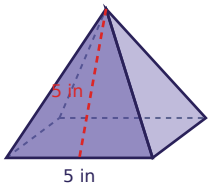

Task card 16 Surface Area of Square Pyramids

Find the surface area of the square pyramid in square feet.

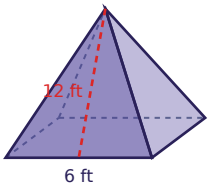

Task card 17 Surface Area of Square Pyramids

Find the surface area of the square pyramid in square feet.

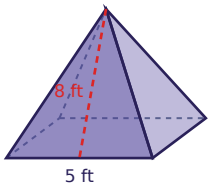

Task card 18 Surface Area of Square Pyramids

Find the surface area of the square pyramid in square meters.

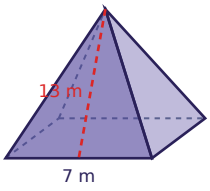

Task card 19 Surface Area of Square Pyramids

Find the surface area of the square pyramid in square inches.

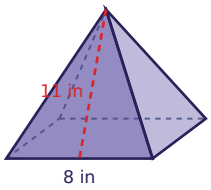

Task card 20 Surface Area of Square Pyramids

Find the surface area of the square pyramid in square centimeters.

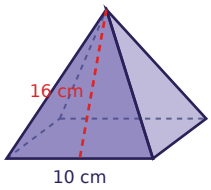

Task card 21 Surface Area of Square Pyramids

Find the surface area of the square pyramid in square centimeters.

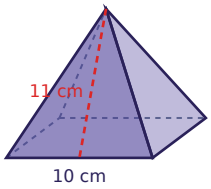

Task card 22 Surface Area of Square Pyramids

Find the surface area of the square pyramid in square centimeters.

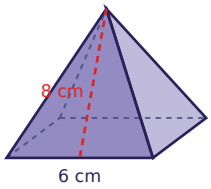

Task card 23 Surface Area of Square Pyramids

Find the surface area of the square pyramid in square inches.

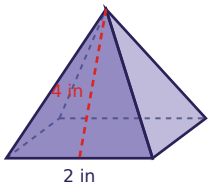

Task card 24 Surface Area of Square Pyramids

Find the surface area of the square pyramid in square feet.

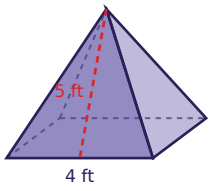

Surface Area of Square Pyramids Task Cards

Recording sheet · Grade 7 · Find each surface area: the square base + 4 triangles.

Name: _____ Date: _____

Scan to check your answers

1	2	3	4
5	6	7	8
9	10	11	12
13	14	15	16
17	18	19	20
21	22	23	24

Surface Area of Square Pyramids Task Cards: Answer Key

Grade 7 · Easy

The answers online

1. 85	**2.** 75	**3.** 120
4. 72	**5.** 16	**6.** 115
7. 115	**8.** 28	**9.** 115
10. 27	**11.** 48	**12.** 48
13. 217	**14.** 161	**15.** 75
16. 180	**17.** 105	**18.** 231
19. 240	**20.** 420	**21.** 320
22. 132	**23.** 20	**24.** 56