Surface Area of Square Pyramids · 1

Find the surface area of the square pyramid in square centimeters.

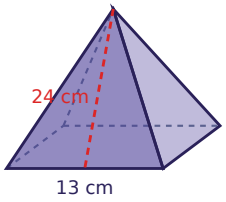

Surface Area of Square Pyramids · 2

Find the surface area of the square pyramid in square meters.

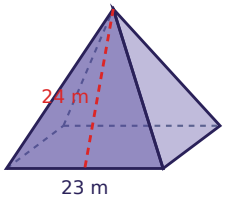

Surface Area of Square Pyramids · 3

Find the surface area of the square pyramid in square meters.

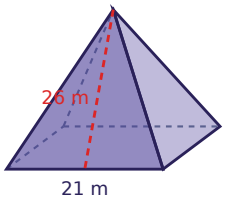

Surface Area of Square Pyramids · 4

Find the surface area of the square pyramid in square feet.

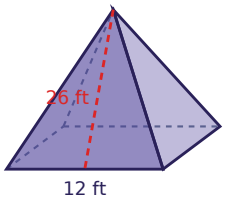

Surface Area of Square Pyramids · 5

Find the surface area of the square pyramid in square inches.

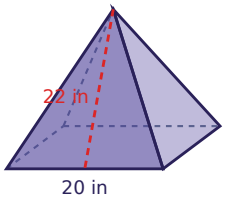

Surface Area of Square Pyramids · 6

Find the surface area of the square pyramid in square feet.

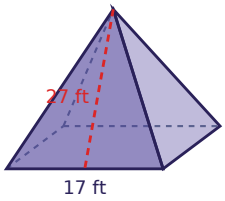

Surface Area of Square Pyramids · 7

Find the surface area of the square pyramid in square inches.

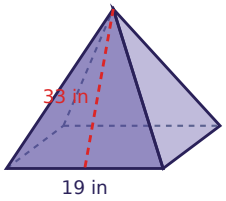

Surface Area of Square Pyramids · 8

Find the surface area of the square pyramid in square meters.

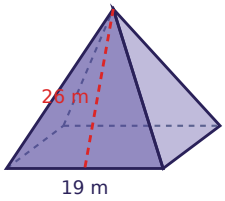

Surface Area of Square Pyramids · 2

ANSWER

1633

Surface Area of Square Pyramids · 1

ANSWER

793

Surface Area of Square Pyramids · 4

ANSWER

768

Surface Area of Square Pyramids · 3

ANSWER

1533

Surface Area of Square Pyramids · 6

ANSWER

1207

Surface Area of Square Pyramids · 5

ANSWER

1280

Surface Area of Square Pyramids · 8

ANSWER

1349

Surface Area of Square Pyramids · 7

ANSWER

1615

Surface Area of Square Pyramids · 9

Find the surface area of the square pyramid in square centimeters.

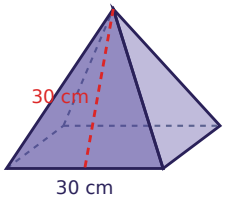

Surface Area of Square Pyramids · 10

Find the surface area of the square pyramid in square meters.

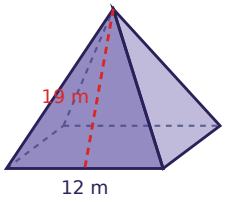

Surface Area of Square Pyramids · 11

Find the surface area of the square pyramid in square feet.

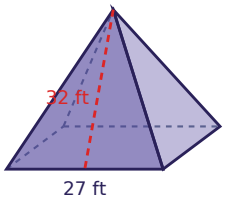

Surface Area of Square Pyramids · 12

Find the surface area of the square pyramid in square inches.

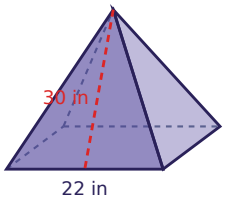

Surface Area of Square Pyramids · 13

A glass paperweight is a square pyramid. Its base is 14 in on each side and its slant height is 27 in. What is its surface area in square inches?

Surface Area of Square Pyramids · 14

A model pyramid has a square base 28 in on each side and a slant height of 30 in. How many square inches of paper cover it, base included?

Surface Area of Square Pyramids · 15

A model pyramid has a square base 24 in on each side and a slant height of 39 in. How many square inches of paper cover it, base included?

Surface Area of Square Pyramids · 16

A glass paperweight is a square pyramid. Its base is 21 in on each side and its slant height is 32 in. What is its surface area in square inches?

Surface Area of Square Pyramids · 10

ANSWER

600

Surface Area of Square Pyramids · 9

ANSWER

2700

Surface Area of Square Pyramids · 12

ANSWER

1804

Surface Area of Square Pyramids · 11

ANSWER

2457

Surface Area of Square Pyramids · 14

ANSWER

2464

Surface Area of Square Pyramids · 13

ANSWER

952

Surface Area of Square Pyramids · 16

ANSWER

1785

Surface Area of Square Pyramids · 15

ANSWER

2448

Surface Area of Square Pyramids · 17

Find the surface area of the square pyramid in square centimeters.

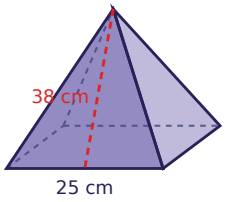

Surface Area of Square Pyramids · 18

Find the surface area of the square pyramid in square centimeters.

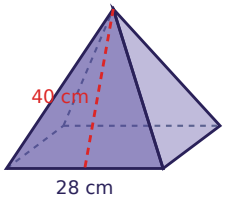

Surface Area of Square Pyramids · 19

Find the surface area of the square pyramid in square centimeters.

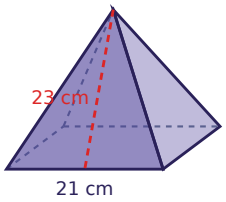

Surface Area of Square Pyramids · 20

Find the surface area of the square pyramid in square centimeters.

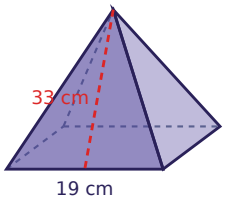

Surface Area of Square Pyramids · 21

Find the surface area of the square pyramid in square meters.

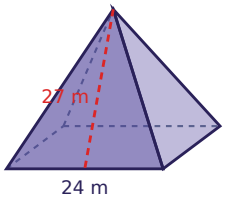

Surface Area of Square Pyramids · 22

Find the surface area of the square pyramid in square feet.

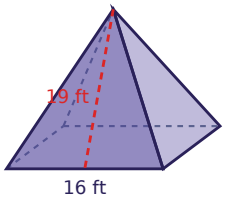

Surface Area of Square Pyramids · 23

Find the surface area of the square pyramid in square centimeters.

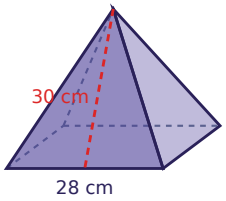

Surface Area of Square Pyramids · 24

Find the surface area of the square pyramid in square inches.

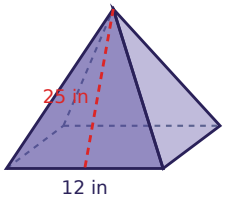

Surface Area of Square Pyramids · 18

ANSWER

3024

Surface Area of Square Pyramids · 17

ANSWER

2525

Surface Area of Square Pyramids · 20

ANSWER

1615

Surface Area of Square Pyramids · 19

ANSWER

1407

Surface Area of Square Pyramids · 22

ANSWER

864

Surface Area of Square Pyramids · 21

ANSWER

1872

Surface Area of Square Pyramids · 24

ANSWER

744

Surface Area of Square Pyramids · 23

ANSWER

2464