Surface Area of Square Pyramids · 1

Find the surface area of the square pyramid in square meters.

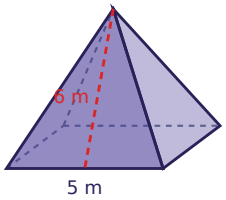

Surface Area of Square Pyramids · 2

Find the surface area of the square pyramid in square feet.

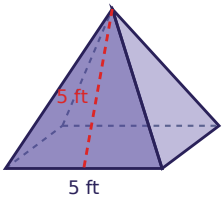

Surface Area of Square Pyramids · 3

Find the surface area of the square pyramid in square centimeters.

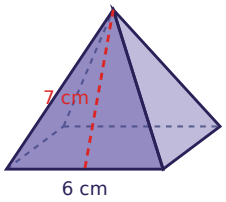

Surface Area of Square Pyramids · 4

Find the surface area of the square pyramid in square feet.

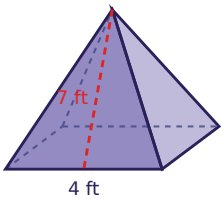

Surface Area of Square Pyramids · 5

Find the surface area of the square pyramid in square inches.

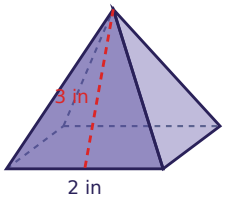

Surface Area of Square Pyramids · 6

Find the surface area of the square pyramid in square centimeters.

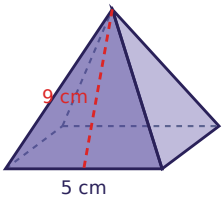

Surface Area of Square Pyramids · 7

Find the surface area of the square pyramid in square meters.

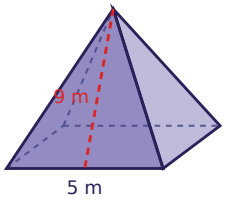

Surface Area of Square Pyramids · 8

Find the surface area of the square pyramid in square feet.

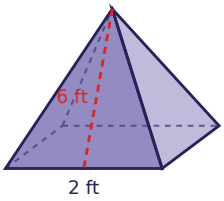

Surface Area of Square Pyramids · 2

ANSWER

75

Surface Area of Square Pyramids · 1

ANSWER

85

Surface Area of Square Pyramids · 4

ANSWER

72

Surface Area of Square Pyramids · 3

ANSWER

120

Surface Area of Square Pyramids · 6

ANSWER

115

Surface Area of Square Pyramids · 5

ANSWER

16

Surface Area of Square Pyramids · 8

ANSWER

28

Surface Area of Square Pyramids · 7

ANSWER

115

Surface Area of Square Pyramids · 9

Find the surface area of the square pyramid in square inches.

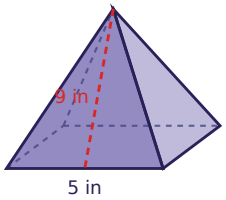

Surface Area of Square Pyramids · 10

Find the surface area of the square pyramid in square feet.

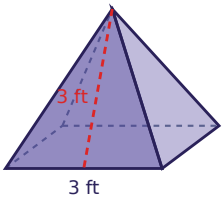

Surface Area of Square Pyramids · 11

Find the surface area of the square pyramid in square inches.

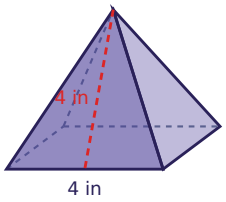

Surface Area of Square Pyramids · 12

Find the surface area of the square pyramid in square meters.

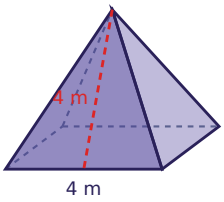

Surface Area of Square Pyramids · 13

Find the surface area of the square pyramid in square inches.

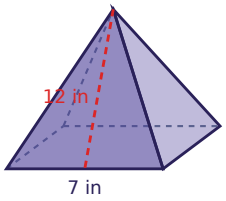

Surface Area of Square Pyramids · 14

Find the surface area of the square pyramid in square meters.

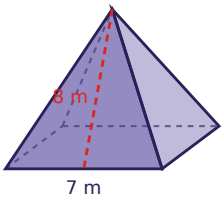

Surface Area of Square Pyramids · 15

Find the surface area of the square pyramid in square inches.

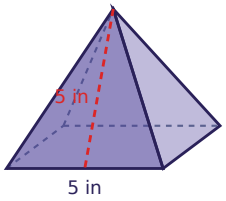

Surface Area of Square Pyramids · 16

Find the surface area of the square pyramid in square feet.

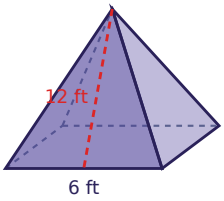

Surface Area of Square Pyramids · 10

ANSWER

27

Surface Area of Square Pyramids · 9

ANSWER

115

Surface Area of Square Pyramids · 12

ANSWER

48

Surface Area of Square Pyramids · 11

ANSWER

48

Surface Area of Square Pyramids · 14

ANSWER

161

Surface Area of Square Pyramids · 13

ANSWER

217

Surface Area of Square Pyramids · 16

ANSWER

180

Surface Area of Square Pyramids · 15

ANSWER

75

Surface Area of Square Pyramids · 17

Find the surface area of the square pyramid in square feet.

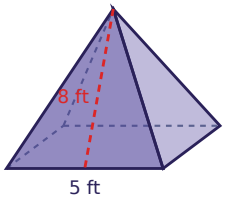

Surface Area of Square Pyramids · 18

Find the surface area of the square pyramid in square meters.

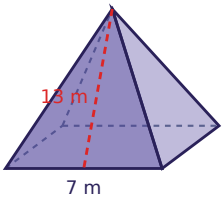

Surface Area of Square Pyramids · 19

Find the surface area of the square pyramid in square inches.

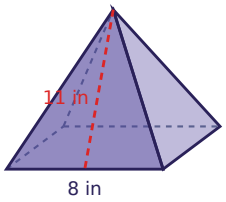

Surface Area of Square Pyramids · 20

Find the surface area of the square pyramid in square centimeters.

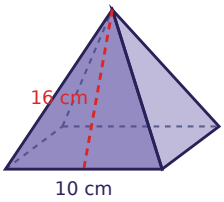

Surface Area of Square Pyramids · 21

Find the surface area of the square pyramid in square centimeters.

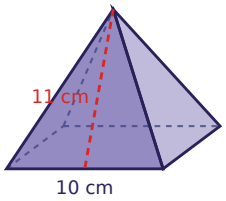

Surface Area of Square Pyramids · 22

Find the surface area of the square pyramid in square centimeters.

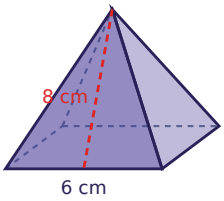

Surface Area of Square Pyramids · 23

Find the surface area of the square pyramid in square inches.

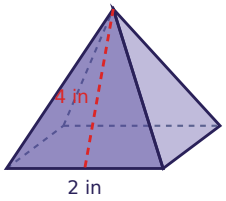

Surface Area of Square Pyramids · 24

Find the surface area of the square pyramid in square feet.

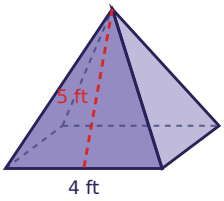

Surface Area of Square Pyramids · 18

ANSWER

231

Surface Area of Square Pyramids · 17

ANSWER

105

Surface Area of Square Pyramids · 20

ANSWER

420

Surface Area of Square Pyramids · 19

ANSWER

240

Surface Area of Square Pyramids · 22

ANSWER

132

Surface Area of Square Pyramids · 21

ANSWER

320

Surface Area of Square Pyramids · 24

ANSWER

56

Surface Area of Square Pyramids · 23

ANSWER

20