Task card 1 Summer Math

A pair of sunglasses costs $22.00. It is on sale for 30% off. What is the sale price?

Task card 2 Summer Math

Ava uses 2 cups of lemon juice to make 6 cupcakes. How many cups of lemon juice are needed for 4 cupcakes?

Task card 3 Summer Math

A round table at the summer barbecue is 4 feet across (its diameter). Leo puts ribbon once around its edge. How many feet of ribbon is that?

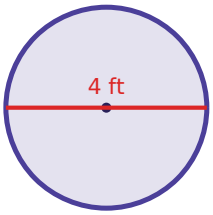

Task card 4 Summer Math

A round table at the summer barbecue is 4 feet across (its diameter). Noah puts ribbon once around its edge. How many feet of ribbon is that?

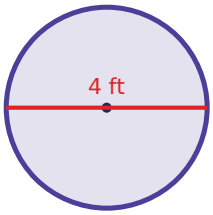

Task card 5 Summer Math

A pair of sunglasses costs $35.00. It is on sale for 10% off. What is the sale price?

Task card 6 Summer Math

A grab bag at the summer barbecue holds 2 paper lanterns, 1 beach ball sticker and 1 flag. Leo takes one without looking. What is the probability that it is a flag?

Task card 7 Summer Math

A grab bag at the summer barbecue holds 2 paper lanterns, 4 beach ball stickers and 3 flags. Ava takes one without looking. What is the probability that it is a beach ball sticker?

Task card 8 Summer Math

Leo uses 1 cup of lemon juice to make 12 lemon bars. How many cups of lemon juice are needed for 20 lemon bars?

Task card 9 Summer Math

A cup of lemonade costs $7.00. It is on sale for 40% off. What is the sale price?

Task card 10 Summer Math

A grab bag at the summer barbecue holds 2 paper lanterns, 3 beach ball stickers and 5 flags. Mia takes one without looking. What is the probability that it is a beach ball sticker?

Task card 11 Summer Math

Noah uses 3 cups of lemon juice to make 4 cupcakes. How many cups of lemon juice are needed for 22 cupcakes?

Task card 12 Summer Math

A grab bag at the summer barbecue holds 3 paper lanterns, 3 beach ball stickers and 5 flags. Ben takes one without looking. What is the probability that it is a flag?

Task card 13 Summer Math

A round tablecloth for the summer barbecue has a radius of 4 feet. What is its area in square feet?

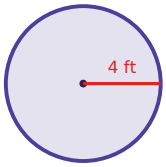

Task card 14 Summer Math

A beach ball costs $17.00. It is on sale for 25% off. What is the sale price?

Task card 15 Summer Math

A round table at the summer barbecue is 4 feet across (its diameter). Zoe puts ribbon once around its edge. How many feet of ribbon is that?

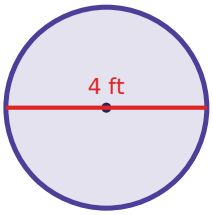

Task card 16 Summer Math

Mia uses 1 cup of lemon juice to make 8 cupcakes. How many cups of lemon juice are needed for 32 cupcakes?

Task card 17 Summer Math

A pair of sunglasses costs $18.00. It is on sale for 10% off. What is the sale price?

Task card 18 Summer Math

A grab bag at the summer barbecue holds 1 paper lantern, 3 beach ball stickers and 6 flags. Ava takes one without looking. What is the probability that it is a beach ball sticker?

Task card 19 Summer Math

A beach ball costs $7.00. It is on sale for 25% off. What is the sale price?

Task card 20 Summer Math

Ben uses 2 cups of lemon juice to make 12 cupcakes. How many cups of lemon juice are needed for 28 cupcakes?

Task card 21 Summer Math

Ava uses 3 cups of lemon juice to make 12 blueberry muffins. How many cups of lemon juice are needed for 7 blueberry muffins?

Task card 22 Summer Math

A grab bag at the summer barbecue holds 6 paper lanterns, 2 beach ball stickers and 1 flag. Ben takes one without looking. What is the probability that it is a beach ball sticker?

Task card 23 Summer Math

A beach ball costs $18.00. It is on sale for 30% off. What is the sale price?

Task card 24 Summer Math

A pair of sunglasses costs $30.00. It is on sale for 10% off. What is the sale price?

Summer Math Task Cards

Recording sheet · Grade 7 · Read each story and solve. Write money like $12.60 and probabilities as fractions in simplest form. Use 3.14 for π and round to the nearest tenth.

Scan to check your answers

Name: _____ Date: _____

1	2	3	4
5	6	7	8
9	10	11	12
13	14	15	16
17	18	19	20
21	22	23	24

Summer Math Task Cards: Answer Key

Grade 7 · Easy

The answers online

1. $15.40	**2.** $1\frac{1}{3}$	**3.** 12.6
4. 12.6	**5.** $31.50	**6.** $\frac{1}{4}$
7. $\frac{4}{9}$	**8.** $1\frac{2}{3}$	**9.** $4.20
10. $\frac{3}{10}$	**11.** $16\frac{1}{2}$	**12.** $\frac{5}{11}$
13. 50.2	**14.** $12.75	**15.** 12.6
16. 4	**17.** $16.20	**18.** $\frac{3}{10}$
19. $5.25	**20.** $4\frac{2}{3}$	**21.** $1\frac{3}{4}$
22. $\frac{2}{9}$	**23.** $12.60	**24.** $27.00