Area of Shaded Regions with Circles · 1

A circle is cut out of a rectangle. Find the area of the shaded part in square feet.

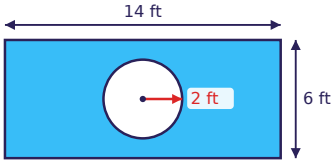

Area of Shaded Regions with Circles · 2

A circle is cut out of a rectangle. Find the area of the shaded part in square meters.

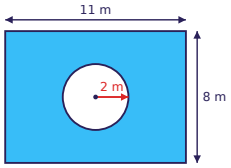

Area of Shaded Regions with Circles · 3

A circle is cut out of a rectangle. Find the area of the shaded part in square meters.

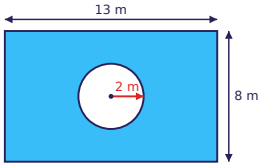

Area of Shaded Regions with Circles · 4

A circle is cut out of a rectangle. Find the area of the shaded part in square centimeters.

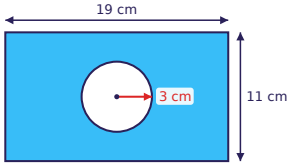

Area of Shaded Regions with Circles · 5

A circle is cut out of a rectangle. Find the area of the shaded part in square yards.

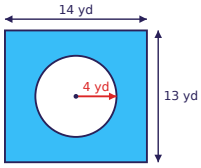

Area of Shaded Regions with Circles · 6

A circle is cut out of a rectangle. Find the area of the shaded part in square yards.

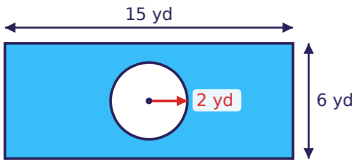

Area of Shaded Regions with Circles · 7

A circle is cut out of a rectangle. Find the area of the shaded part in square meters.

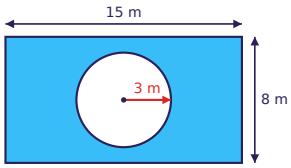

Area of Shaded Regions with Circles · 8

A circle is cut out of a rectangle. Find the area of the shaded part in square yards.

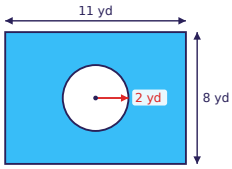

Area of Shaded Regions with Circles · 2

ANSWER

75.4

Area of Shaded Regions with Circles · 1

ANSWER

71.4

Area of Shaded Regions with Circles · 4

ANSWER

180.7

Area of Shaded Regions with Circles · 3

ANSWER

91.4

Area of Shaded Regions with Circles · 6

ANSWER

77.4

Area of Shaded Regions with Circles · 5

ANSWER

131.8

Area of Shaded Regions with Circles · 8

ANSWER

75.4

Area of Shaded Regions with Circles · 7

ANSWER

91.7

Area of Shaded Regions with Circles · 9

A circle is cut out of a rectangle. Find the area of the shaded part in square meters.

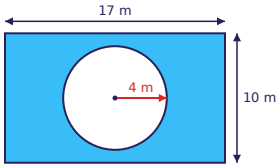

Area of Shaded Regions with Circles · 10

A circle is cut out of a rectangle. Find the area of the shaded part in square yards.

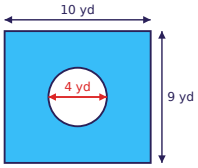

Area of Shaded Regions with Circles · 11

A circle is cut out of a rectangle. Find the area of the shaded part in square inches.

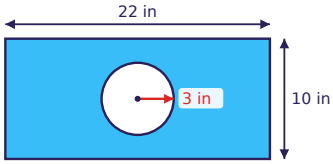

Area of Shaded Regions with Circles · 12

A circle is cut out of a rectangle. Find the area of the shaded part in square feet.

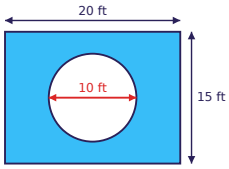

Area of Shaded Regions with Circles · 13

A circle is cut out of a rectangle. Find the area of the shaded part in square feet.

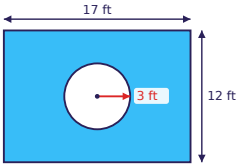

Area of Shaded Regions with Circles · 14

A circle is cut out of a rectangle. Find the area of the shaded part in square meters.

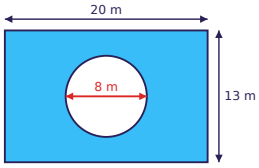

Area of Shaded Regions with Circles · 15

A circle is cut out of a rectangle. Find the area of the shaded part in square centimeters.

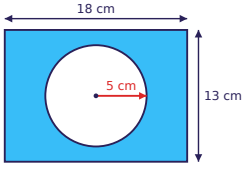

Area of Shaded Regions with Circles · 16

A circle is cut out of a rectangle. Find the area of the shaded part in square yards.

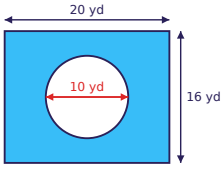

Area of Shaded Regions with Circles · 10

ANSWER

77.4

Area of Shaded Regions with Circles · 9

ANSWER

119.8

Area of Shaded Regions with Circles · 12

ANSWER

221.5

Area of Shaded Regions with Circles · 11

ANSWER

191.7

Area of Shaded Regions with Circles · 14

ANSWER

209.8

Area of Shaded Regions with Circles · 13

ANSWER

175.7

Area of Shaded Regions with Circles · 16

ANSWER

241.5

Area of Shaded Regions with Circles · 15

ANSWER

155.5

Area of Shaded Regions with Circles · 17

A circle is cut out of a rectangle. Find the area of the shaded part in square centimeters.

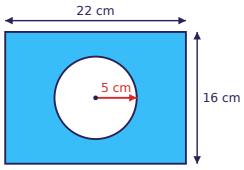

Area of Shaded Regions with Circles · 18

A circle is cut out of a rectangle. Find the area of the shaded part in square yards.

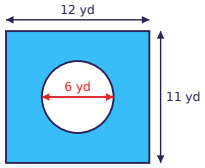

Area of Shaded Regions with Circles · 19

The circle touches all four sides of the square. Find the area of the shaded corners in square yards.

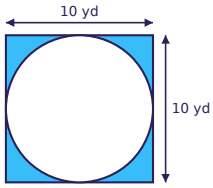

Area of Shaded Regions with Circles · 20

A circle is cut out of a rectangle. Find the area of the shaded part in square centimeters.

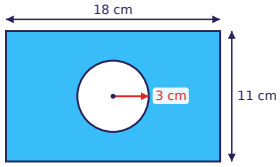

Area of Shaded Regions with Circles · 21

A circle is cut out of a rectangle. Find the area of the shaded part in square centimeters.

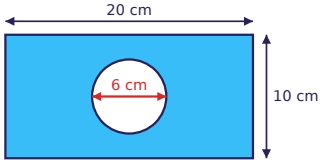

Area of Shaded Regions with Circles · 22

The circle touches all four sides of the square. Find the area of the shaded corners in square centimeters.

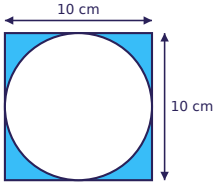

Area of Shaded Regions with Circles · 23

A circle is cut out of a rectangle. Find the area of the shaded part in square feet.

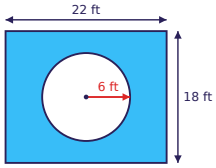

Area of Shaded Regions with Circles · 24

A circle is cut out of a rectangle. Find the area of the shaded part in square inches.

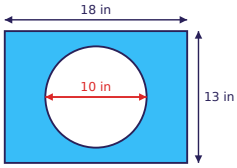

Area of Shaded Regions with Circles · 18

ANSWER

103.7

Area of Shaded Regions with Circles · 17

ANSWER

273.5

Area of Shaded Regions with Circles · 20

ANSWER

169.7

Area of Shaded Regions with Circles · 19

ANSWER

21.5

Area of Shaded Regions with Circles · 22

ANSWER

21.5

Area of Shaded Regions with Circles · 21

ANSWER

171.7

Area of Shaded Regions with Circles · 24

ANSWER

155.5

Area of Shaded Regions with Circles · 23

ANSWER

283