Task card 1 Probability Basics

A bag has 1 red and 4 blue marbles. What is the probability of picking a blue marble? (as a fraction)



Task card 2 Probability Basics

A bag has 1 red and 2 blue marbles. What is the probability of picking a blue marble? (as a fraction)



Task card 3 Probability Basics

A bag has 2 red and 1 blue marbles. What is the probability of picking a red marble? (as a fraction)



Task card 4 Probability Basics

A bag has 2 red and 3 blue marbles. What is the probability of picking a blue marble? (as a fraction)



Task card 5 Probability Basics

A bag has 1 red and 1 blue marbles. What is the probability of picking a blue marble? (as a fraction)



Task card 6 Probability Basics

A bag has 1 red and 2 blue marbles. What is the probability of picking a red marble? (as a fraction)



Task card 7 Probability Basics

A bag has 4 red and 1 blue marbles. What is the probability of picking a blue marble? (as a fraction)



Task card 8 Probability Basics

A bag has 1 red and 3 blue marbles. What is the probability of picking a blue marble? (as a fraction)



Task card 9 Probability Basics

A bag has 5 red and 2 blue marbles. What is the probability of picking a red marble? (as a fraction)



Task card 10 Probability Basics

A bag has 5 red and 1 blue marbles. What is the probability of picking a blue marble? (as a fraction)



Task card 11 Probability Basics

A bag has 2 red and 1 blue marbles. What is the probability of picking a blue marble? (as a fraction)



Task card 12 Probability Basics

A bag has 4 red and 3 blue marbles. What is the probability of picking a red marble? (as a fraction)



Task card 13 Probability Basics

A bag has 3 red and 3 blue marbles. What is the probability of picking a red marble? (as a fraction)



Task card 14 Probability Basics

A bag has 5 red and 5 blue marbles. What is the probability of picking a red marble? (as a fraction)



Task card 15 Probability Basics

A bag has 4 red and 3 blue marbles. What is the probability of picking a blue marble? (as a fraction)



Task card 16 Probability Basics

A bag has 5 red and 6 blue marbles. What is the probability of picking a blue marble? (as a fraction)



Task card 17 Probability Basics

A bag has 3 red and 1 blue marbles. What is the probability of picking a red marble? (as a fraction)



Task card 18 Probability Basics

A bag has 2 red and 4 blue marbles. What is the probability of picking a red marble? (as a fraction)



Task card 19 Probability Basics

A bag has 4 red and 4 blue marbles. What is the probability of picking a blue marble? (as a fraction)



Task card 20 Probability Basics

A bag has 1 red and 6 blue marbles. What is the probability of picking a red marble? (as a fraction)



Task card 21 Probability Basics

A bag has 3 red and 4 blue marbles. What is the probability of picking a blue marble? (as a fraction)



Task card 22 Probability Basics

A bag has 4 red and 2 blue marbles. What is the probability of picking a blue marble? (as a fraction)



Task card 23 Probability Basics

A bag has 4 red and 2 blue marbles. What is the probability of picking a red marble? (as a fraction)



Task card 24 Probability Basics

A bag has 1 red and 4 blue marbles. What is the probability of picking a red marble? (as a fraction)



Probability Basics Task Cards

Recording sheet · Grade 7 · Write each probability as a fraction in simplest form.

Name: _____ Date: _____

Scan to check your answers

1	2	3	4
5	6	7	8
9	10	11	12
13	14	15	16
17	18	19	20
21	22	23	24

Probability Basics Task Cards: Answer Key

Grade 7 · Easy

The answers online

1. $\frac{4}{5}$	**2.** $\frac{2}{3}$	**3.** $\frac{2}{3}$
4. $\frac{3}{5}$	**5.** $\frac{1}{2}$	**6.** $\frac{1}{3}$
7. $\frac{1}{5}$	**8.** $\frac{3}{4}$	**9.** $\frac{5}{7}$
10. $\frac{1}{6}$	**11.** $\frac{1}{3}$	**12.** $\frac{4}{7}$
13. $\frac{1}{2}$	**14.** $\frac{1}{2}$	**15.** $\frac{3}{7}$
16. $\frac{6}{11}$	**17.** $\frac{3}{4}$	**18.** $\frac{1}{3}$
19. $\frac{1}{2}$	**20.** $\frac{1}{7}$	**21.** $\frac{4}{7}$
22. $\frac{1}{3}$	**23.** $\frac{2}{3}$	**24.** $\frac{1}{5}$