Task card 1 Easter Math

A round tablecloth for the Easter brunch has a radius of 5 feet. What is its area in square feet?

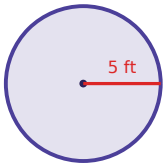

Task card 2 Easter Math

A round table at the Easter brunch is 9 feet across (its diameter). Ella puts ribbon once around its edge. How many feet of ribbon is that?

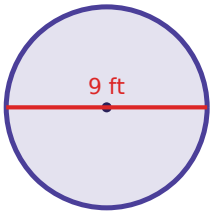

Task card 3 Easter Math

A grab bag at the Easter brunch holds 4 painted eggs, 2 paper flowers and 3 bunny stickers. Noah takes one without looking. What is the probability that it is a bunny sticker?

Task card 4 Easter Math

Sam uses 4 cups of shredded carrot to make 12 hot cross buns. How many cups of shredded carrot are needed for 6 hot cross buns?

Task card 5 Easter Math

A chocolate bunny costs $16.00. It is 20% off, and then 5% sales tax is added to the sale price. What is the total price?

Task card 6 Easter Math

A grab bag at the Easter brunch holds 7 painted eggs, 2 paper flowers and 4 bunny stickers. Ben takes one without looking. What is the probability that it is a paper flower?

Task card 7 Easter Math

A pot of tulips costs $27.00. It is 20% off, and then 8% sales tax is added to the sale price. What is the total price?

Task card 8 Easter Math

Leo uses 2 cups of shredded carrot to make 4 carrot muffins. How many cups of shredded carrot are needed for 3 carrot muffins?

Task card 9 Easter Math

Mia uses 2 cups of shredded carrot to make 8 bunny cookies. How many cups of shredded carrot are needed for 16 bunny cookies?

Task card 10 Easter Math

A grab bag at the Easter brunch holds 6 painted eggs, 7 paper flowers and 8 bunny stickers. Leo takes one without looking. What is the probability that it is a paper flower?

Task card 11 Easter Math

A chocolate bunny costs $13.00. It is 10% off, and then 8% sales tax is added to the sale price. What is the total price?

Task card 12 Easter Math

A round table at the Easter brunch is 7 feet across (its diameter). Lily puts ribbon once around its edge. How many feet of ribbon is that?

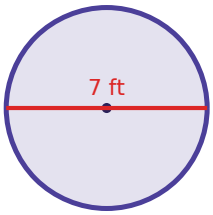

Task card 13 Easter Math

A chocolate bunny costs $10.00. It is 50% off, and then 5% sales tax is added to the sale price. What is the total price?

Task card 14 Easter Math

A round tablecloth for the Easter brunch has a radius of 6 feet. What is its area in square feet?

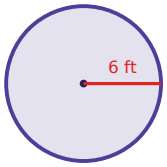

Task card 15 Easter Math

A grab bag at the Easter brunch holds 9 painted eggs, 1 paper flower and 4 bunny stickers. Ben takes one without looking. What is the probability that it is a bunny sticker?

Task card 16 Easter Math

Ella uses 2 cups of shredded carrot to make 12 hot cross buns. How many cups of shredded carrot are needed for 21 hot cross buns?

Task card 17 Easter Math

Ava uses 2 cups of shredded carrot to make 4 carrot muffins. How many cups of shredded carrot are needed for 33 carrot muffins?

Task card 18 Easter Math

A chocolate bunny costs $10.00. It is 50% off, and then 6% sales tax is added to the sale price. What is the total price?

Task card 19 Easter Math

A bag of jelly beans costs $4.00. It is 30% off, and then 6% sales tax is added to the sale price. What is the total price?

Task card 20 Easter Math

A grab bag at the Easter brunch holds 7 painted eggs, 5 paper flowers and 9 bunny stickers. Ella takes one without looking. What is the probability that it is a paper flower?

Task card 21 Easter Math

A round table at the Easter brunch is 9 feet across (its diameter). Sam puts ribbon once around its edge. How many feet of ribbon is that?

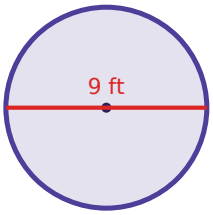

Task card 22 Easter Math

A grab bag at the Easter brunch holds 3 painted eggs, 1 paper flower and 5 bunny stickers. Ella takes one without looking. What is the probability that it is a paper flower?

Task card 23 Easter Math

Noah uses 2 cups of shredded carrot to make 12 hot cross buns. How many cups of shredded carrot are needed for 6 hot cross buns?

Task card 24 Easter Math

A grab bag at the Easter brunch holds 5 painted eggs, 9 paper flowers and 9 bunny stickers. Leo takes one without looking. What is the probability that it is a paper flower?

Easter Math Task Cards

Recording sheet · Grade 7 · Read each story and solve. Write money like $12.60 and probabilities as fractions in simplest form. Use 3.14 for π and round to the nearest tenth.

Name: _____ Date: _____

Scan to check your answers

1	2	3	4
5	6	7	8
9	10	11	12
13	14	15	16
17	18	19	20
21	22	23	24

Easter Math Task Cards: Answer Key

Grade 7 · Hard

The answers online

1. 78.5	**2.** 28.3	**3.** $\frac{1}{3}$
4. 2	**5.** $13.44	**6.** $\frac{2}{13}$
7. $23.33	**8.** $1\frac{1}{2}$	**9.** 4
10. $\frac{1}{3}$	**11.** $12.64	**12.** 22
13. $5.25	**14.** 113	**15.** $\frac{2}{7}$
16. $3\frac{1}{2}$	**17.** $16\frac{1}{2}$	**18.** $5.30
19. $2.97	**20.** $\frac{5}{21}$	**21.** 28.3
22. $\frac{1}{9}$	**23.** 1	**24.** $\frac{9}{23}$