Task card 1 Easter Math

A pot of tulips costs $12.00. It is on sale for 40% off. What is the sale price?

Task card 2 Easter Math

A round tablecloth for the Easter brunch has a radius of 4 feet. What is its area in square feet?

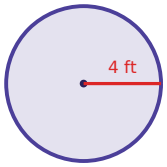

Task card 3 Easter Math

A grab bag at the Easter brunch holds 6 painted eggs, 3 paper flowers and 7 bunny stickers. Omar takes one without looking. What is the probability that it is a paper flower?

Task card 4 Easter Math

A bag of jelly beans costs $4.00. It is on sale for 50% off. What is the sale price?

Task card 5 Easter Math

Ben uses 1 cup of shredded carrot to make 8 bunny cookies. How many cups of shredded carrot are needed for 16 bunny cookies?

Task card 6 Easter Math

A grab bag at the Easter brunch holds 6 painted eggs, 4 paper flowers and 7 bunny stickers. Ella takes one without looking. What is the probability that it is a paper flower?

Task card 7 Easter Math

Sam uses 3 cups of shredded carrot to make 8 carrot muffins. How many cups of shredded carrot are needed for 30 carrot muffins?

Task card 8 Easter Math

A round table at the Easter brunch is 7 feet across (its diameter). Lily puts ribbon once around its edge. How many feet of ribbon is that?

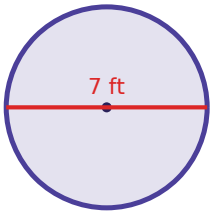

Task card 9 Easter Math

Mia uses 3 cups of shredded carrot to make 12 bunny cookies. How many cups of shredded carrot are needed for 22 bunny cookies?

Task card 10 Easter Math

A bag of jelly beans costs $9.00. It is 30% off, and then 8% sales tax is added to the sale price. What is the total price?

Task card 11 Easter Math

A grab bag at the Easter brunch holds 2 painted eggs, 6 paper flowers and 6 bunny stickers. Sam takes one without looking. What is the probability that it is a paper flower?

Task card 12 Easter Math

A chocolate bunny costs $7.00. It is 10% off, and then 5% sales tax is added to the sale price. What is the total price?

Task card 13 Easter Math

A grab bag at the Easter brunch holds 6 painted eggs, 5 paper flowers and 8 bunny stickers. Lily takes one without looking. What is the probability that it is a bunny sticker?

Task card 14 Easter Math

A round table at the Easter brunch is 5 feet across (its diameter). Ava puts ribbon once around its edge. How many feet of ribbon is that?

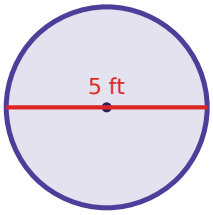

Task card 15 Easter Math

Sam uses 3 cups of shredded carrot to make 12 carrot muffins. How many cups of shredded carrot are needed for 27 carrot muffins?

Task card 16 Easter Math

A round table at the Easter brunch is 8 feet across (its diameter). Omar puts ribbon once around its edge. How many feet of ribbon is that?

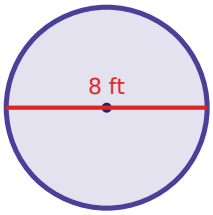

Task card 17 Easter Math

Noah uses 4 cups of shredded carrot to make 12 carrot muffins. How many cups of shredded carrot are needed for 20 carrot muffins?

Task card 18 Easter Math

A round table at the Easter brunch is 9 feet across (its diameter). Sam puts ribbon once around its edge. How many feet of ribbon is that?

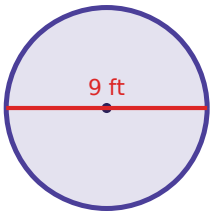

Task card 19 Easter Math

A pot of tulips costs $24.00. It is 50% off, and then 5% sales tax is added to the sale price. What is the total price?

Task card 20 Easter Math

A round table at the Easter brunch is 9 feet across (its diameter). Lily puts ribbon once around its edge. How many feet of ribbon is that?

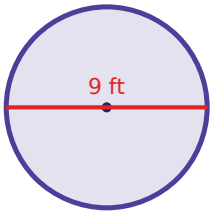

Task card 21 Easter Math

Ava uses 3 cups of shredded carrot to make 8 bunny cookies. How many cups of shredded carrot are needed for 34 bunny cookies?

Task card 22 Easter Math

A grab bag at the Easter brunch holds 1 painted egg, 1 paper flower and 2 bunny stickers. Zoe takes one without looking. What is the probability that it is a bunny sticker?

Task card 23 Easter Math

A grab bag at the Easter brunch holds 4 painted eggs, 9 paper flowers and 6 bunny stickers. Omar takes one without looking. What is the probability that it is a paper flower?

Task card 24 Easter Math

A chocolate bunny costs $19.00. It is 20% off, and then 5% sales tax is added to the sale price. What is the total price?

Easter Math Task Cards

Recording sheet · Grade 7 · Read each story and solve. Write money like $12.60 and probabilities as fractions in simplest form. Use 3.14 for π and round to the nearest tenth.

Scan to check your answers

Name: _____ Date: _____

1	2	3	4
5	6	7	8
9	10	11	12
13	14	15	16
17	18	19	20
21	22	23	24

Easter Math Task Cards: Answer Key

Grade 7 · Medium

The answers online

1. $7.20	**2.** 50.2	**3.** $\frac{3}{16}$
4. $2.00	**5.** 2	**6.** $\frac{4}{17}$
7. $11\frac{1}{4}$	**8.** 22	**9.** $5\frac{1}{2}$
10. $6.80	**11.** $\frac{3}{7}$	**12.** $6.62
13. $\frac{8}{19}$	**14.** 15.7	**15.** $6\frac{3}{4}$
16. 25.1	**17.** $6\frac{2}{3}$	**18.** 28.3
19. $12.60	**20.** 28.3	**21.** $12\frac{3}{4}$
22. $\frac{1}{2}$	**23.** $\frac{9}{19}$	**24.** $15.96