Task card 1 Easter Math

A round table at the Easter brunch is 4 feet across (its diameter). Omar puts ribbon once around its edge. How many feet of ribbon is that?

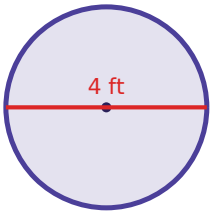

Task card 2 Easter Math

A bag of jelly beans costs $9.00. It is on sale for 25% off. What is the sale price?

Task card 3 Easter Math

A round table at the Easter brunch is 3 feet across (its diameter). Sam puts ribbon once around its edge. How many feet of ribbon is that?

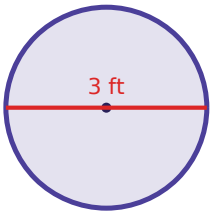

Task card 4 Easter Math

A grab bag at the Easter brunch holds 2 painted eggs, 4 paper flowers and 3 bunny stickers. Lily takes one without looking. What is the probability that it is a bunny sticker?

Task card 5 Easter Math

Ella uses 1 cup of shredded carrot to make 8 carrot muffins. How many cups of shredded carrot are needed for 36 carrot muffins?

Task card 6 Easter Math

A grab bag at the Easter brunch holds 4 painted eggs, 3 paper flowers and 4 bunny stickers. Zoe takes one without looking. What is the probability that it is a bunny sticker?

Task card 7 Easter Math

Lily uses 1 cup of shredded carrot to make 4 hot cross buns. How many cups of shredded carrot are needed for 14 hot cross buns?

Task card 8 Easter Math

A bag of jelly beans costs $5.00. It is on sale for 10% off. What is the sale price?

Task card 9 Easter Math

Ava uses 3 cups of shredded carrot to make 4 hot cross buns. How many cups of shredded carrot are needed for 9 hot cross buns?

Task card 10 Easter Math

A grab bag at the Easter brunch holds 1 painted egg, 1 paper flower and 5 bunny stickers. Ella takes one without looking. What is the probability that it is a painted egg?

Task card 11 Easter Math

A pot of tulips costs $30.00. It is on sale for 40% off. What is the sale price?

Task card 12 Easter Math

A grab bag at the Easter brunch holds 3 painted eggs, 3 paper flowers and 2 bunny stickers. Ben takes one without looking. What is the probability that it is a painted egg?

Task card 13 Easter Math

A round tablecloth for the Easter brunch has a radius of 3 feet. What is its area in square feet?

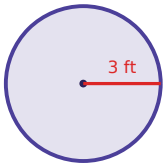

Task card 14 Easter Math

A bag of jelly beans costs $14.00. It is on sale for 40% off. What is the sale price?

Task card 15 Easter Math

A round table at the Easter brunch is 6 feet across (its diameter). Noah puts ribbon once around its edge. How many feet of ribbon is that?

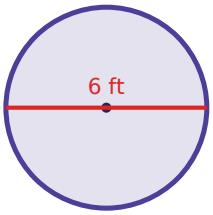

Task card 16 Easter Math

Mia uses 1 cup of shredded carrot to make 4 bunny cookies. How many cups of shredded carrot are needed for 11 bunny cookies?

Task card 17 Easter Math

A round tablecloth for the Easter brunch has a radius of 4 feet. What is its area in square feet?

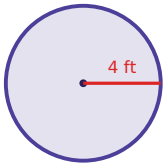

Task card 18 Easter Math

Sam uses 2 cups of shredded carrot to make 4 hot cross buns. How many cups of shredded carrot are needed for 10 hot cross buns?

Task card 19 Easter Math

A bag of jelly beans costs $11.00. It is on sale for 30% off. What is the sale price?

Task card 20 Easter Math

A grab bag at the Easter brunch holds 6 painted eggs, 2 paper flowers and 2 bunny stickers. Sam takes one without looking. What is the probability that it is a paper flower?

Task card 21 Easter Math

A grab bag at the Easter brunch holds 3 painted eggs, 4 paper flowers and 6 bunny stickers. Zoe takes one without looking. What is the probability that it is a bunny sticker?

Task card 22 Easter Math

A bag of jelly beans costs $10.00. It is on sale for 40% off. What is the sale price?

Task card 23 Easter Math

A round table at the Easter brunch is 5 feet across (its diameter). Leo puts ribbon once around its edge. How many feet of ribbon is that?

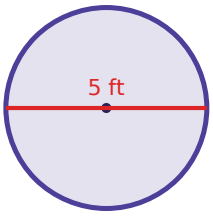

Task card 24 Easter Math

Ava uses 1 cup of shredded carrot to make 8 hot cross buns. How many cups of shredded carrot are needed for 10 hot cross buns?

Easter Math Task Cards

Recording sheet · Grade 7 · Read each story and solve. Write money like $12.60 and probabilities as fractions in simplest form. Use 3.14 for π and round to the nearest tenth.

Scan to check your answers

Name: _____ Date: _____

1	2	3	4
5	6	7	8
9	10	11	12
13	14	15	16
17	18	19	20
21	22	23	24

Easter Math Task Cards: Answer Key

Grade 7 · Easy

The answers online

1. 12.6	**2.** $6.75	**3.** 9.4
4. $\frac{1}{3}$	**5.** $4\frac{1}{2}$	**6.** $\frac{4}{11}$
7. $3\frac{1}{2}$	**8.** $4.50	**9.** $6\frac{3}{4}$
10. $\frac{1}{7}$	**11.** $18.00	**12.** $\frac{3}{8}$
13. 28.3	**14.** $8.40	**15.** 18.8
16. $2\frac{3}{4}$	**17.** 50.2	**18.** 5
19. $7.70	**20.** $\frac{1}{5}$	**21.** $\frac{6}{13}$
22. $6.00	**23.** 15.7	**24.** $1\frac{1}{4}$