Easter Math · 1

A pot of tulips costs $12.00. It is on sale for 40% off. What is the sale price?

Easter Math · 2

A round tablecloth for the Easter brunch has a radius of 4 feet. What is its area in square feet?

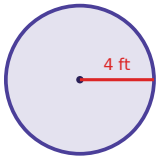

Easter Math · 3

A grab bag at the Easter brunch holds 6 painted eggs, 3 paper flowers and 7 bunny stickers. Omar takes one without looking. What is the probability that it is a paper flower?

Easter Math · 4

A bag of jelly beans costs $4.00. It is on sale for 50% off. What is the sale price?

Easter Math · 5

Ben uses 1 cup of shredded carrot to make 8 bunny cookies. How many cups of shredded carrot are needed for 16 bunny cookies?

Easter Math · 6

A grab bag at the Easter brunch holds 6 painted eggs, 4 paper flowers and 7 bunny stickers. Ella takes one without looking. What is the probability that it is a paper flower?

Easter Math · 7

Sam uses 3 cups of shredded carrot to make 8 carrot muffins. How many cups of shredded carrot are needed for 30 carrot muffins?

Easter Math · 8

A round table at the Easter brunch is 7 feet across (its diameter). Lily puts ribbon once around its edge. How many feet of ribbon is that?

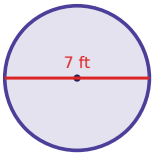

Easter Math · 2

ANSWER

50.2

Easter Math · 1

ANSWER

$7.20

Easter Math · 4

ANSWER

$2.00

Easter Math · 3

ANSWER

$$\frac{3}{16}$$

Easter Math · 6

ANSWER

$$\frac{4}{17}$$

Easter Math · 5

ANSWER

2

Easter Math · 8

ANSWER

22

Easter Math · 7

ANSWER

$$11\frac{1}{4}$$

Easter Math · 9

Mia uses 3 cups of shredded carrot to make 12 bunny cookies. How many cups of shredded carrot are needed for 22 bunny cookies?

Easter Math · 10

A bag of jelly beans costs $9.00. It is 30% off, and then 8% sales tax is added to the sale price. What is the total price?

Easter Math · 11

A grab bag at the Easter brunch holds 2 painted eggs, 6 paper flowers and 6 bunny stickers. Sam takes one without looking. What is the probability that it is a paper flower?

Easter Math · 12

A chocolate bunny costs $7.00. It is 10% off, and then 5% sales tax is added to the sale price. What is the total price?

Easter Math · 13

A grab bag at the Easter brunch holds 6 painted eggs, 5 paper flowers and 8 bunny stickers. Lily takes one without looking. What is the probability that it is a bunny sticker?

Easter Math · 14

A round table at the Easter brunch is 5 feet across (its diameter). Ava puts ribbon once around its edge. How many feet of ribbon is that?

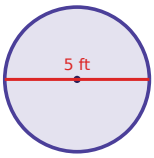

Easter Math · 15

Sam uses 3 cups of shredded carrot to make 12 carrot muffins. How many cups of shredded carrot are needed for 27 carrot muffins?

Easter Math · 16

A round table at the Easter brunch is 8 feet across (its diameter). Omar puts ribbon once around its edge. How many feet of ribbon is that?

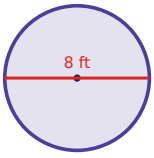

Easter Math · 10

ANSWER

$6.80

Easter Math · 9

ANSWER

$$5\frac{1}{2}$$

Easter Math · 12

ANSWER

$6.62

Easter Math · 11

ANSWER

$$\frac{3}{7}$$

Easter Math · 14

ANSWER

15.7

Easter Math · 13

ANSWER

$$\frac{8}{19}$$

Easter Math · 16

ANSWER

25.1

Easter Math · 15

ANSWER

$$6\frac{3}{4}$$

Easter Math · 17

Noah uses 4 cups of shredded carrot to make 12 carrot muffins. How many cups of shredded carrot are needed for 20 carrot muffins?

Easter Math · 18

A round table at the Easter brunch is 9 feet across (its diameter). Sam puts ribbon once around its edge. How many feet of ribbon is that?

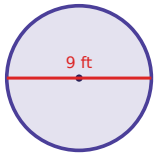

Easter Math · 19

A pot of tulips costs $24.00. It is 50% off, and then 5% sales tax is added to the sale price. What is the total price?

Easter Math · 20

A round table at the Easter brunch is 9 feet across (its diameter). Lily puts ribbon once around its edge. How many feet of ribbon is that?

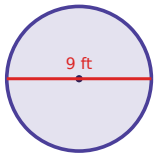

Easter Math · 21

Ava uses 3 cups of shredded carrot to make 8 bunny cookies. How many cups of shredded carrot are needed for 34 bunny cookies?

Easter Math · 22

A grab bag at the Easter brunch holds 1 painted egg, 1 paper flower and 2 bunny stickers. Zoe takes one without looking. What is the probability that it is a bunny sticker?

Easter Math · 23

A grab bag at the Easter brunch holds 4 painted eggs, 9 paper flowers and 6 bunny stickers. Omar takes one without looking. What is the probability that it is a paper flower?

Easter Math · 24

A chocolate bunny costs $19.00. It is 20% off, and then 5% sales tax is added to the sale price. What is the total price?

Easter Math · 18

ANSWER

28.3

Easter Math · 17

ANSWER

$6\frac{2}{3}$

Easter Math · 20

ANSWER

28.3

Easter Math · 19

ANSWER

$12.60

Easter Math · 22

ANSWER

$\frac{1}{2}$

Easter Math · 21

ANSWER

$12\frac{3}{4}$

Easter Math · 24

ANSWER

$15.96

Easter Math · 23

ANSWER

$\frac{9}{19}$