Easter Math · 1

A round tablecloth for the Easter brunch has a radius of 5 feet. What is its area in square feet?

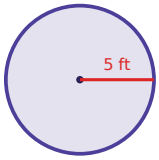

Easter Math · 2

A round table at the Easter brunch is 9 feet across (its diameter). Ella puts ribbon once around its edge. How many feet of ribbon is that?

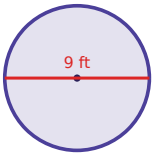

Easter Math · 3

A grab bag at the Easter brunch holds 4 painted eggs, 2 paper flowers and 3 bunny stickers. Noah takes one without looking. What is the probability that it is a bunny sticker?

Easter Math · 4

Sam uses 4 cups of shredded carrot to make 12 hot cross buns. How many cups of shredded carrot are needed for 6 hot cross buns?

Easter Math · 5

A chocolate bunny costs $16.00. It is 20% off, and then 5% sales tax is added to the sale price. What is the total price?

Easter Math · 6

A grab bag at the Easter brunch holds 7 painted eggs, 2 paper flowers and 4 bunny stickers. Ben takes one without looking. What is the probability that it is a paper flower?

Easter Math · 7

A pot of tulips costs $27.00. It is 20% off, and then 8% sales tax is added to the sale price. What is the total price?

Easter Math · 8

Leo uses 2 cups of shredded carrot to make 4 carrot muffins. How many cups of shredded carrot are needed for 3 carrot muffins?

Easter Math · 2

ANSWER

28.3

Easter Math · 1

ANSWER

78.5

Easter Math · 4

ANSWER

2

Easter Math · 3

ANSWER

$$\frac{1}{3}$$

Easter Math · 6

ANSWER

$$\frac{2}{13}$$

Easter Math · 5

ANSWER

$13.44

Easter Math · 8

ANSWER

$$1\ \frac{1}{2}$$

Easter Math · 7

ANSWER

$23.33

Easter Math · 9

Mia uses 2 cups of shredded carrot to make 8 bunny cookies. How many cups of shredded carrot are needed for 16 bunny cookies?

Easter Math · 10

A grab bag at the Easter brunch holds 6 painted eggs, 7 paper flowers and 8 bunny stickers. Leo takes one without looking. What is the probability that it is a paper flower?

Easter Math · 11

A chocolate bunny costs $13.00. It is 10% off, and then 8% sales tax is added to the sale price. What is the total price?

Easter Math · 12

A round table at the Easter brunch is 7 feet across (its diameter). Lily puts ribbon once around its edge. How many feet of ribbon is that?

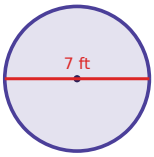

Easter Math · 13

A chocolate bunny costs $10.00. It is 50% off, and then 5% sales tax is added to the sale price. What is the total price?

Easter Math · 14

A round tablecloth for the Easter brunch has a radius of 6 feet. What is its area in square feet?

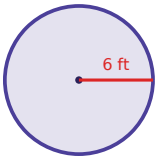

Easter Math · 15

A grab bag at the Easter brunch holds 9 painted eggs, 1 paper flower and 4 bunny stickers. Ben takes one without looking. What is the probability that it is a bunny sticker?

Easter Math · 16

Ella uses 2 cups of shredded carrot to make 12 hot cross buns. How many cups of shredded carrot are needed for 21 hot cross buns?

Easter Math · 10

ANSWER

$\frac{1}{3}$

Easter Math · 9

ANSWER

4

Easter Math · 12

ANSWER

22

Easter Math · 11

ANSWER

$12.64

Easter Math · 14

ANSWER

113

Easter Math · 13

ANSWER

$5.25

Easter Math · 16

ANSWER

$3\frac{1}{2}$

Easter Math · 15

ANSWER

$\frac{2}{7}$

Easter Math · 17

Ava uses 2 cups of shredded carrot to make 4 carrot muffins. How many cups of shredded carrot are needed for 33 carrot muffins?

Easter Math · 18

A chocolate bunny costs $10.00. It is 50% off, and then 6% sales tax is added to the sale price. What is the total price?

Easter Math · 19

A bag of jelly beans costs $4.00. It is 30% off, and then 6% sales tax is added to the sale price. What is the total price?

Easter Math · 20

A grab bag at the Easter brunch holds 7 painted eggs, 5 paper flowers and 9 bunny stickers. Ella takes one without looking. What is the probability that it is a paper flower?

Easter Math · 21

A round table at the Easter brunch is 9 feet across (its diameter). Sam puts ribbon once around its edge. How many feet of ribbon is that?

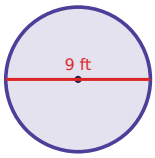

Easter Math · 22

A grab bag at the Easter brunch holds 3 painted eggs, 1 paper flower and 5 bunny stickers. Ella takes one without looking. What is the probability that it is a paper flower?

Easter Math · 23

Noah uses 2 cups of shredded carrot to make 12 hot cross buns. How many cups of shredded carrot are needed for 6 hot cross buns?

Easter Math · 24

A grab bag at the Easter brunch holds 5 painted eggs, 9 paper flowers and 9 bunny stickers. Leo takes one without looking. What is the probability that it is a paper flower?

Easter Math · 18

ANSWER

$5.30

Easter Math · 17

ANSWER

$16\frac{1}{2}$

Easter Math · 20

ANSWER

$\frac{5}{21}$

Easter Math · 19

ANSWER

$2.97

Easter Math · 22

ANSWER

$\frac{1}{9}$

Easter Math · 21

ANSWER

28.3

Easter Math · 24

ANSWER

$\frac{9}{23}$

Easter Math · 23

ANSWER

1