Easter Math · 1

A round table at the Easter brunch is 4 feet across (its diameter). Omar puts ribbon once around its edge. How many feet of ribbon is that?

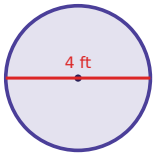

Easter Math · 2

A bag of jelly beans costs $9.00. It is on sale for 25% off. What is the sale price?

Easter Math · 3

A round table at the Easter brunch is 3 feet across (its diameter). Sam puts ribbon once around its edge. How many feet of ribbon is that?

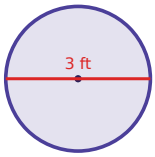

Easter Math · 4

A grab bag at the Easter brunch holds 2 painted eggs, 4 paper flowers and 3 bunny stickers. Lily takes one without looking. What is the probability that it is a bunny sticker?

Easter Math · 5

Ella uses 1 cup of shredded carrot to make 8 carrot muffins. How many cups of shredded carrot are needed for 36 carrot muffins?

Easter Math · 6

A grab bag at the Easter brunch holds 4 painted eggs, 3 paper flowers and 4 bunny stickers. Zoe takes one without looking. What is the probability that it is a bunny sticker?

Easter Math · 7

Lily uses 1 cup of shredded carrot to make 4 hot cross buns. How many cups of shredded carrot are needed for 14 hot cross buns?

Easter Math · 8

A bag of jelly beans costs $5.00. It is on sale for 10% off. What is the sale price?

Easter Math · 2

ANSWER

$6.75

Easter Math · 1

ANSWER

12.6

Easter Math · 4

ANSWER

$$\frac{1}{3}$$

Easter Math · 3

ANSWER

9.4

Easter Math · 6

ANSWER

$$\frac{4}{11}$$

Easter Math · 5

ANSWER

$$4\frac{1}{2}$$

Easter Math · 8

ANSWER

$4.50

Easter Math · 7

ANSWER

$$3\frac{1}{2}$$

Easter Math · 9

Ava uses 3 cups of shredded carrot to make 4 hot cross buns. How many cups of shredded carrot are needed for 9 hot cross buns?

Easter Math · 10

A grab bag at the Easter brunch holds 1 painted egg, 1 paper flower and 5 bunny stickers. Ella takes one without looking. What is the probability that it is a painted egg?

Easter Math · 11

A pot of tulips costs $30.00. It is on sale for 40% off. What is the sale price?

Easter Math · 12

A grab bag at the Easter brunch holds 3 painted eggs, 3 paper flowers and 2 bunny stickers. Ben takes one without looking. What is the probability that it is a painted egg?

Easter Math · 13

A round tablecloth for the Easter brunch has a radius of 3 feet. What is its area in square feet?

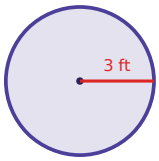

Easter Math · 14

A bag of jelly beans costs $14.00. It is on sale for 40% off. What is the sale price?

Easter Math · 15

A round table at the Easter brunch is 6 feet across (its diameter). Noah puts ribbon once around its edge. How many feet of ribbon is that?

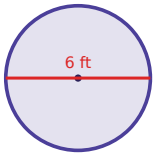

Easter Math · 16

Mia uses 1 cup of shredded carrot to make 4 bunny cookies. How many cups of shredded carrot are needed for 11 bunny cookies?

Easter Math · 10

ANSWER

$\frac{1}{7}$

Easter Math · 9

ANSWER

$6\frac{3}{4}$

Easter Math · 12

ANSWER

$\frac{3}{8}$

Easter Math · 11

ANSWER

$18.00

Easter Math · 14

ANSWER

$8.40

Easter Math · 13

ANSWER

28.3

Easter Math · 16

ANSWER

$2\frac{3}{4}$

Easter Math · 15

ANSWER

18.8

Easter Math · 17

A round tablecloth for the Easter brunch has a radius of 4 feet. What is its area in square feet?

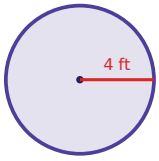

Easter Math · 18

Sam uses 2 cups of shredded carrot to make 4 hot cross buns. How many cups of shredded carrot are needed for 10 hot cross buns?

Easter Math · 19

A bag of jelly beans costs $11.00. It is on sale for 30% off. What is the sale price?

Easter Math · 20

A grab bag at the Easter brunch holds 6 painted eggs, 2 paper flowers and 2 bunny stickers. Sam takes one without looking. What is the probability that it is a paper flower?

Easter Math · 21

A grab bag at the Easter brunch holds 3 painted eggs, 4 paper flowers and 6 bunny stickers. Zoe takes one without looking. What is the probability that it is a bunny sticker?

Easter Math · 22

A bag of jelly beans costs $10.00. It is on sale for 40% off. What is the sale price?

Easter Math · 23

A round table at the Easter brunch is 5 feet across (its diameter). Leo puts ribbon once around its edge. How many feet of ribbon is that?

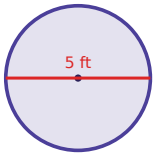

Easter Math · 24

Ava uses 1 cup of shredded carrot to make 8 hot cross buns. How many cups of shredded carrot are needed for 10 hot cross buns?

Easter Math · 18

ANSWER

5

Easter Math · 17

ANSWER

50.2

Easter Math · 20

ANSWER

$$\frac{1}{5}$$

Easter Math · 19

ANSWER

$7.70

Easter Math · 22

ANSWER

$6.00

Easter Math · 21

ANSWER

$$\frac{6}{13}$$

Easter Math · 24

ANSWER

$$1\frac{1}{4}$$

Easter Math · 23

ANSWER

15.7