Cross Sections of 3D Figures · 1

A plane slices the triangular prism parallel to its triangular faces. What shape is the cross section? (circle, triangle, square, or rectangle)

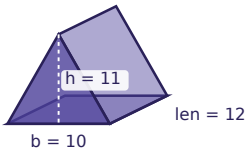

Cross Sections of 3D Figures · 2

A plane slices the cylinder parallel to its base. What shape is the cross section? (circle, triangle, square, or rectangle)

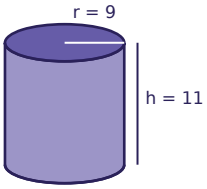

Cross Sections of 3D Figures · 3

A plane slices the cone parallel to its base. What shape is the cross section? (circle, triangle, square, or rectangle)

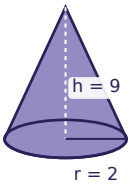

Cross Sections of 3D Figures · 4

A plane slices the rectangular prism parallel to the front face. What is the area of the cross section in square units?

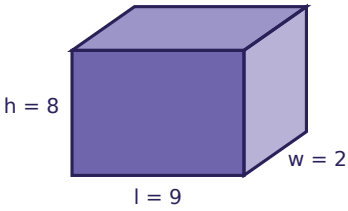

Cross Sections of 3D Figures · 5

A plane slices the triangular prism parallel to its triangular faces. What is the area of the cross section in square units?

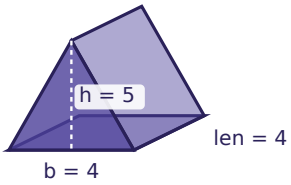

Cross Sections of 3D Figures · 6

A plane slices the cylinder perpendicular to its base, through the center of the base. What is the area of the cross section in square units?

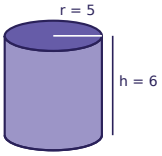

Cross Sections of 3D Figures · 7

A plane slices the rectangular prism parallel to its base. What is the area of the cross section in square units?

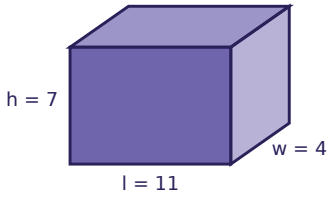

Cross Sections of 3D Figures · 8

A plane slices the square pyramid perpendicular to its base, through its tip, parallel to one side of the base. What is the area of the cross section in square units?

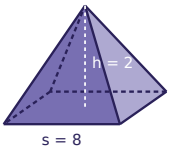

Cross Sections of 3D Figures · 2

ANSWER

Circle

Cross Sections of 3D Figures · 1

ANSWER

Triangle

Cross Sections of 3D Figures · 4

ANSWER

72

Cross Sections of 3D Figures · 3

ANSWER

Circle

Cross Sections of 3D Figures · 6

ANSWER

60

Cross Sections of 3D Figures · 5

ANSWER

10

Cross Sections of 3D Figures · 8

ANSWER

8

Cross Sections of 3D Figures · 7

ANSWER

44

Cross Sections of 3D Figures · 9

A plane slices the triangular prism parallel to its triangular faces. What shape is the cross section? (circle, triangle, square, or rectangle)

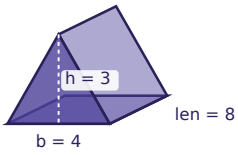

Cross Sections of 3D Figures · 10

A plane slices the rectangular prism perpendicular to its base, parallel to the front face. What shape is the cross section? (circle, triangle, square, or rectangle)

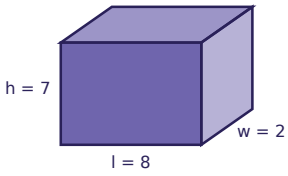

Cross Sections of 3D Figures · 11

A plane slices the square pyramid perpendicular to its base, through its tip. What shape is the cross section? (circle, triangle, square, or rectangle)

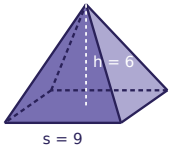

Cross Sections of 3D Figures · 12

A plane slices the square pyramid perpendicular to its base, through its tip, parallel to one side of the base. What is the area of the cross section in square units?

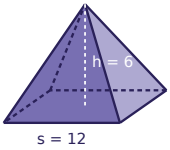

Cross Sections of 3D Figures · 13

A plane slices the rectangular prism parallel to the right side face. What is the area of the cross section in square units?

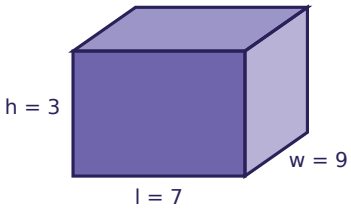

Cross Sections of 3D Figures · 14

A plane slices the cube parallel to its top face. What is the area of the cross section in square units?

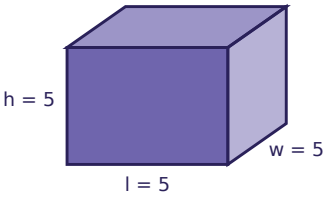

Cross Sections of 3D Figures · 15

A plane slices the triangular prism parallel to its triangular faces. What is the area of the cross section in square units?

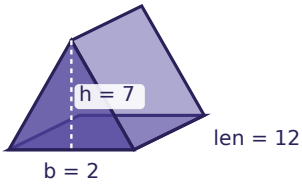

Cross Sections of 3D Figures · 16

A plane slices the cylinder parallel to its base. What is the area of the cross section in square units?

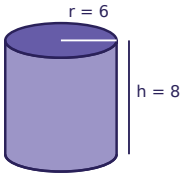

Cross Sections of 3D Figures · 10

ANSWER

Rectangle

Cross Sections of 3D Figures · 9

ANSWER

Triangle

Cross Sections of 3D Figures · 12

ANSWER

36

Cross Sections of 3D Figures · 11

ANSWER

Triangle

Cross Sections of 3D Figures · 14

ANSWER

25

Cross Sections of 3D Figures · 13

ANSWER

27

Cross Sections of 3D Figures · 16

ANSWER

113

Cross Sections of 3D Figures · 15

ANSWER

7

Cross Sections of 3D Figures · 17

A plane slices the sphere through its center. What shape is the cross section? (circle, triangle, square, or rectangle)

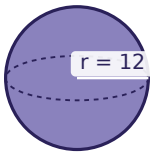

Cross Sections of 3D Figures · 18

A plane slices the square pyramid perpendicular to its base, through its tip. What shape is the cross section? (circle, triangle, square, or rectangle)

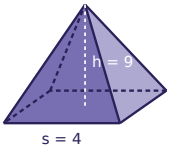

Cross Sections of 3D Figures · 19

A plane slices the cone perpendicular to its base, through its tip. What shape is the cross section? (circle, triangle, square, or rectangle)

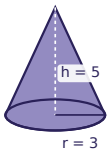

Cross Sections of 3D Figures · 20

A plane slices the rectangular prism parallel to its base. What is the area of the cross section in square units?

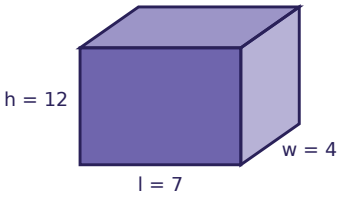

Cross Sections of 3D Figures · 21

A plane slices the cylinder perpendicular to its base, through the center of the base. What is the area of the cross section in square units?

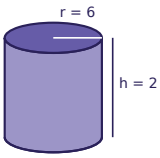

Cross Sections of 3D Figures · 22

A plane slices the cone perpendicular to its base, through its tip. What is the area of the cross section in square units?

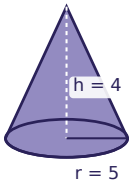

Cross Sections of 3D Figures · 23

A plane slices the rectangular prism parallel to the right side face. What is the area of the cross section in square units?

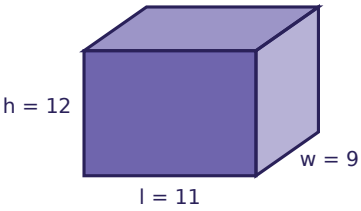

Cross Sections of 3D Figures · 24

A plane slices the triangular prism parallel to its triangular faces. What is the area of the cross section in square units?

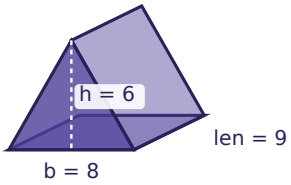

Cross Sections of 3D Figures · 18

ANSWER

Triangle

Cross Sections of 3D Figures · 17

ANSWER

Circle

Cross Sections of 3D Figures · 20

ANSWER

28

Cross Sections of 3D Figures · 19

ANSWER

Triangle

Cross Sections of 3D Figures · 22

ANSWER

20

Cross Sections of 3D Figures · 21

ANSWER

24

Cross Sections of 3D Figures · 24

ANSWER

24

Cross Sections of 3D Figures · 23

ANSWER

108