Area of Composite Figures · 1

Find the area of the figure in square yards.

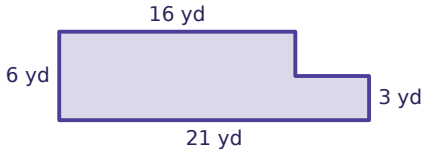

Area of Composite Figures · 2

Find the area of the figure in square meters.

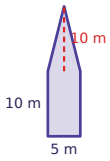

Area of Composite Figures · 3

Find the area of the figure in square meters. The curved end is a semicircle.

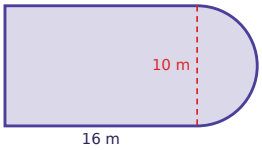

Area of Composite Figures · 4

Find the area of the figure in square feet. Both curved ends are semicircles.

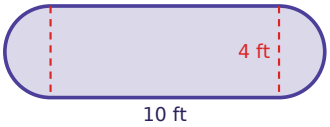

Area of Composite Figures · 5

A rectangle is cut out of a larger rectangle. Find the area of the figure in square centimeters. (Do not include the hole.)

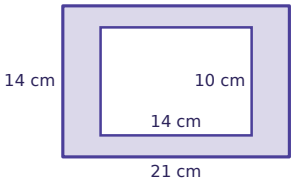

Area of Composite Figures · 6

Find the area of the figure in square yards. The curved end is a semicircle.



Area of Composite Figures · 7

Find the area of the figure in square feet. Both curved ends are semicircles.

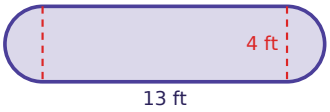

Area of Composite Figures · 8

Find the area of the figure in square centimeters.

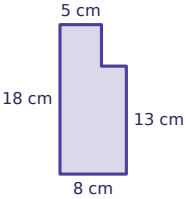

Area of Composite Figures · 2

ANSWER

75

Area of Composite Figures · 1

ANSWER

111

Area of Composite Figures · 4

ANSWER

52.6

Area of Composite Figures · 3

ANSWER

199.3

Area of Composite Figures · 6

ANSWER

66.3

Area of Composite Figures · 5

ANSWER

154

Area of Composite Figures · 8

ANSWER

129

Area of Composite Figures · 7

ANSWER

64.6

Area of Composite Figures · 9

Find the area of the figure in square inches.

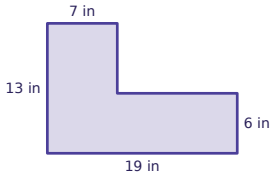

Area of Composite Figures · 10

Find the area of the figure in square meters.

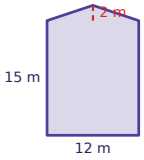

Area of Composite Figures · 11

Find the area of the figure in square centimeters. The curved end is a semicircle.

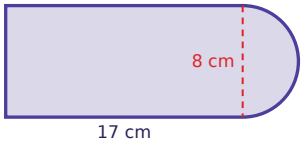

Area of Composite Figures · 12

Find the area of the figure in square feet. Both curved ends are semicircles.

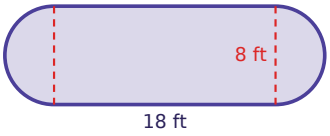

Area of Composite Figures · 13

A rectangle is cut out of a larger rectangle. Find the area of the figure in square feet. (Do not include the hole.)

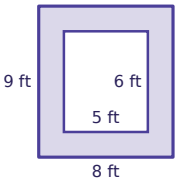

Area of Composite Figures · 14

Find the area of the figure in square yards. The curved end is a semicircle.



Area of Composite Figures · 15

Find the area of the figure in square meters. Both curved ends are semicircles.

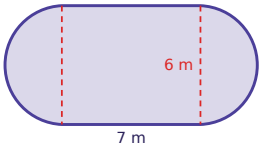

Area of Composite Figures · 16

Find the area of the figure in square feet.

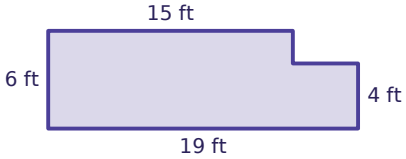

Area of Composite Figures · 10

ANSWER

192

Area of Composite Figures · 9

ANSWER

163

Area of Composite Figures · 12

ANSWER

194.2

Area of Composite Figures · 11

ANSWER

161.1

Area of Composite Figures · 14

ANSWER

21.6

Area of Composite Figures · 13

ANSWER

42

Area of Composite Figures · 16

ANSWER

106

Area of Composite Figures · 15

ANSWER

70.3

Area of Composite Figures · 17

Find the area of the figure in square feet.

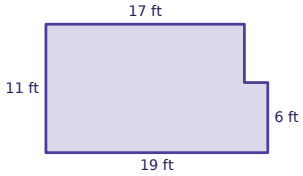

Area of Composite Figures · 18

Find the area of the figure in square yards.

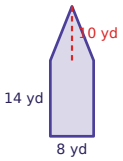

Area of Composite Figures · 19

Find the area of the figure in square centimeters. The curved end is a semicircle.

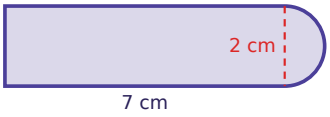

Area of Composite Figures · 20

Find the area of the figure in square feet. Both curved ends are semicircles.

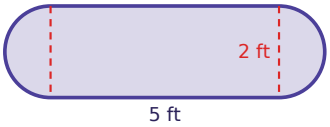

Area of Composite Figures · 21

A rectangle is cut out of a larger rectangle. Find the area of the figure in square inches. (Do not include the hole.)

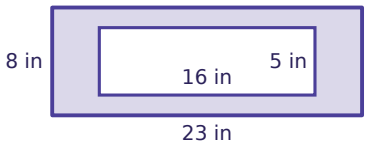

Area of Composite Figures · 22

Find the area of the figure in square centimeters. The curved end is a semicircle.



Area of Composite Figures · 23

Find the area of the figure in square yards. Both curved ends are semicircles.

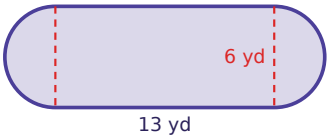

Area of Composite Figures · 24

Find the area of the figure in square inches.

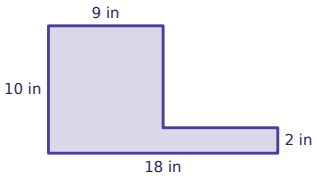

Area of Composite Figures · 18

ANSWER

152

Area of Composite Figures · 17

ANSWER

199

Area of Composite Figures · 20

ANSWER

13.1

Area of Composite Figures · 19

ANSWER

15.6

Area of Composite Figures · 22

ANSWER

21.6

Area of Composite Figures · 21

ANSWER

104

Area of Composite Figures · 24

ANSWER

108

Area of Composite Figures · 23

ANSWER

106.3