Area of Composite Figures · 1

Find the area of the figure in square inches.

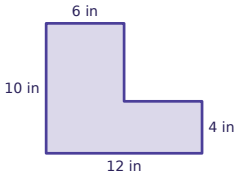

Area of Composite Figures · 2

Find the area of the figure in square centimeters.

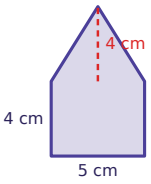

Area of Composite Figures · 3

A rectangle is cut out of a larger rectangle. Find the area of the figure in square centimeters. (Do not include the hole.)

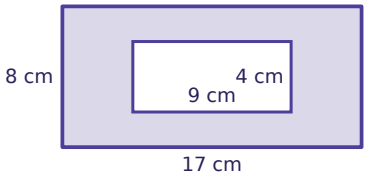

Area of Composite Figures · 4

Find the area of the figure in square inches.

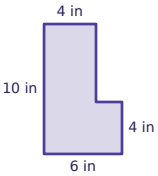

Area of Composite Figures · 5

Find the area of the figure in square centimeters.

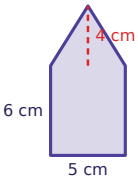

Area of Composite Figures · 6

A rectangle is cut out of a larger rectangle. Find the area of the figure in square feet. (Do not include the hole.)

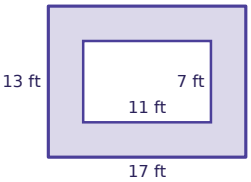

Area of Composite Figures · 7

Find the area of the figure in square centimeters.

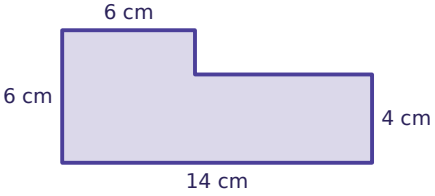

Area of Composite Figures · 8

Find the area of the figure in square inches.

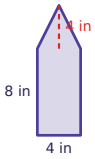

Area of Composite Figures · 2

ANSWER

30

Area of Composite Figures · 1

ANSWER

84

Area of Composite Figures · 4

ANSWER

48

Area of Composite Figures · 3

ANSWER

100

Area of Composite Figures · 6

ANSWER

144

Area of Composite Figures · 5

ANSWER

40

Area of Composite Figures · 8

ANSWER

40

Area of Composite Figures · 7

ANSWER

68

Area of Composite Figures · 9

Find the area of the figure in square meters.

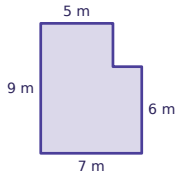

Area of Composite Figures · 10

Find the area of the figure in square centimeters.

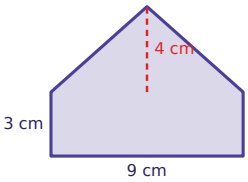

Area of Composite Figures · 11

A rectangle is cut out of a larger rectangle. Find the area of the figure in square feet. (Do not include the hole.)

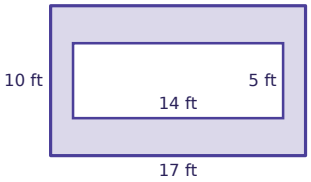

Area of Composite Figures · 12

Find the area of the figure in square centimeters.

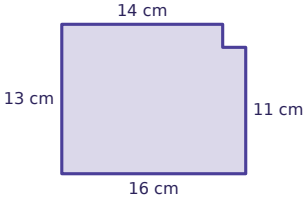

Area of Composite Figures · 13

Find the area of the figure in square inches.

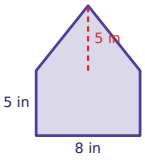

Area of Composite Figures · 14

A rectangle is cut out of a larger rectangle. Find the area of the figure in square feet. (Do not include the hole.)

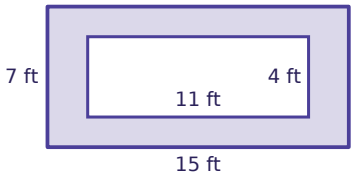

Area of Composite Figures · 15

Find the area of the figure in square feet.

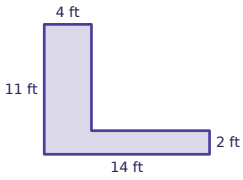

Area of Composite Figures · 16

Find the area of the figure in square feet.

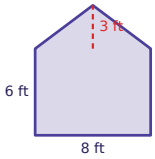

Area of Composite Figures · 10

ANSWER

45

Area of Composite Figures · 9

ANSWER

57

Area of Composite Figures · 12

ANSWER

204

Area of Composite Figures · 11

ANSWER

100

Area of Composite Figures · 14

ANSWER

61

Area of Composite Figures · 13

ANSWER

60

Area of Composite Figures · 16

ANSWER

60

Area of Composite Figures · 15

ANSWER

64

Area of Composite Figures · 17

Find the area of the figure in square yards.

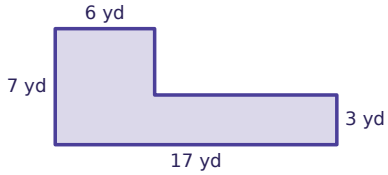

Area of Composite Figures · 18

Find the area of the figure in square centimeters.

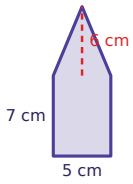

Area of Composite Figures · 19

Find the area of the figure in square centimeters. The curved end is a semicircle.

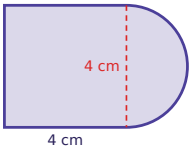

Area of Composite Figures · 20

A rectangle is cut out of a larger rectangle. Find the area of the figure in square inches. (Do not include the hole.)

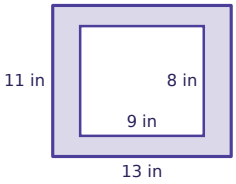

Area of Composite Figures · 21

Find the area of the figure in square meters.

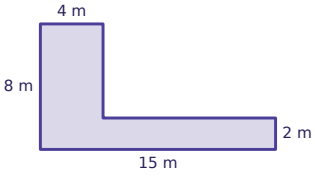

Area of Composite Figures · 22

Find the area of the figure in square inches. The curved end is a semicircle.

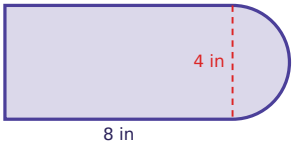

Area of Composite Figures · 23

Find the area of the figure in square centimeters.

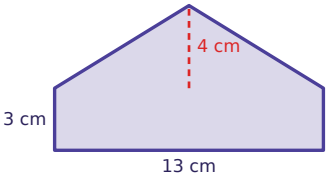

Area of Composite Figures · 24

A rectangle is cut out of a larger rectangle. Find the area of the figure in square meters. (Do not include the hole.)

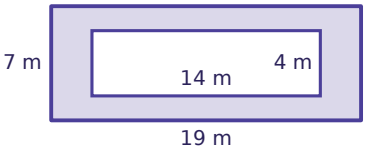

Area of Composite Figures · 18

ANSWER

50

Area of Composite Figures · 17

ANSWER

75

Area of Composite Figures · 20

ANSWER

71

Area of Composite Figures · 19

ANSWER

22.3

Area of Composite Figures · 22

ANSWER

38.3

Area of Composite Figures · 21

ANSWER

54

Area of Composite Figures · 24

ANSWER

77

Area of Composite Figures · 23

ANSWER

65