Complementary & Supplementary Angles · 1

Find the value of x.

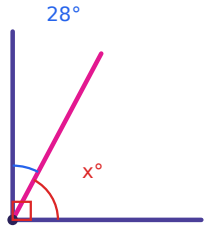

Complementary & Supplementary Angles · 2

Find the value of x.

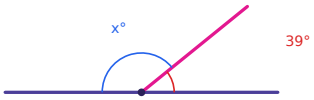

Complementary & Supplementary Angles · 3

The angles are complementary. Find the value of x.

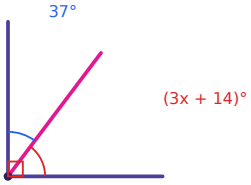

Complementary & Supplementary Angles · 4

The angles are supplementary. Find the value of x.

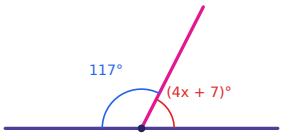

Complementary & Supplementary Angles · 5

What is the measure of the complement of a 19° angle?

Complementary & Supplementary Angles · 6

What is the measure of the supplement of a 160° angle?

Complementary & Supplementary Angles · 7

Are angles measuring 73° and 17° complementary, supplementary, or neither?

Complementary & Supplementary Angles · 8

The angles are supplementary. Find the value of x.

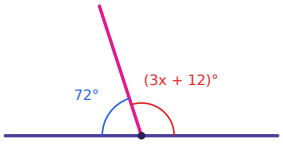

Complementary & Supplementary Angles · 2

ANSWER

141

Complementary & Supplementary Angles · 1

ANSWER

62

Complementary & Supplementary Angles · 4

ANSWER

14

Complementary & Supplementary Angles · 3

ANSWER

13

Complementary & Supplementary Angles · 6

ANSWER

20

Complementary & Supplementary Angles · 5

ANSWER

71

Complementary & Supplementary Angles · 8

ANSWER

32

Complementary & Supplementary Angles · 7

ANSWER

Complementary

Complementary & Supplementary Angles · 9

Find the value of x.

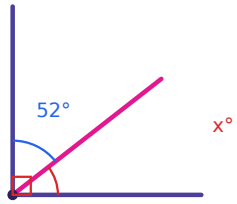

Complementary & Supplementary Angles · 10

Find the value of x.

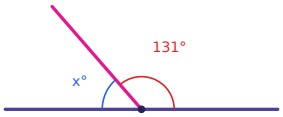

Complementary & Supplementary Angles · 11

The angles are complementary. Find the value of x.

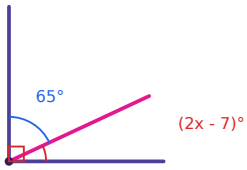

Complementary & Supplementary Angles · 12

The angles are supplementary. Find the value of x.

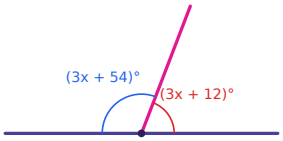

Complementary & Supplementary Angles · 13

An angle is 40° more than its complement. What is the measure of the angle?

Complementary & Supplementary Angles · 14

What is the measure of the supplement of a 136° angle?

Complementary & Supplementary Angles · 15

Are angles measuring 76° and 104° complementary, supplementary, or neither?

Complementary & Supplementary Angles · 16

The angles are complementary. Find the value of x.

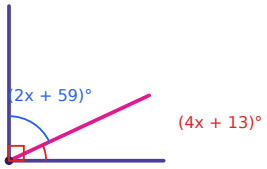

Complementary & Supplementary Angles · 10

ANSWER

49

Complementary & Supplementary Angles · 9

ANSWER

38

Complementary & Supplementary Angles · 12

ANSWER

19

Complementary & Supplementary Angles · 11

ANSWER

16

Complementary & Supplementary Angles · 14

ANSWER

44

Complementary & Supplementary Angles · 13

ANSWER

65

Complementary & Supplementary Angles · 16

ANSWER

3

Complementary & Supplementary Angles · 15

ANSWER

Supplementary

Complementary & Supplementary Angles · 17

Find the value of x.

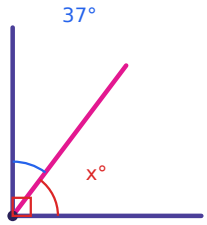

Complementary & Supplementary Angles · 18

Find the value of x.

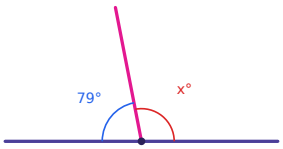

Complementary & Supplementary Angles · 19

The angles are complementary. Find the value of x.

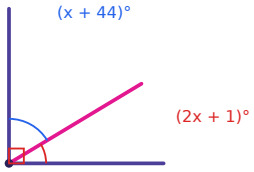

Complementary & Supplementary Angles · 20

The angles are supplementary. Find the value of x.

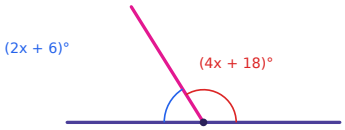

Complementary & Supplementary Angles · 21

An angle is 20° more than its complement. What is the measure of the angle?

Complementary & Supplementary Angles · 22

An angle is 74° more than its supplement. What is the measure of the angle?

Complementary & Supplementary Angles · 23

Are angles measuring 22° and 74° complementary, supplementary, or neither?

Complementary & Supplementary Angles · 24

The angles are supplementary. Find the value of x.

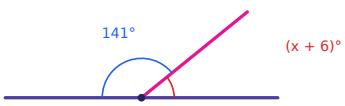

Complementary & Supplementary Angles · 18

ANSWER

101

Complementary & Supplementary Angles · 17

ANSWER

53

Complementary & Supplementary Angles · 20

ANSWER

26

Complementary & Supplementary Angles · 19

ANSWER

15

Complementary & Supplementary Angles · 22

ANSWER

127

Complementary & Supplementary Angles · 21

ANSWER

55

Complementary & Supplementary Angles · 24

ANSWER

33

Complementary & Supplementary Angles · 23

ANSWER

Neither