Complementary & Supplementary Angles · 1

Find the value of x.

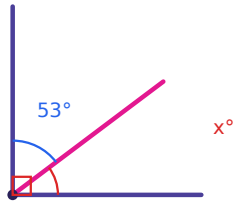

Complementary & Supplementary Angles · 2

Find the value of x.

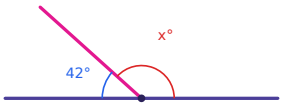

Complementary & Supplementary Angles · 3

The angles are complementary. Find the value of x.

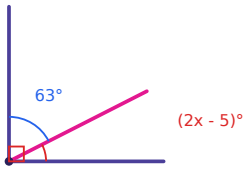

Complementary & Supplementary Angles · 4

The angles are supplementary. Find the value of x.

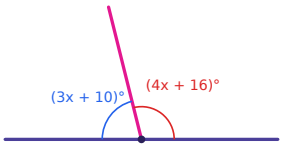

Complementary & Supplementary Angles · 5

An angle is 52° more than its complement. What is the measure of the angle?

Complementary & Supplementary Angles · 6

An angle is 26° more than its supplement. What is the measure of the angle?

Complementary & Supplementary Angles · 7

Are angles measuring 59° and 31° complementary, supplementary, or neither?

Complementary & Supplementary Angles · 8

The angles are complementary. Find the value of x.

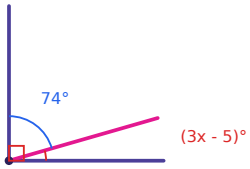

Complementary & Supplementary Angles · 2

ANSWER

138

Complementary & Supplementary Angles · 1

ANSWER

37

Complementary & Supplementary Angles · 4

ANSWER

22

Complementary & Supplementary Angles · 3

ANSWER

16

Complementary & Supplementary Angles · 6

ANSWER

103

Complementary & Supplementary Angles · 5

ANSWER

71

Complementary & Supplementary Angles · 8

ANSWER

7

Complementary & Supplementary Angles · 7

ANSWER

Complementary

Complementary & Supplementary Angles · 9

Find the value of x.

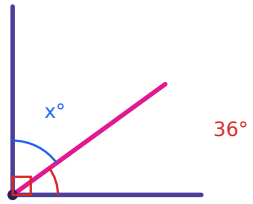

Complementary & Supplementary Angles · 10

Find the value of x.

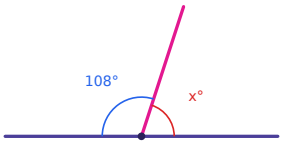

Complementary & Supplementary Angles · 11

The angles are complementary. Find the value of x.

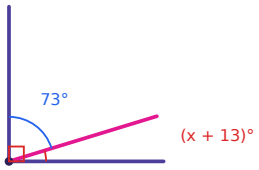

Complementary & Supplementary Angles · 12

The angles are supplementary. Find the value of x.

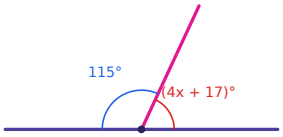

Complementary & Supplementary Angles · 13

An angle is 32° more than its complement. What is the measure of the angle?

Complementary & Supplementary Angles · 14

An angle is 54° more than its supplement. What is the measure of the angle?

Complementary & Supplementary Angles · 15

Are angles measuring 70° and 20° complementary, supplementary, or neither?

Complementary & Supplementary Angles · 16

The angles are complementary. Find the value of x.

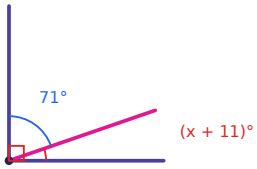

Complementary & Supplementary Angles · 10

ANSWER

72

Complementary & Supplementary Angles · 9

ANSWER

54

Complementary & Supplementary Angles · 12

ANSWER

12

Complementary & Supplementary Angles · 11

ANSWER

4

Complementary & Supplementary Angles · 14

ANSWER

117

Complementary & Supplementary Angles · 13

ANSWER

61

Complementary & Supplementary Angles · 16

ANSWER

8

Complementary & Supplementary Angles · 15

ANSWER

Complementary

Complementary & Supplementary Angles · 17

Find the value of x.

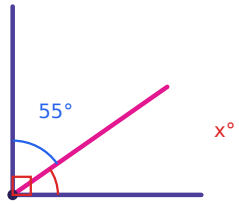

Complementary & Supplementary Angles · 18

Find the value of x.

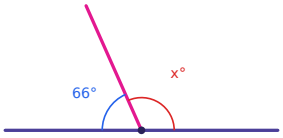

Complementary & Supplementary Angles · 19

The angles are complementary. Find the value of x.

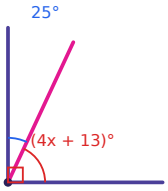

Complementary & Supplementary Angles · 20

The angles are supplementary. Find the value of x.

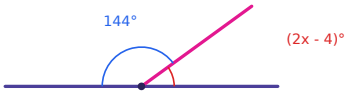

Complementary & Supplementary Angles · 21

An angle is 18° more than its complement. What is the measure of the angle?

Complementary & Supplementary Angles · 22

An angle is 130° more than its supplement. What is the measure of the angle?

Complementary & Supplementary Angles · 23

Are angles measuring 22° and 73° complementary, supplementary, or neither?

Complementary & Supplementary Angles · 24

The angles are supplementary. Find the value of x.

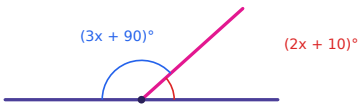

Complementary & Supplementary Angles · 18

ANSWER

114

Complementary & Supplementary Angles · 17

ANSWER

35

Complementary & Supplementary Angles · 20

ANSWER

20

Complementary & Supplementary Angles · 19

ANSWER

13

Complementary & Supplementary Angles · 22

ANSWER

155

Complementary & Supplementary Angles · 21

ANSWER

54

Complementary & Supplementary Angles · 24

ANSWER

16

Complementary & Supplementary Angles · 23

ANSWER

Neither