Complementary & Supplementary Angles · 1

Find the value of x.

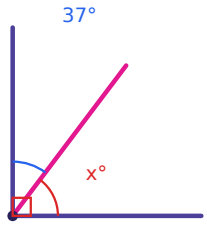

Complementary & Supplementary Angles · 2

Find the value of x.

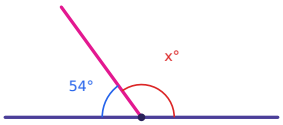

Complementary & Supplementary Angles · 3

Find the value of x.

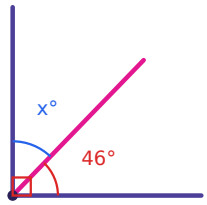

Complementary & Supplementary Angles · 4

Find the value of x.

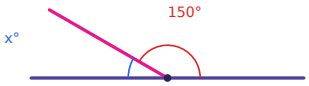

Complementary & Supplementary Angles · 5

What is the measure of the complement of a 52° angle?

Complementary & Supplementary Angles · 6

What is the measure of the supplement of a 135° angle?

Complementary & Supplementary Angles · 7

Are angles measuring 58° and 122° complementary, supplementary, or neither?

Complementary & Supplementary Angles · 8

Find the value of x.

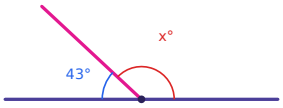

Complementary & Supplementary Angles · 2

ANSWER

126

Complementary & Supplementary Angles · 1

ANSWER

53

Complementary & Supplementary Angles · 4

ANSWER

30

Complementary & Supplementary Angles · 3

ANSWER

44

Complementary & Supplementary Angles · 6

ANSWER

45

Complementary & Supplementary Angles · 5

ANSWER

38

Complementary & Supplementary Angles · 8

ANSWER

137

Complementary & Supplementary Angles · 7

ANSWER

Supplementary

Complementary & Supplementary Angles · 9

Find the value of x.

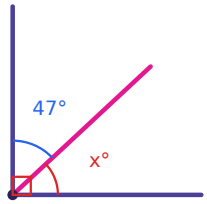

Complementary & Supplementary Angles · 10

Find the value of x.

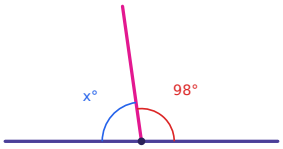

Complementary & Supplementary Angles · 11

The angles are complementary. Find the value of x.

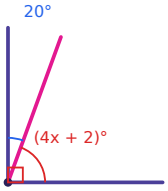

Complementary & Supplementary Angles · 12

The angles are supplementary. Find the value of x.

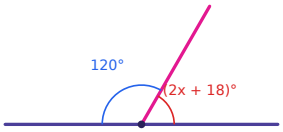

Complementary & Supplementary Angles · 13

What is the measure of the complement of a 36° angle?

Complementary & Supplementary Angles · 14

What is the measure of the supplement of a 116° angle?

Complementary & Supplementary Angles · 15

Are angles measuring 71° and 109° complementary, supplementary, or neither?

Complementary & Supplementary Angles · 16

Find the value of x.

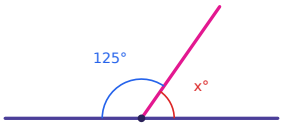

Complementary & Supplementary Angles · 10

ANSWER

82

Complementary & Supplementary Angles · 9

ANSWER

43

Complementary & Supplementary Angles · 12

ANSWER

21

Complementary & Supplementary Angles · 11

ANSWER

17

Complementary & Supplementary Angles · 14

ANSWER

64

Complementary & Supplementary Angles · 13

ANSWER

54

Complementary & Supplementary Angles · 16

ANSWER

55

Complementary & Supplementary Angles · 15

ANSWER

Supplementary

Complementary & Supplementary Angles · 17

Find the value of x.

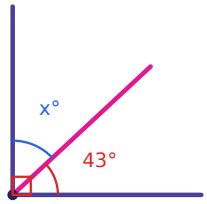

Complementary & Supplementary Angles · 18

Find the value of x.

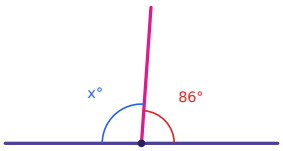

Complementary & Supplementary Angles · 19

The angles are complementary. Find the value of x.

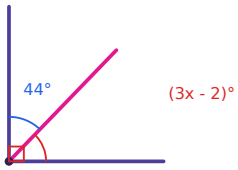

Complementary & Supplementary Angles · 20

The angles are supplementary. Find the value of x.

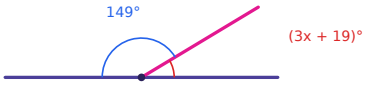

Complementary & Supplementary Angles · 21

What is the measure of the complement of a 17° angle?

Complementary & Supplementary Angles · 22

What is the measure of the supplement of a 51° angle?

Complementary & Supplementary Angles · 23

Are angles measuring 69° and 111° complementary, supplementary, or neither?

Complementary & Supplementary Angles · 24

The angles are complementary. Find the value of x.

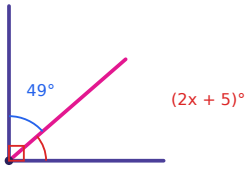

Complementary & Supplementary Angles · 18

ANSWER

94

Complementary & Supplementary Angles · 17

ANSWER

47

Complementary & Supplementary Angles · 20

ANSWER

4

Complementary & Supplementary Angles · 19

ANSWER

16

Complementary & Supplementary Angles · 22

ANSWER

129

Complementary & Supplementary Angles · 21

ANSWER

73

Complementary & Supplementary Angles · 24

ANSWER

18

Complementary & Supplementary Angles · 23

ANSWER

Supplementary