Hour & Minute Hand Angles · 1

Find the smaller angle between the hands at 11:15.



Hour & Minute Hand Angles · 2

Find the smaller angle between the hands at 2:20.



Hour & Minute Hand Angles · 3

Find the smaller angle between the hands at 1:45.



Hour & Minute Hand Angles · 4

Find the smaller angle between the hands at 7:20.



Hour & Minute Hand Angles · 5

How many degrees does the hour hand turn in 70 minutes?

Hour & Minute Hand Angles · 6

Find the smaller angle between the hands at 8:55.



Hour & Minute Hand Angles · 7

How many degrees does the minute hand turn from 10:15 to 10:30?

Hour & Minute Hand Angles · 8

Find the smaller angle between the hands at 10:30.



Hour & Minute Hand Angles · 2

ANSWER

50°

Hour & Minute Hand Angles · 1

ANSWER

112.5°

Hour & Minute Hand Angles · 4

ANSWER

100°

Hour & Minute Hand Angles · 3

ANSWER

142.5°

Hour & Minute Hand Angles · 6

ANSWER

62.5°

Hour & Minute Hand Angles · 5

ANSWER

35°

Hour & Minute Hand Angles · 8

ANSWER

135°

Hour & Minute Hand Angles · 7

ANSWER

90°

Hour & Minute Hand Angles · 9

Find the smaller angle between the hands at 12:50.



Hour & Minute Hand Angles · 10

Find the reflex (larger) angle between the hands at 8:45.



Hour & Minute Hand Angles · 11

Find the smaller angle between the hands at 7:55.



Hour & Minute Hand Angles · 12

How many degrees does the hour hand turn in 40 minutes?

Hour & Minute Hand Angles · 13

Find the smaller angle between the hands at 3:05.



Hour & Minute Hand Angles · 14

Find the reflex (larger) angle between the hands at 12:45.



Hour & Minute Hand Angles · 15

How many degrees does the minute hand turn from 8:10 to 8:40?

Hour & Minute Hand Angles · 16

Find the smaller angle between the hands at 7:50.



Hour & Minute Hand Angles · 10

ANSWER

352.5°

Hour & Minute Hand Angles · 9

ANSWER

85°

Hour & Minute Hand Angles · 12

ANSWER

20°

Hour & Minute Hand Angles · 11

ANSWER

92.5°

Hour & Minute Hand Angles · 14

ANSWER

247.5°

Hour & Minute Hand Angles · 13

ANSWER

62.5°

Hour & Minute Hand Angles · 16

ANSWER

65°

Hour & Minute Hand Angles · 15

ANSWER

180°

Find the smaller angle between the hands at 1:37.



Find the smaller angle between the hands at 12:55.



Find the reflex (larger) angle between the hands at 12:43.



Find the smaller angle between the hands at 10:17.



How many degrees does the hour hand turn in 50 minutes?

Find the reflex (larger) angle between the hands at 11:03.



Find the smaller angle between the hands at 5:18.



How many minutes does it take the minute hand to turn 174°?

Hour & Minute Hand Angles · 18

ANSWER

57.5°

Hour & Minute Hand Angles · 17

ANSWER

173.5°

Hour & Minute Hand Angles · 20

ANSWER

153.5°

Hour & Minute Hand Angles · 19

ANSWER

236.5°

Hour & Minute Hand Angles · 22

ANSWER

313.5°

Hour & Minute Hand Angles · 21

ANSWER

25°

Hour & Minute Hand Angles · 24

ANSWER

29

Hour & Minute Hand Angles · 23

ANSWER

51°