Hour & Minute Hand Angles · 1

Find the smaller angle between the hands at 4:00.



Hour & Minute Hand Angles · 2

Find the smaller angle between the hands at 1:00.



Hour & Minute Hand Angles · 3

Find the smaller angle between the hands at 8:00.



Hour & Minute Hand Angles · 4

Find the smaller angle between the hands at 10:00.



Hour & Minute Hand Angles · 5

Find the smaller angle between the hands at 6:00.



Hour & Minute Hand Angles · 6

Find the smaller angle between the hands at 11:00.



Hour & Minute Hand Angles · 7

Find the smaller angle between the hands at 9:00.



Hour & Minute Hand Angles · 8

Find the smaller angle between the hands at 3:00.



Hour & Minute Hand Angles · 2

ANSWER

30°

Hour & Minute Hand Angles · 1

ANSWER

120°

Hour & Minute Hand Angles · 4

ANSWER

60°

Hour & Minute Hand Angles · 3

ANSWER

120°

Hour & Minute Hand Angles · 6

ANSWER

30°

Hour & Minute Hand Angles · 5

ANSWER

180°

Hour & Minute Hand Angles · 8

ANSWER

90°

Hour & Minute Hand Angles · 7

ANSWER

90°

Hour & Minute Hand Angles · 9

Find the smaller angle between the hands at 7:00.



Hour & Minute Hand Angles · 10

Find the smaller angle between the hands at 4:30.



Hour & Minute Hand Angles · 11

Find the smaller angle between the hands at 8:30.



Hour & Minute Hand Angles · 12

Find the smaller angle between the hands at 7:30.



Hour & Minute Hand Angles · 13

Find the smaller angle between the hands at 5:00.



Hour & Minute Hand Angles · 14

Find the smaller angle between the hands at 11:30.



Hour & Minute Hand Angles · 15

Find the smaller angle between the hands at 5:30.



Hour & Minute Hand Angles · 16

Find the smaller angle between the hands at 7:15.



Hour & Minute Hand Angles · 10

ANSWER

45°

Hour & Minute Hand Angles · 9

ANSWER

150°

Hour & Minute Hand Angles · 12

ANSWER

45°

Hour & Minute Hand Angles · 11

ANSWER

75°

Hour & Minute Hand Angles · 14

ANSWER

165°

Hour & Minute Hand Angles · 13

ANSWER

150°

Hour & Minute Hand Angles · 16

ANSWER

127.5°

Hour & Minute Hand Angles · 15

ANSWER

15°

Hour & Minute Hand Angles · 17

Find the smaller angle between the hands at 11:15.



Hour & Minute Hand Angles · 18

How many degrees does the hour hand turn in 50 minutes?

Hour & Minute Hand Angles · 19

Find the smaller angle between the hands at 4:45.



Hour & Minute Hand Angles · 20

Find the smaller angle between the hands at 3:30.



Hour & Minute Hand Angles · 21

How many degrees does the hour hand turn in 20 minutes?

Hour & Minute Hand Angles · 22

Find the smaller angle between the hands at 2:00.



Hour & Minute Hand Angles · 23

Find the smaller angle between the hands at 9:30.



Hour & Minute Hand Angles · 24

Find the smaller angle between the hands at 10:30.



Hour & Minute Hand Angles · 18

ANSWER

25°

Hour & Minute Hand Angles · 17

ANSWER

112.5°

Hour & Minute Hand Angles · 20

ANSWER

75°

Hour & Minute Hand Angles · 19

ANSWER

127.5°

Hour & Minute Hand Angles · 22

ANSWER

60°

Hour & Minute Hand Angles · 21

ANSWER

10°

Hour & Minute Hand Angles · 24

ANSWER

135°

Hour & Minute Hand Angles · 23

ANSWER

105°