Task card 1 Classifying Angles & Triangles

Classify this angle: 28°

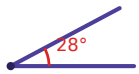

Task card 2 Classifying Angles & Triangles

Classify this triangle by its sides: 7, 7, 5.

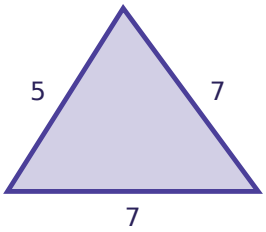

Task card 3 Classifying Angles & Triangles

Classify this triangle by its angles: 77°, 57°, 46°.

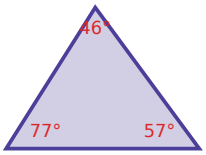

Task card 4 Classifying Angles & Triangles

Classify this angle: 180°

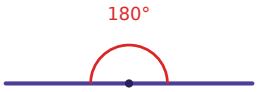

Task card 5 Classifying Angles & Triangles

Classify this triangle by its sides: 5, 5, 5.

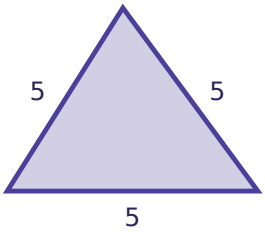

Task card 6 Classifying Angles & Triangles

Classify this triangle by its angles: 118°, 49°, 13°.

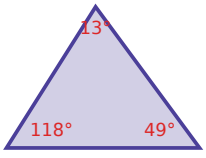

Task card 7 Classifying Angles & Triangles

Classify this angle:

57°

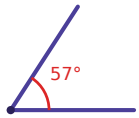

Task card 8 Classifying Angles & Triangles

Classify this triangle by its sides: 8, 8, 11.

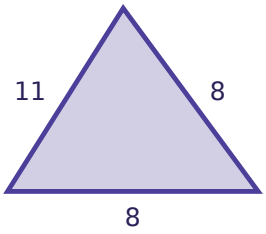

Task card 9 Classifying Angles & Triangles

Classify this triangle by its sides: 6, 6, 1.

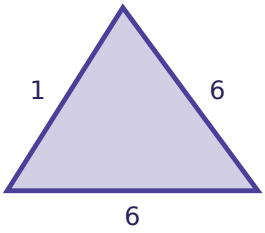

Task card 10 Classifying Angles & Triangles

Classify this triangle by its angles: 40°, 41°, 99°.

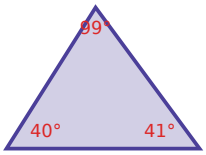

Task card 11 Classifying Angles & Triangles

Classify this angle:

156°



Task card 12 Classifying Angles & Triangles

Classify this triangle by its sides: 15, 15, 7.

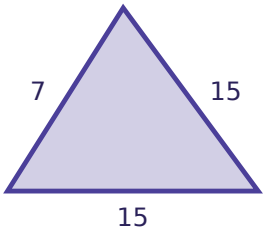

Task card 13 Classifying Angles & Triangles

Classify this triangle by its angles: 123°, 33°, 24°.

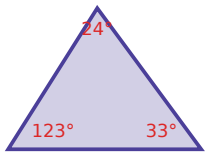

Task card 14 Classifying Angles & Triangles

Classify this angle: 53°

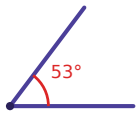

Task card 15 Classifying Angles & Triangles

Classify this triangle by its sides: 12, 12, 12.

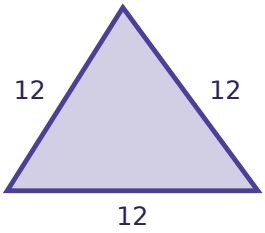

Task card 16 Classifying Angles & Triangles

Classify this angle: 107°

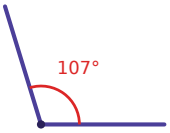

Task card 17 Classifying Angles & Triangles

Classify this triangle by its sides: 3, 3, 3.

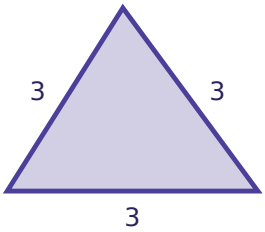

Task card 18 Classifying Angles & Triangles

Classify this triangle by its angles: 140°, 28°, 12°.

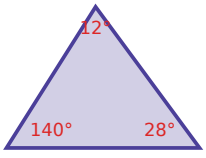

Task card 19 Classifying Angles & Triangles

Classify this triangle by its sides: 17, 17, 17.

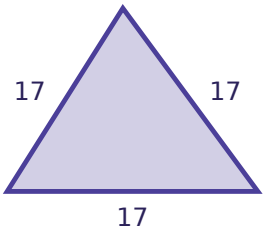

Task card 20 Classifying Angles & Triangles

Classify this triangle by its angles: 111°, 20°, 49°.

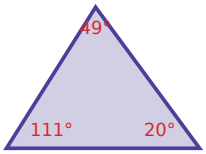

Task card 21 Classifying Angles & Triangles

Classify this angle: 171°



Task card 22 Classifying Angles & Triangles

Classify this triangle by its sides: 16, 16, 16.

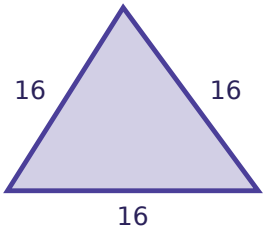

Task card 23 Classifying Angles & Triangles

Classify this triangle by its sides: 7, 4, 9.

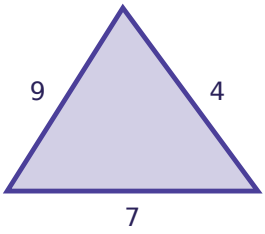

Task card 24 Classifying Angles & Triangles

Classify this triangle by its angles: 50°, 53°, 77°.

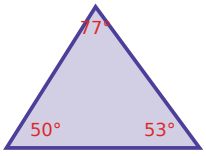

Classifying Angles & Triangles Task Cards

Recording sheet · Grade 7 · Classify each angle or triangle.

Name: _____ Date: _____

Scan to check your answers

1	2	3	4
5	6	7	8
9	10	11	12
13	14	15	16
17	18	19	20
21	22	23	24

Classifying Angles & Triangles Task Cards: Answer Key

Grade 7 · Medium

The answers online

1. Acute	**2.** Isosceles	**3.** Acute
4. Straight	**5.** Equilateral	**6.** Obtuse
7. Acute	**8.** Isosceles	**9.** Isosceles
10. Obtuse	**11.** Obtuse	**12.** Isosceles
13. Obtuse	**14.** Acute	**15.** Equilateral
16. Obtuse	**17.** Equilateral	**18.** Obtuse
19. Equilateral	**20.** Obtuse	**21.** Obtuse
22. Equilateral	**23.** Scalene	**24.** Acute