Task card 1 Classifying Angles & Triangles

Classify this angle:

15°



Task card 2 Classifying Angles & Triangles

Classify this triangle by its sides: 12, 12, 14.

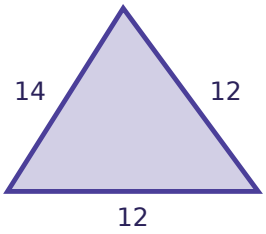

Task card 3 Classifying Angles & Triangles

Classify this triangle by its angles: 133°, 33°, 14°.

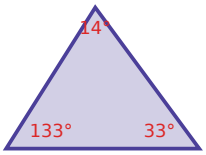

Task card 4 Classifying Angles & Triangles

Classify this angle:

180°



Task card 5 Classifying Angles & Triangles

Classify this triangle by its sides: 12, 12, 12.

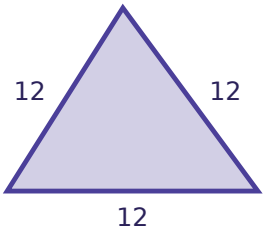

Task card 6 Classifying Angles & Triangles

Classify this triangle by its angles: 132°, 11°, 37°.

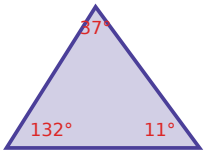

Task card 7 Classifying Angles & Triangles

Classify this angle:

125°

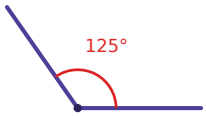

Task card 8 Classifying Angles & Triangles

Classify this triangle by its sides:

18, 19, 8.

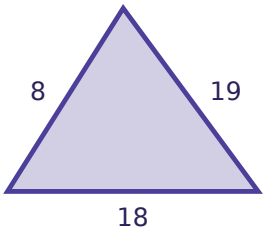

Task card 9 Classifying Angles & Triangles

Classify this triangle by its sides:

17, 17, 2.

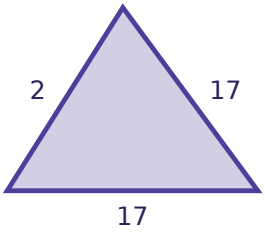

Task card 10 Classifying Angles & Triangles

Classify this triangle by its angles: 121°, 39°, 20°.

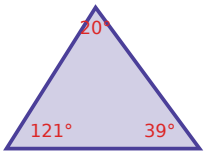

Task card 11 Classifying Angles & Triangles

Classify this angle:

90°

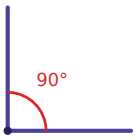

Task card 12 Classifying Angles & Triangles

Classify this triangle by its sides:

6, 6, 5.

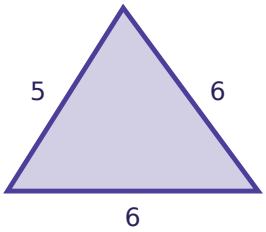

Task card 13 Classifying Angles & Triangles

Classify this triangle by its angles: 95°, 41°, 44°.

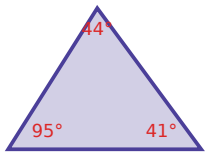

Task card 14 Classifying Angles & Triangles

Classify this angle: 157°

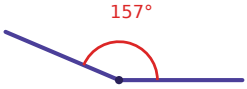

Task card 15 Classifying Angles & Triangles

Classify this triangle by its sides: 8, 15, 17.

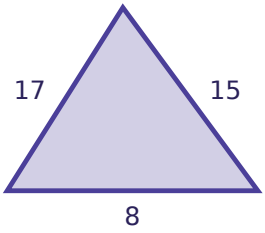

Task card 16 Classifying Angles & Triangles

Classify this angle: 17°



Task card 17 Classifying Angles & Triangles

Classify this triangle by its sides: 2, 2, 3.

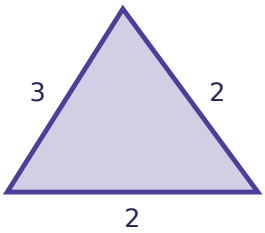

Task card 18 Classifying Angles & Triangles

Classify this triangle by its angles: 25°, 119°, 36°.

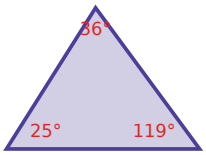

Task card 19 Classifying Angles & Triangles

Classify this triangle by its sides: 9, 9, 9.

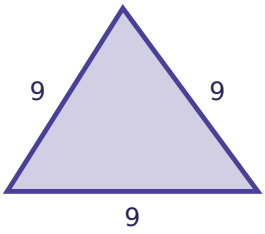

Task card 20 Classifying Angles & Triangles

Classify this triangle by its angles: 20°, 15°, 145°.

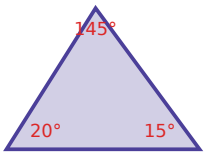

Task card 21 Classifying Angles & Triangles

Classify this angle: 159°

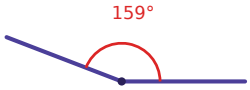

Task card 22 Classifying Angles & Triangles

Classify this triangle by its sides: 16, 16, 19.

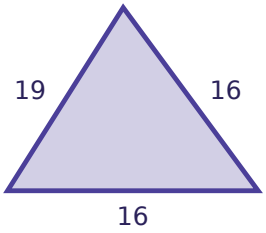

Task card 23 Classifying Angles & Triangles

Classify this angle: 44°

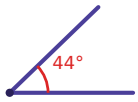

Task card 24 Classifying Angles & Triangles

Classify this triangle by its sides: 20, 20, 10.

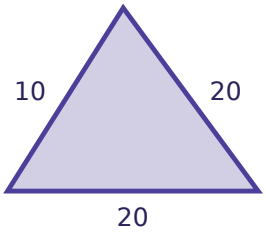

Classifying Angles & Triangles Task Cards

Recording sheet · Grade 7 · Classify each angle or triangle.

Name: _____ Date: _____

Scan to check your answers

1	2	3	4
5	6	7	8
9	10	11	12
13	14	15	16
17	18	19	20
21	22	23	24

Classifying Angles & Triangles Task Cards: Answer Key

Grade 7 · Hard

The answers online

1. Acute	**2.** Isosceles	**3.** Obtuse
4. Straight	**5.** Equilateral	**6.** Obtuse
7. Obtuse	**8.** Scalene	**9.** Isosceles
10. Obtuse	**11.** Right	**12.** Isosceles
13. Obtuse	**14.** Obtuse	**15.** Scalene
16. Acute	**17.** Isosceles	**18.** Obtuse
19. Equilateral	**20.** Obtuse	**21.** Obtuse
22. Isosceles	**23.** Acute	**24.** Isosceles