Task card 1 Classifying Angles & Triangles

Classify this angle: 78°

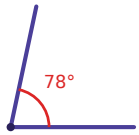

Task card 2 Classifying Angles & Triangles

Classify this triangle by its sides: 7, 7, 4.

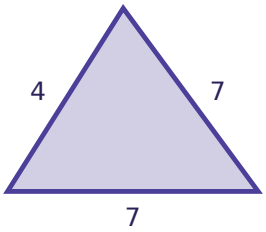

Task card 3 Classifying Angles & Triangles

Classify this triangle by its angles: 26°, 54°, 100°.

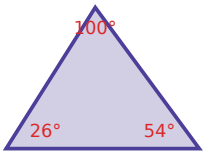

Task card 4 Classifying Angles & Triangles

Classify this angle: 180°



Task card 5 Classifying Angles & Triangles

Classify this triangle by its sides: 4, 4, 2.

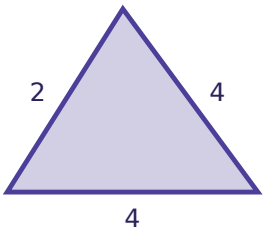

Task card 6 Classifying Angles & Triangles

Classify this triangle by its angles: 13°, 80°, 87°.

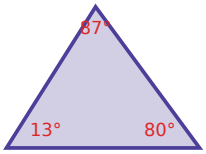

Task card 7 Classifying Angles & Triangles

Classify this angle:

90°

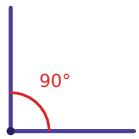

Task card 8 Classifying Angles & Triangles

Classify this triangle by its sides: 5, 2, 6.

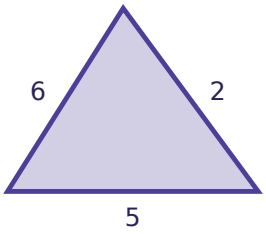

Task card 9 Classifying Angles & Triangles

Classify this triangle by its sides: 9, 9, 9.

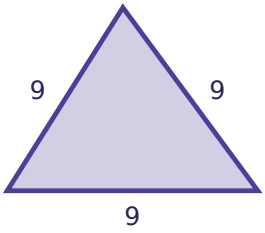

Task card 10 Classifying Angles & Triangles

Classify this triangle by its angles: 18°, 96°, 66°.

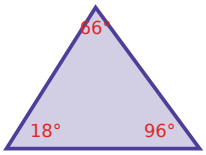

Task card 11 Classifying Angles & Triangles

Classify this angle:

33°

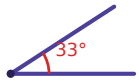

Task card 12 Classifying Angles & Triangles

Classify this triangle by its sides: 6, 2, 7.

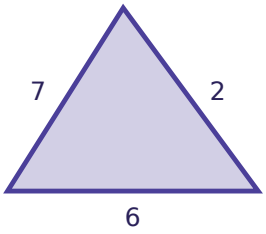

Task card 13 Classifying Angles & Triangles

Classify this triangle by its angles: 146°, 21°, 13°.

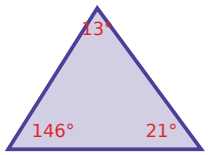

Task card 14 Classifying Angles & Triangles

Classify this angle: 71°

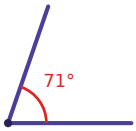

Task card 15 Classifying Angles & Triangles

Classify this triangle by its sides: 7, 7, 9.

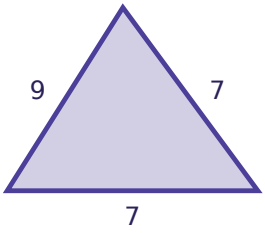

Task card 16 Classifying Angles & Triangles

Classify this triangle by its sides: 8, 8, 7.

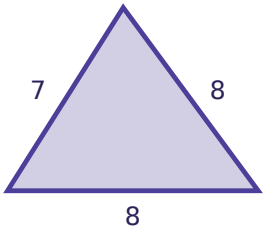

Task card 17 Classifying Angles & Triangles

Classify this triangle by its angles: 67°, 28°, 85°.

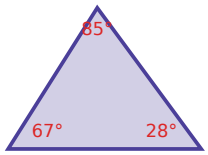

Task card 18 Classifying Angles & Triangles

Classify this angle: 157°

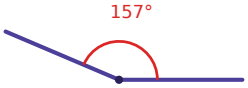

Task card 19 Classifying Angles & Triangles

Classify this triangle by its sides: 2, 2, 2.

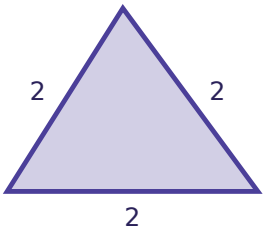

Task card 20 Classifying Angles & Triangles

Classify this triangle by its angles: 148°, 15°, 17°.

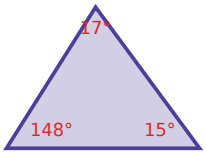

Task card 21 Classifying Angles & Triangles

Classify this angle: 151°

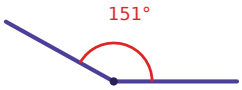

Task card 22 Classifying Angles & Triangles

Classify this triangle by its sides: 2, 2, 3.

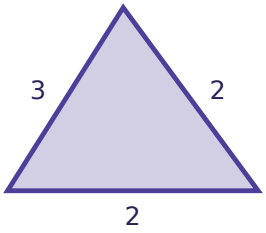

Task card 23 Classifying Angles & Triangles

Classify this angle: 144°



Task card 24 Classifying Angles & Triangles

Classify this triangle by its angles: 84°, 17°, 79°.

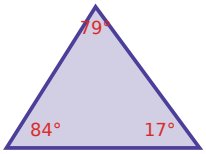

Classifying Angles & Triangles Task Cards

Recording sheet · Grade 7 · Classify each angle or triangle.

Name: _____ Date: _____

Scan to check your answers

1	2	3	4
5	6	7	8
9	10	11	12
13	14	15	16
17	18	19	20
21	22	23	24

Classifying Angles & Triangles Task Cards: Answer Key

Grade 7 · Easy

The answers online

1. Acute	**2.** Isosceles	**3.** Obtuse
4. Straight	**5.** Isosceles	**6.** Acute
7. Right	**8.** Scalene	**9.** Equilateral
10. Obtuse	**11.** Acute	**12.** Scalene
13. Obtuse	**14.** Acute	**15.** Isosceles
16. Isosceles	**17.** Acute	**18.** Obtuse
19. Equilateral	**20.** Obtuse	**21.** Obtuse
22. Isosceles	**23.** Obtuse	**24.** Acute