Classifying Angles & Triangles · 1

Classify this angle: 15°



Classifying Angles & Triangles · 2

Classify this triangle by its sides: 12, 12, 14.

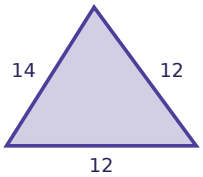

Classifying Angles & Triangles · 3

Classify this triangle by its angles: 133°, 33°, 14°.

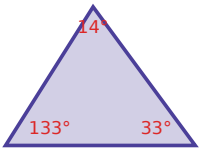

Classifying Angles & Triangles · 4

Classify this angle: 180°



Classifying Angles & Triangles · 5

Classify this triangle by its sides: 12, 12, 12.

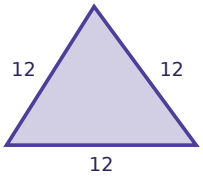

Classifying Angles & Triangles · 6

Classify this triangle by its angles: 132°, 11°, 37°.

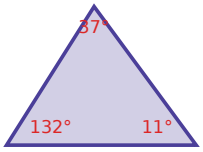

Classifying Angles & Triangles · 7

Classify this angle: 125°

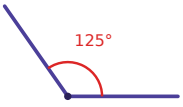

Classifying Angles & Triangles · 8

Classify this triangle by its sides: 18, 19, 8.

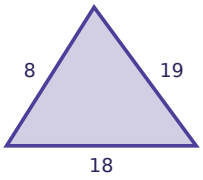

Classifying Angles & Triangles · 2

ANSWER

Isosceles

Classifying Angles & Triangles · 1

ANSWER

Acute

Classifying Angles & Triangles · 4

ANSWER

Straight

Classifying Angles & Triangles · 3

ANSWER

Obtuse

Classifying Angles & Triangles · 6

ANSWER

Obtuse

Classifying Angles & Triangles · 5

ANSWER

Equilateral

Classifying Angles & Triangles · 8

ANSWER

Scalene

Classifying Angles & Triangles · 7

ANSWER

Obtuse

Classifying Angles & Triangles · 9

Classify this triangle by its sides: 17, 17, 2.

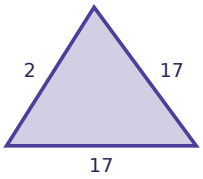

Classifying Angles & Triangles · 10

Classify this triangle by its angles: 121°, 39°, 20°.

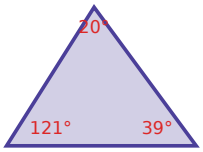

Classifying Angles & Triangles · 11

Classify this angle: 90°

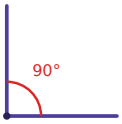

Classifying Angles & Triangles · 12

Classify this triangle by its sides: 6, 6, 5.

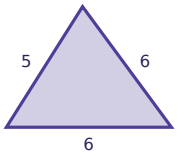

Classifying Angles & Triangles · 13

Classify this triangle by its angles: 95°, 41°, 44°.

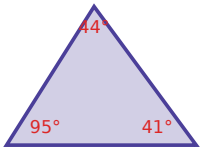

Classifying Angles & Triangles · 14

Classify this angle: 157°

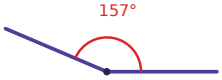

Classifying Angles & Triangles · 15

Classify this triangle by its sides: 8, 15, 17.

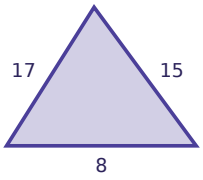

Classifying Angles & Triangles · 16

Classify this angle: 17°

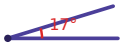

Classifying Angles & Triangles · 10

ANSWER

Obtuse

Classifying Angles & Triangles · 9

ANSWER

Isosceles

Classifying Angles & Triangles · 12

ANSWER

Isosceles

Classifying Angles & Triangles · 11

ANSWER

Right

Classifying Angles & Triangles · 14

ANSWER

Obtuse

Classifying Angles & Triangles · 13

ANSWER

Obtuse

Classifying Angles & Triangles · 16

ANSWER

Acute

Classifying Angles & Triangles · 15

ANSWER

Scalene

Classify this triangle by its sides: 2, 2, 3.

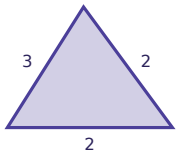

Classify this triangle by its angles: 25°, 119°, 36°.

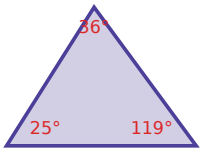

Classify this triangle by its sides: 9, 9, 9.

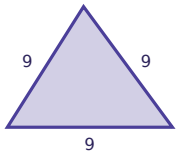

Classify this triangle by its angles: 20°, 15°, 145°.

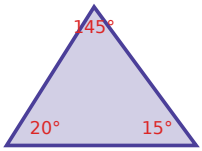

Classify this angle: 159°

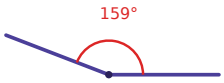

Classify this triangle by its sides: 16, 16, 19.

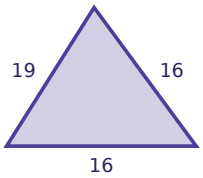

Classify this angle: 44°

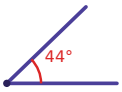

Classify this triangle by its sides: 20, 20, 10.

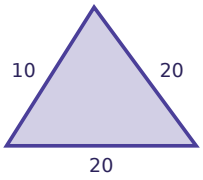

Classifying Angles & Triangles · 18

ANSWER

Obtuse

Classifying Angles & Triangles · 17

ANSWER

Isosceles

Classifying Angles & Triangles · 20

ANSWER

Obtuse

Classifying Angles & Triangles · 19

ANSWER

Equilateral

Classifying Angles & Triangles · 22

ANSWER

Isosceles

Classifying Angles & Triangles · 21

ANSWER

Obtuse

Classifying Angles & Triangles · 24

ANSWER

Isosceles

Classifying Angles & Triangles · 23

ANSWER

Acute