Circles: Diameter Given – Find Area & Circumference · 1

A circle has diameter 11. Find the circumference.

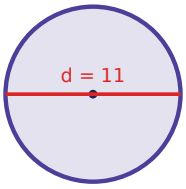


Circles: Diameter Given – Find Area & Circumference · 2

A circle has diameter 16. Find the area.

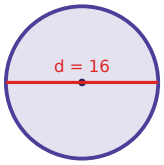


Circles: Diameter Given – Find Area & Circumference · 3

A circle has diameter 15. Find the radius.

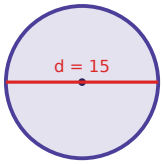


Circles: Diameter Given – Find Area & Circumference · 4

A circle has diameter 9. Find the circumference.

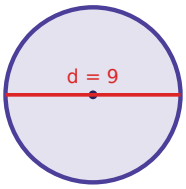


Circles: Diameter Given – Find Area & Circumference · 5

A circle has diameter 6. Find the area.

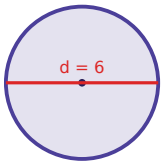


Circles: Diameter Given – Find Area & Circumference · 6

A circle has diameter 7. Find the radius.

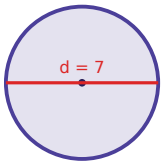


Circles: Diameter Given – Find Area & Circumference · 7

A circle has diameter 19. Find the circumference.

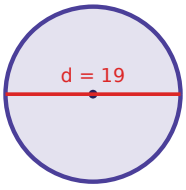


Circles: Diameter Given – Find Area & Circumference · 8

A circle has diameter 14. Find the area.

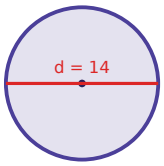

Circles: Diameter Given – Find Area & Circumference · 2

**ANSWER**

**201**

Circles: Diameter Given – Find Area & Circumference · 1

**ANSWER**

**34.5**

Circles: Diameter Given – Find Area & Circumference · 4

**ANSWER**

**28.3**

Circles: Diameter Given – Find Area & Circumference · 3

**ANSWER**

**7.5**

Circles: Diameter Given – Find Area & Circumference · 6

**ANSWER**

**3.5**

Circles: Diameter Given – Find Area & Circumference · 5

**ANSWER**

**28.3**

Circles: Diameter Given – Find Area & Circumference · 8

**ANSWER**

**153.9**

Circles: Diameter Given – Find Area & Circumference · 7

**ANSWER**

**59.7**

A circle has diameter 7. Find the circumference.

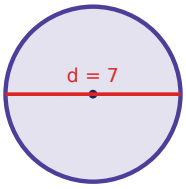




A circle has diameter 19. Find the area.

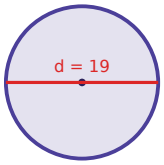




A circle has diameter 28. Find the radius.

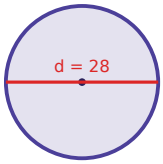




A circle has diameter 17. Find both the circumference and the area.

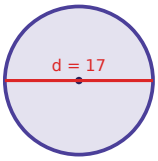




A circle has diameter 14. Find the circumference.

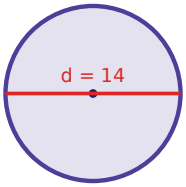




A circle has diameter 9. Find the area.

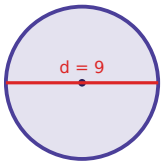




A circle has diameter 16. Find the radius.

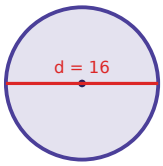




A circle has diameter 23. Find both the circumference and the area.

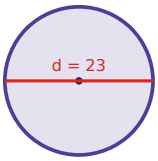

Circles: Diameter Given – Find Area & Circumference · 10

**ANSWER**

**283.4**

Circles: Diameter Given – Find Area & Circumference · 9

**ANSWER**

**22**

Circles: Diameter Given – Find Area & Circumference · 12

**ANSWER**

**C = 53.4, A = 226.9**

Circles: Diameter Given – Find Area & Circumference · 11

**ANSWER**

**14**

Circles: Diameter Given – Find Area & Circumference · 14

**ANSWER**

**63.6**

Circles: Diameter Given – Find Area & Circumference · 13

**ANSWER**

**44**

Circles: Diameter Given – Find Area & Circumference · 16

**ANSWER**

**C = 72.2, A = 415.3**

Circles: Diameter Given – Find Area & Circumference · 15

**ANSWER**

**8**

A circle has diameter 8. Find the circumference.

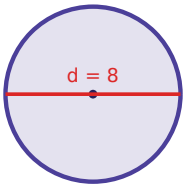




A circle has diameter 18. Find the radius.

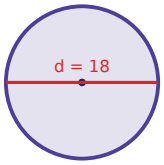




A circle has diameter 9. Find both the circumference and the area.

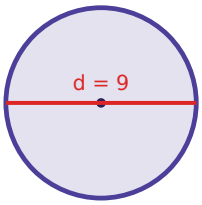




A circle has diameter 13. Find the circumference.

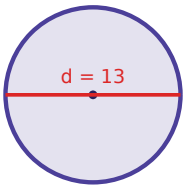




A circle has diameter 7. Find the area.

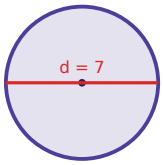




A circle has diameter 5. Find the radius.

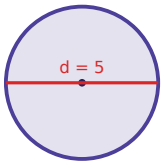




A circle has diameter 21. Find both the circumference and the area.

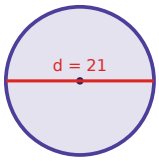




A circle has diameter 13. Find the area.

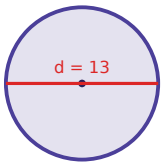

Circles: Diameter Given – Find Area & Circumference · 18

**ANSWER**

**9**

Circles: Diameter Given – Find Area & Circumference · 17

**ANSWER**

**25.1**

Circles: Diameter Given – Find Area & Circumference · 20

**ANSWER**

**40.8**

Circles: Diameter Given – Find Area & Circumference · 19

**ANSWER**

**C = 28.3, A = 63.6**

Circles: Diameter Given – Find Area & Circumference · 22

**ANSWER**

**2.5**

Circles: Diameter Given – Find Area & Circumference · 21

**ANSWER**

**38.5**

Circles: Diameter Given – Find Area & Circumference · 24

**ANSWER**

**132.7**

Circles: Diameter Given – Find Area & Circumference · 23

**ANSWER**

**C = 65.9, A = 346.2**