Task card 1 Circles: Circumference Given – Fin...

A circle has circumference 37.7.

Find the diameter.

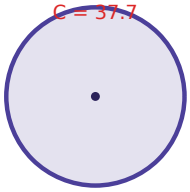

Task card 2 Circles: Circumference Given – Fin...

A circle has circumference 87.9.

Find the radius.

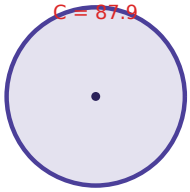

Task card 3 Circles: Circumference Given – Fin...

A circle has circumference 50.2.

Find the diameter.

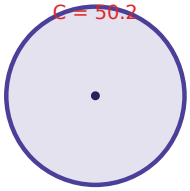

Task card 4 Circles: Circumference Given – Fin...

A circle has circumference 31.4.

Find the radius.

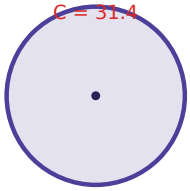

Task card 5 Circles: Circumference Given – Fin...

A circle has circumference 56.5.

Find the diameter.

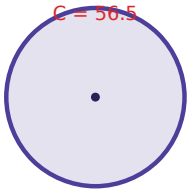

Task card 6 Circles: Circumference Given – Fin...

A circle has circumference 62.8.

Find the radius.

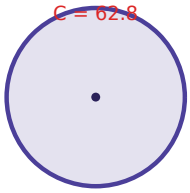

Task card 7 Circles: Circumference Given – Fin...

A circle has circumference 75.4. Find the diameter.

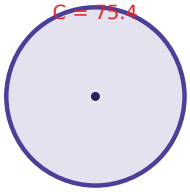

Task card 8 Circles: Circumference Given – Fin...

A circle has circumference 94.2. Find the radius.

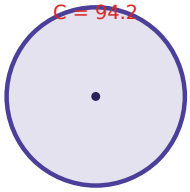

Task card 9 Circles: Circumference Given – Fin...

A circle has circumference 125.6. Find the diameter.

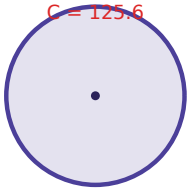

Task card 10 Circles: Circumference Given – Fin...

A circle has circumference 100.5. Find the radius.

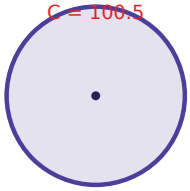

Task card 11 Circles: Circumference Given – Fin...

A circle has circumference 81.6. Find the area.

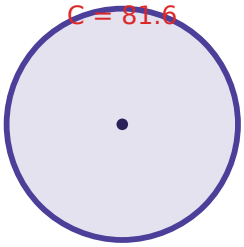

Task card 12 Circles: Circumference Given – Fin...

A circle has circumference 106.8. Find the radius.

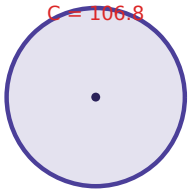

Task card 13 Circles: Circumference Given – Fin...

A circle has circumference 44.0. Find the area.

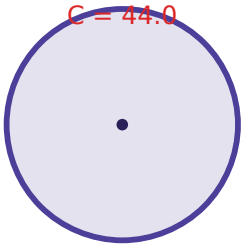

Task card 14 Circles: Circumference Given – Fin...

A circle has circumference 94.2. Find the diameter.

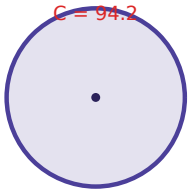

Task card 15 Circles: Circumference Given – Fin...

A circle has circumference 75.4. Find the radius.

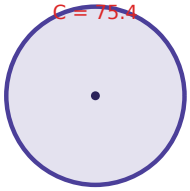

Task card 16 Circles: Circumference Given – Fin...

A circle has circumference 25.1. Find the area.

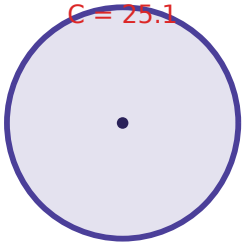

Task card 17 Circles: Circumference Given – Fin...

A circle has circumference 106.8. Find the diameter.

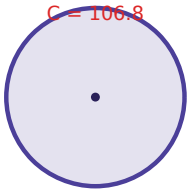

Task card 18 Circles: Circumference Given – Fin...

A circle has circumference 119.3. Find the diameter.

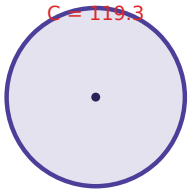

Task card 19 Circles: Circumference Given – Fin...

A circle has circumference 62.8.

Find the diameter.

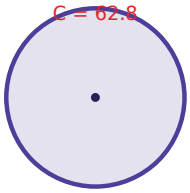

Task card 20 Circles: Circumference Given – Fin...

A circle has circumference 37.7.

Find the radius.

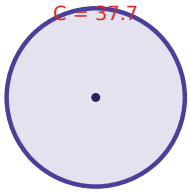

Task card 21 Circles: Circumference Given – Fin...

A circle has circumference 18.8.

Find the diameter.

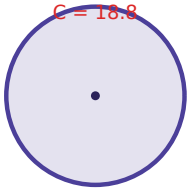

Task card 22 Circles: Circumference Given – Fin...

A circle has circumference 50.2.

Find the radius.

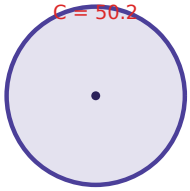

Task card 23 Circles: Circumference Given – Fin...

A circle has circumference 69.1.

Find the diameter.

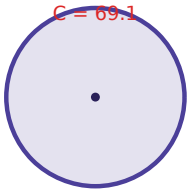

Task card 24 Circles: Circumference Given – Fin...

A circle has circumference 81.6.

Find the radius.

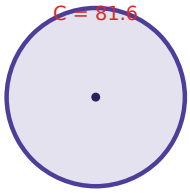

Circles: Circumference Given – Find Area Task Cards

Recording sheet · Grade 7 · Use π ≈ 3.14. Round your answer to one decimal place when needed.

Scan to check your answers

Name: _____ Date: _____

1	2	3	4
5	6	7	8
9	10	11	12
13	14	15	16
17	18	19	20
21	22	23	24

Circles: Circumference Given – Find Area Task Cards: Answer Key

Grade 7 · Medium

The answers online

1. 12	**2.** 14	**3.** 16
4. 5	**5.** 18	**6.** 10
7. 24	**8.** 15	**9.** 40
10. 16	**11.** 530.7	**12.** 17
13. 153.9	**14.** 30	**15.** 12
16. 50.2	**17.** 34	**18.** 38
19. 20	**20.** 6	**21.** 6
22. 8	**23.** 22	**24.** 13