Task card 1 Circles: Circumference Given – Fin...

A circle has circumference 37.7.

Find the diameter.

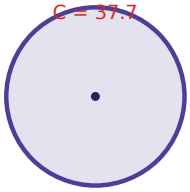

Task card 2 Circles: Circumference Given – Fin...

A circle has circumference 18.8.

Find the diameter.

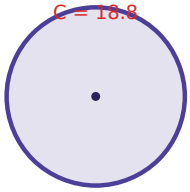

Task card 3 Circles: Circumference Given – Fin...

A circle has circumference 62.8.

Find the diameter.

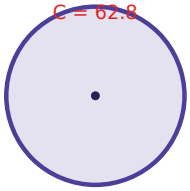

Task card 4 Circles: Circumference Given – Fin...

A circle has circumference 25.1.

Find the diameter.

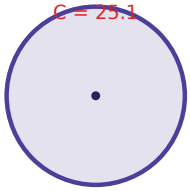

Task card 5 Circles: Circumference Given – Fin...

A circle has circumference 31.4.

Find the diameter.

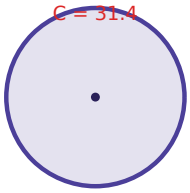

Task card 6 Circles: Circumference Given – Fin...

A circle has circumference 12.6.

Find the diameter.

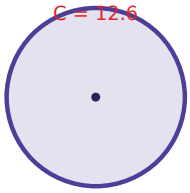

Task card 7 Circles: Circumference Given – Fin...

A circle has circumference 56.5.

Find the diameter.

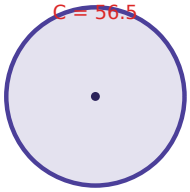

Task card 8 Circles: Circumference Given – Fin...

A circle has circumference 44.0.

Find the diameter.

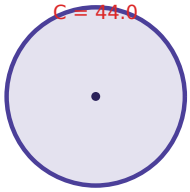

Task card 9 Circles: Circumference Given – Fin...

A circle has circumference 50.2.

Find the diameter.

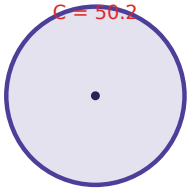

Task card 10 Circles: Circumference Given – Fin...

A circle has circumference 75.4.

Find the diameter.

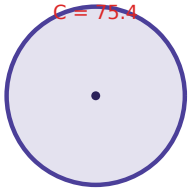

Task card 11 Circles: Circumference Given – Fin...

A circle has circumference 25.1.

Find the radius.

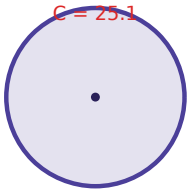

Task card 12 Circles: Circumference Given – Fin...

A circle has circumference 62.8.

Find the radius.

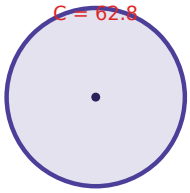

Task card 13 Circles: Circumference Given – Fin...

A circle has circumference 94.2.

Find the radius.

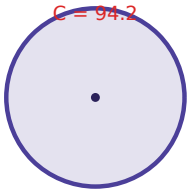

Task card 14 Circles: Circumference Given – Fin...

A circle has circumference 69.1.

Find the diameter.

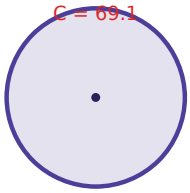

Task card 15 Circles: Circumference Given – Fin...

A circle has circumference 87.9.

Find the radius.

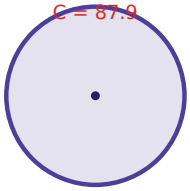

Task card 16 Circles: Circumference Given – Fin...

A circle has circumference 44.0.

Find the radius.

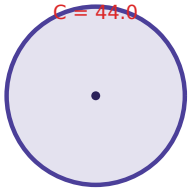

Task card 17 Circles: Circumference Given – Fin...

A circle has circumference 31.4.

Find the radius.

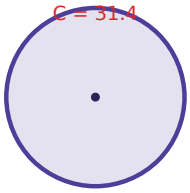

Task card 18 Circles: Circumference Given – Fin...

A circle has circumference 87.9.

Find the diameter.

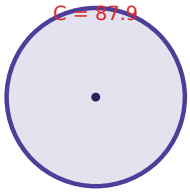

Task card 19 Circles: Circumference Given – Fin...

A circle has circumference 37.7.

Find the radius.

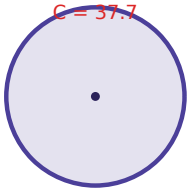

Task card 20 Circles: Circumference Given – Fin...

A circle has circumference 94.2.

Find the diameter.

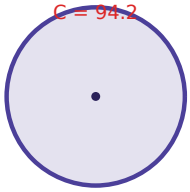

Task card 21 Circles: Circumference Given – Fin...

A circle has circumference 81.6.

Find the diameter.

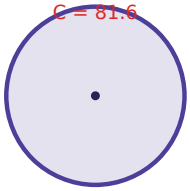

Task card 22 Circles: Circumference Given – Fin...

A circle has circumference 69.1.

Find the radius.

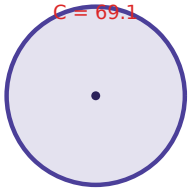

Task card 23 Circles: Circumference Given – Fin...

A circle has circumference 18.8.

Find the radius.

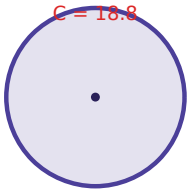

Circles: Circumference Given – Find Area Task Cards

Recording sheet · Grade 7 · Use π ≈ 3.14. Round your answer to one decimal place when needed.

Scan to check your answers

Name: _____ Date: _____

1	2	3	4
5	6	7	8
9	10	11	12
13	14	15	16
17	18	19	20
21	22	23	

Circles: Circumference Given – Find Area Task Cards: Answer Key

Grade 7 · Easy

The answers online

1. 12	**2.** 6	**3.** 20
4. 8	**5.** 10	**6.** 4
7. 18	**8.** 14	**9.** 16
10. 24	**11.** 4	**12.** 10
13. 15	**14.** 22	**15.** 14
16. 7	**17.** 5	**18.** 28
19. 6	**20.** 30	**21.** 26
22. 11	**23.** 3	