Circles: Circumference Given – Find Area · 1

A circle has circumference 37.7. Find the diameter.

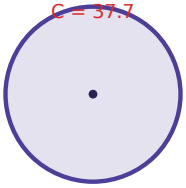

Circles: Circumference Given – Find Area · 2

A circle has circumference 87.9. Find the radius.

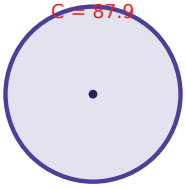

Circles: Circumference Given – Find Area · 3

A circle has circumference 50.2. Find the diameter.

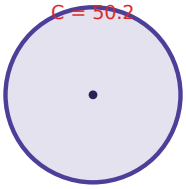

Circles: Circumference Given – Find Area · 4

A circle has circumference 31.4. Find the radius.

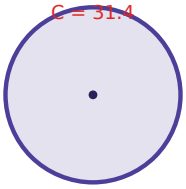

Circles: Circumference Given – Find Area · 5

A circle has circumference 56.5. Find the diameter.

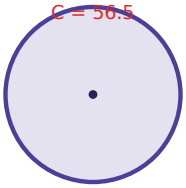

Circles: Circumference Given – Find Area · 6

A circle has circumference 62.8. Find the radius.

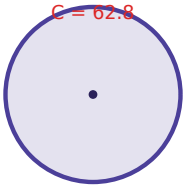

Circles: Circumference Given – Find Area · 7

A circle has circumference 75.4. Find the diameter.

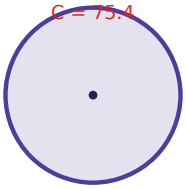

Circles: Circumference Given – Find Area · 8

A circle has circumference 94.2. Find the radius.

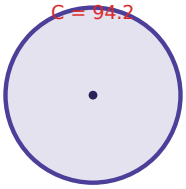

Circles: Circumference Given – Find Area · 2

ANSWER

14

Circles: Circumference Given – Find Area · 1

ANSWER

12

Circles: Circumference Given – Find Area · 4

ANSWER

5

Circles: Circumference Given – Find Area · 3

ANSWER

16

Circles: Circumference Given – Find Area · 6

ANSWER

10

Circles: Circumference Given – Find Area · 5

ANSWER

18

Circles: Circumference Given – Find Area · 8

ANSWER

15

Circles: Circumference Given – Find Area · 7

ANSWER

24

Circles: Circumference Given – Find Area · 9

A circle has circumference 125.6. Find the diameter.

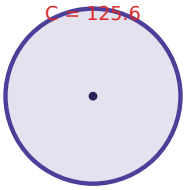

Circles: Circumference Given – Find Area · 10

A circle has circumference 100.5. Find the radius.

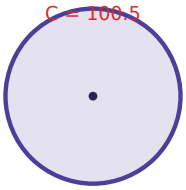

Circles: Circumference Given – Find Area · 11

A circle has circumference 81.6. Find the area.

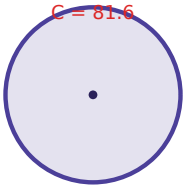

Circles: Circumference Given – Find Area · 12

A circle has circumference 106.8. Find the radius.

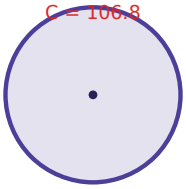

Circles: Circumference Given – Find Area · 13

A circle has circumference 44.0. Find the area.

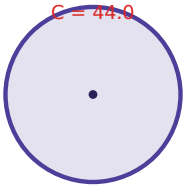

Circles: Circumference Given – Find Area · 14

A circle has circumference 94.2. Find the diameter.

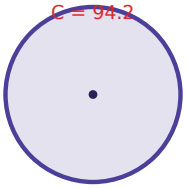

Circles: Circumference Given – Find Area · 15

A circle has circumference 75.4. Find the radius.

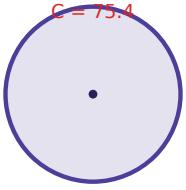

Circles: Circumference Given – Find Area · 16

A circle has circumference 25.1. Find the area.

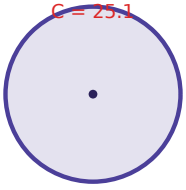

Circles: Circumference Given – Find Area · 10

ANSWER

16

Circles: Circumference Given – Find Area · 9

ANSWER

40

Circles: Circumference Given – Find Area · 12

ANSWER

17

Circles: Circumference Given – Find Area · 11

ANSWER

530.7

Circles: Circumference Given – Find Area · 14

ANSWER

30

Circles: Circumference Given – Find Area · 13

ANSWER

153.9

Circles: Circumference Given – Find Area · 16

ANSWER

50.2

Circles: Circumference Given – Find Area · 15

ANSWER

12

Circles: Circumference Given – Find Area · 17

A circle has circumference 106.8. Find the diameter.

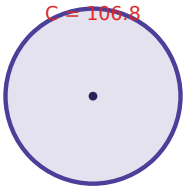

Circles: Circumference Given – Find Area · 18

A circle has circumference 119.3. Find the diameter.

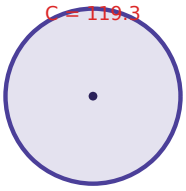

Circles: Circumference Given – Find Area · 19

A circle has circumference 62.8. Find the diameter.

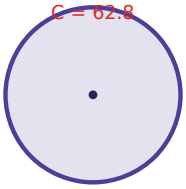

Circles: Circumference Given – Find Area · 20

A circle has circumference 37.7. Find the radius.

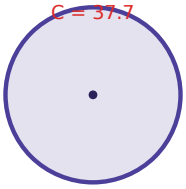

Circles: Circumference Given – Find Area · 21

A circle has circumference 18.8. Find the diameter.

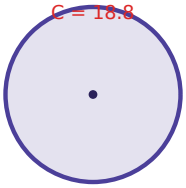

Circles: Circumference Given – Find Area · 22

A circle has circumference 50.2. Find the radius.

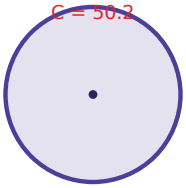

Circles: Circumference Given – Find Area · 23

A circle has circumference 69.1. Find the diameter.

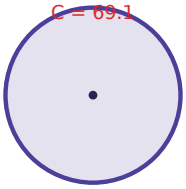

Circles: Circumference Given – Find Area · 24

A circle has circumference 81.6. Find the radius.

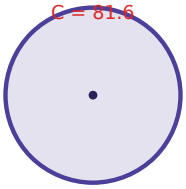

Circles: Circumference Given – Find Area · 18

ANSWER

38

Circles: Circumference Given – Find Area · 17

ANSWER

34

Circles: Circumference Given – Find Area · 20

ANSWER

6

Circles: Circumference Given – Find Area · 19

ANSWER

20

Circles: Circumference Given – Find Area · 22

ANSWER

8

Circles: Circumference Given – Find Area · 21

ANSWER

6

Circles: Circumference Given – Find Area · 24

ANSWER

13

Circles: Circumference Given – Find Area · 23

ANSWER

22