Task card 1 Circles: Area & Circumference

Find the circumference of a circle with radius 3. Use π ≈ 3.14.

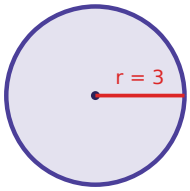

Task card 2 Circles: Area & Circumference

Find the area of a circle with radius 2. Use π ≈ 3.14.

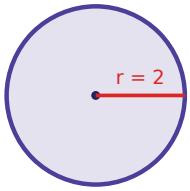

Task card 3 Circles: Area & Circumference

Find the circumference of a circle with radius 5. Use π ≈ 3.14.

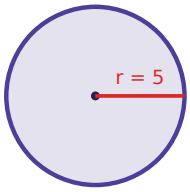

Task card 4 Circles: Area & Circumference

Find the area of a circle with radius 3. Use π ≈ 3.14.

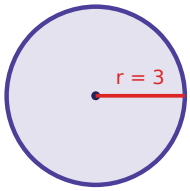

Task card 5 Circles: Area & Circumference

Find the circumference of a circle with radius 2. Use π ≈ 3.14.

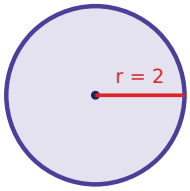

Task card 6 Circles: Area & Circumference

Find the area of a circle with radius 4. Use π ≈ 3.14.

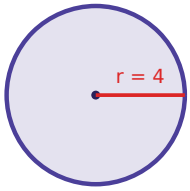

Task card 7 Circles: Area & Circumference

Find the circumference of a circle with radius 4. Use π ≈ 3.14.

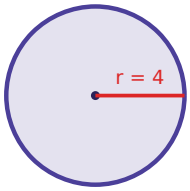

Task card 8 Circles: Area & Circumference

Find the area of a circle with radius 5. Use π ≈ 3.14.

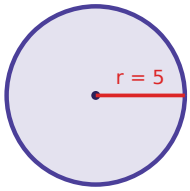

Task card 9 Circles: Area & Circumference

Find the area of a circle with radius 6. Use π ≈ 3.14.

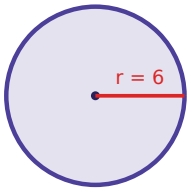

Task card 10 Circles: Area & Circumference

Find the circumference of a circle with radius 7. Use π ≈ 3.14.

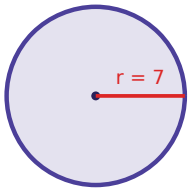

Task card 11 Circles: Area & Circumference

Find the circumference of a circle with radius 6. Use π ≈ 3.14.

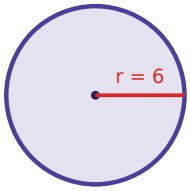

Task card 12 Circles: Area & Circumference

Find the area of a circle with radius 7. Use π ≈ 3.14.

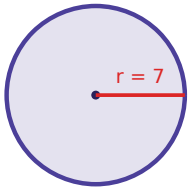

Circles: Area & Circumference Task Cards

Recording sheet · Grade 7 · Use π ≈ 3.14. Round to one decimal place if needed.

Name: _____ Date: _____

Scan to check your answers

1	2	3	4
5	6	7	8
9	10	11	12

Circles: Area & Circumference Task Cards: Answer Key

Grade 7 · Easy

The answers online

1. 18.8	**2.** 12.6	**3.** 31.4
4. 28.3	**5.** 12.6	**6.** 50.2
7. 25.1	**8.** 78.5	**9.** 113.0
10. 44.0	**11.** 37.7	**12.** 153.9