Circles: Area & Circumference · 1

Find the circumference of a circle with radius 6. Use π ≈ 3.14.

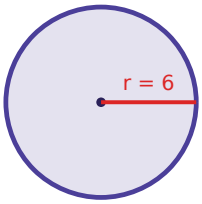

Circles: Area & Circumference · 2

Find the area of a circle with radius 7. Use π ≈ 3.14.

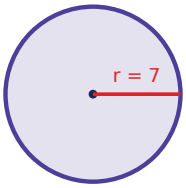

Circles: Area & Circumference · 3

Find the circumference of a circle with radius 7. Use π ≈ 3.14.

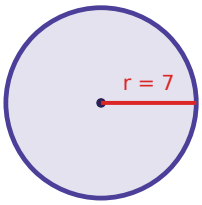

Circles: Area & Circumference · 4

Find the area of a circle with radius 2. Use π ≈ 3.14.

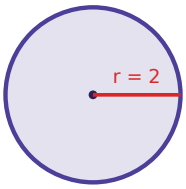

Circles: Area & Circumference · 5

Find the circumference of a circle with radius 4. Use π ≈ 3.14.

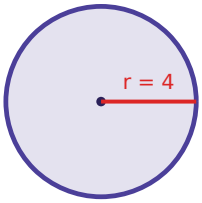

Circles: Area & Circumference · 6

Find the area of a circle with radius 6. Use π ≈ 3.14.

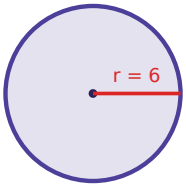

Circles: Area & Circumference · 7

Find the circumference of a circle with radius 2. Use π ≈ 3.14.

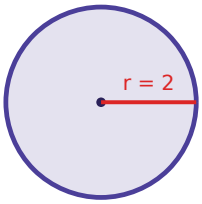

Circles: Area & Circumference · 8

Find the area of a circle with radius 8. Use π ≈ 3.14.

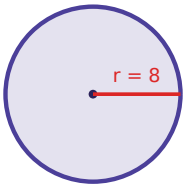

Circles: Area & Circumference · 2

ANSWER

153.9

Circles: Area & Circumference · 1

ANSWER

37.7

Circles: Area & Circumference · 4

ANSWER

12.6

Circles: Area & Circumference · 3

ANSWER

44.0

Circles: Area & Circumference · 6

ANSWER

113.0

Circles: Area & Circumference · 5

ANSWER

25.1

Circles: Area & Circumference · 8

ANSWER

201.0

Circles: Area & Circumference · 7

ANSWER

12.6

Circles: Area & Circumference · 9

Find the area of a circle with radius 3. Use π ≈ 3.14.

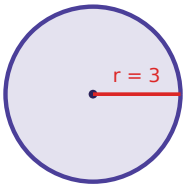

Circles: Area & Circumference · 10

Find the circumference of a circle with radius 5. Use π ≈ 3.14.

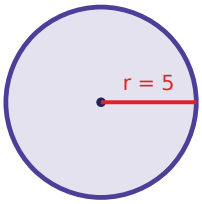

Circles: Area & Circumference · 11

Find the area of a circle with radius 5. Use π ≈ 3.14.

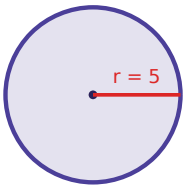

Circles: Area & Circumference · 12

Find the area of a circle with radius 4. Use π ≈ 3.14.

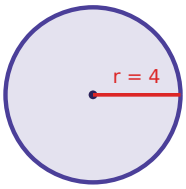

Circles: Area & Circumference · 13

Find the area of a circle with radius 10. Use π ≈ 3.14.

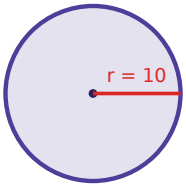

Circles: Area & Circumference · 14

Find the circumference of a circle with radius 10. Use π ≈ 3.14.

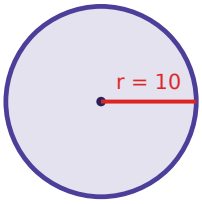

Circles: Area & Circumference · 15

Find the circumference of a circle with radius 3. Use π ≈ 3.14.

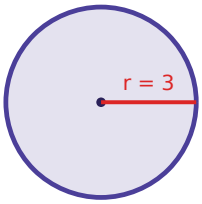

Circles: Area & Circumference · 16

Find the circumference of a circle with radius 8. Use π ≈ 3.14.

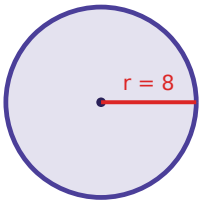

Circles: Area & Circumference · 10

ANSWER

31.4

Circles: Area & Circumference · 9

ANSWER

28.3

Circles: Area & Circumference · 12

ANSWER

50.2

Circles: Area & Circumference · 11

ANSWER

78.5

Circles: Area & Circumference · 14

ANSWER

62.8

Circles: Area & Circumference · 13

ANSWER

314.0

Circles: Area & Circumference · 16

ANSWER

50.2

Circles: Area & Circumference · 15

ANSWER

18.8

Find the area of a circle with radius 9. Use π ≈ 3.14.

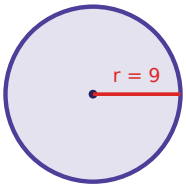

Circles: Area & Circumference · 17

ANSWER

254.3