Circles: Area & Circumference · 1

Find the circumference of a circle with radius 3. Use π ≈ 3.14.

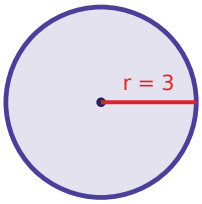


Circles: Area & Circumference · 2

Find the area of a circle with radius 2. Use π ≈ 3.14.

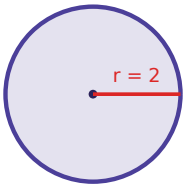


Circles: Area & Circumference · 3

Find the circumference of a circle with radius 5. Use π ≈ 3.14.

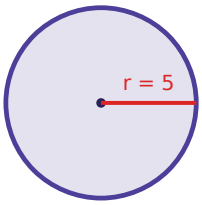


Circles: Area & Circumference · 4

Find the area of a circle with radius 3. Use π ≈ 3.14.

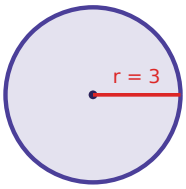


Circles: Area & Circumference · 5

Find the circumference of a circle with radius 2. Use π ≈ 3.14.

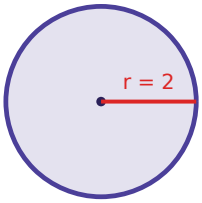


Circles: Area & Circumference · 6

Find the area of a circle with radius 4. Use π ≈ 3.14.

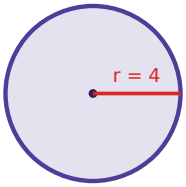


Circles: Area & Circumference · 7

Find the circumference of a circle with radius 4. Use π ≈ 3.14.

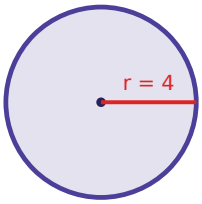


Circles: Area & Circumference · 8

Find the area of a circle with radius 5. Use π ≈ 3.14.

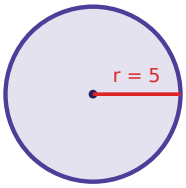

Circles: Area & Circumference · 2

**ANSWER**

**12.6**

Circles: Area & Circumference · 1

**ANSWER**

**18.8**

Circles: Area & Circumference · 4

**ANSWER**

**28.3**

Circles: Area & Circumference · 3

**ANSWER**

**31.4**

Circles: Area & Circumference · 6

**ANSWER**

**50.2**

Circles: Area & Circumference · 5

**ANSWER**

**12.6**

Circles: Area & Circumference · 8

**ANSWER**

**78.5**

Circles: Area & Circumference · 7

**ANSWER**

**25.1**

Circles: Area & Circumference · 9

Find the area of a circle with radius 6. Use π ≈ 3.14.

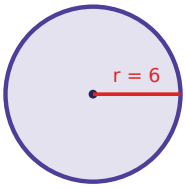


Circles: Area & Circumference · 10

Find the circumference of a circle with radius 7. Use π ≈ 3.14.

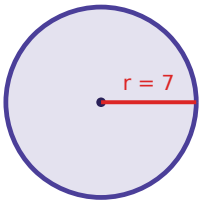


Circles: Area & Circumference · 11

Find the circumference of a circle with radius 6. Use π ≈ 3.14.

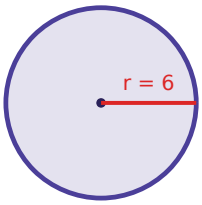


Circles: Area & Circumference · 12

Find the area of a circle with radius 7. Use π ≈ 3.14.

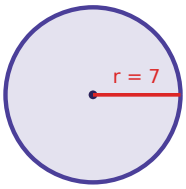

Circles: Area & Circumference · 10

**ANSWER**

**44.0**

Circles: Area & Circumference · 9

**ANSWER**

**113.0**

Circles: Area & Circumference · 12

**ANSWER**

**153.9**

Circles: Area & Circumference · 11

**ANSWER**

**37.7**