Back to School Math · 1

A grab bag at the back-to-school picnic holds 4 name tags, 4 bookmarks and 3 star stickers. Lily takes one without looking. What is the probability that it is a star sticker?

Back to School Math · 2

A round tablecloth for the back-to-school picnic has a radius of 2 feet. What is its area in square feet?

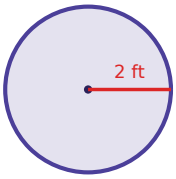

Back to School Math · 3

Ben uses 1 cup of oats to make 6 granola bars. How many cups of oats are needed for 22 granola bars?

Back to School Math · 4

A backpack costs $24.00. It is on sale for 10% off. What is the sale price?

Back to School Math · 5

A notebook costs $9.00. It is on sale for 10% off. What is the sale price?

Back to School Math · 6

A grab bag at the back-to-school picnic holds 3 name tags, 4 bookmarks and 2 star stickers. Ben takes one without looking. What is the probability that it is a star sticker?

Back to School Math · 7

Ella uses 1 cup of oats to make 8 oatmeal cookies. How many cups of oats are needed for 14 oatmeal cookies?

Back to School Math · 8

A round tablecloth for the back-to-school picnic has a radius of 3 feet. What is its area in square feet?

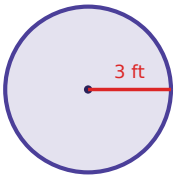

Back to School Math · 2

ANSWER

12.6

Back to School Math · 1

ANSWER

$$\frac{3}{11}$$

Back to School Math · 4

ANSWER

$21.60

Back to School Math · 3

ANSWER

$$3\frac{2}{3}$$

Back to School Math · 6

ANSWER

$$\frac{2}{9}$$

Back to School Math · 5

ANSWER

$8.10

Back to School Math · 8

ANSWER

28.3

Back to School Math · 7

ANSWER

$$1\frac{3}{4}$$

Back to School Math · 9

A grab bag at the back-to-school picnic holds 4 name tags, 1 bookmark and 3 star stickers. Leo takes one without looking. What is the probability that it is a bookmark?

Back to School Math · 10

A grab bag at the back-to-school picnic holds 3 name tags, 4 bookmarks and 2 star stickers. Lily takes one without looking. What is the probability that it is a star sticker?

Back to School Math · 11

Zoe uses 2 cups of oats to make 12 oatmeal cookies. How many cups of oats are needed for 10 oatmeal cookies?

Back to School Math · 12

A notebook costs $5.00. It is on sale for 10% off. What is the sale price?

Back to School Math · 13

A backpack costs $36.00. It is on sale for 30% off. What is the sale price?

Back to School Math · 14

Ella uses 2 cups of oats to make 4 oatmeal cookies. How many cups of oats are needed for 25 oatmeal cookies?

Back to School Math · 15

A round table at the back-to-school picnic is 4 feet across (its diameter). Ava puts ribbon once around its edge. How many feet of ribbon is that?

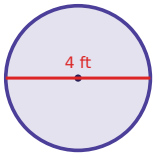

Back to School Math · 16

Lily uses 3 cups of oats to make 4 granola bars. How many cups of oats are needed for 18 granola bars?

Back to School Math · 10

ANSWER

$\frac{2}{9}$

Back to School Math · 9

ANSWER

$\frac{1}{8}$

Back to School Math · 12

ANSWER

$4.50

Back to School Math · 11

ANSWER

$1\frac{2}{3}$

Back to School Math · 14

ANSWER

$12\frac{1}{2}$

Back to School Math · 13

ANSWER

$25.20

Back to School Math · 16

ANSWER

$13\frac{1}{2}$

Back to School Math · 15

ANSWER

12.6

Back to School Math · 17

A box of crayons costs $11.00. It is on sale for 20% off. What is the sale price?

Back to School Math · 18

A grab bag at the back-to-school picnic holds 3 name tags, 5 bookmarks and 2 star stickers. Omar takes one without looking. What is the probability that it is a star sticker?

Back to School Math · 19

A grab bag at the back-to-school picnic holds 6 name tags, 6 bookmarks and 6 star stickers. Omar takes one without looking. What is the probability that it is a star sticker?

Back to School Math · 20

A backpack costs $28.00. It is on sale for 20% off. What is the sale price?

Back to School Math · 21

Zoe uses 2 cups of oats to make 12 muffins. How many cups of oats are needed for 9 muffins?

Back to School Math · 22

A box of crayons costs $9.00. It is on sale for 50% off. What is the sale price?

Back to School Math · 23

A round table at the back-to-school picnic is 5 feet across (its diameter). Sam puts ribbon once around its edge. How many feet of ribbon is that?

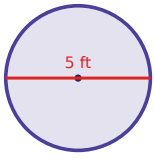

Back to School Math · 24

A grab bag at the back-to-school picnic holds 2 name tags, 4 bookmarks and 2 star stickers. Sam takes one without looking. What is the probability that it is a name tag?

Back to School Math · 18

ANSWER

$\frac{1}{5}$

Back to School Math · 17

ANSWER

$8.80

Back to School Math · 20

ANSWER

$22.40

Back to School Math · 19

ANSWER

$\frac{1}{3}$

Back to School Math · 22

ANSWER

$4.50

Back to School Math · 21

ANSWER

$1\frac{1}{2}$

Back to School Math · 24

ANSWER

$\frac{1}{4}$

Back to School Math · 23

ANSWER

15.7