Task card 1 Volume with Fractional Edge Length...

Find the volume of the rectangular prism in cubic centimeters.

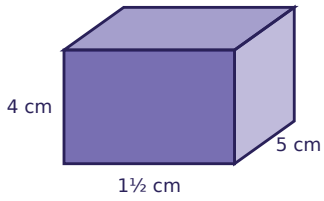

Task card 2 Volume with Fractional Edge Length...

How many cubes with $\frac{1}{2}$-meter edges are needed to fill the box?

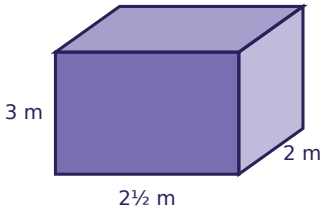

Task card 3 Volume with Fractional Edge Length...

Find the volume of the rectangular prism in cubic meters.

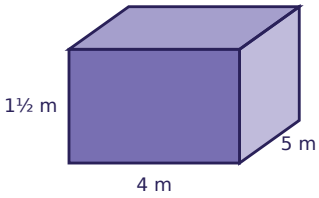

Task card 4 Volume with Fractional Edge Length...

Each edge of the cube is $1\frac{1}{2}$ feet long. Find its volume in cubic feet.

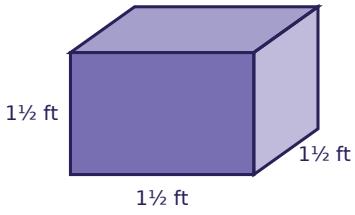

Task card 5 Volume with Fractional Edge Length...

Find the volume of the rectangular prism in cubic inches.

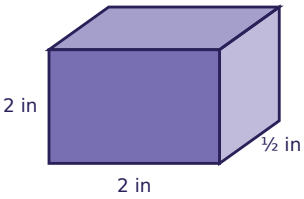

Task card 6 Volume with Fractional Edge Length...

How many cubes with $\frac{1}{2}$-foot edges are needed to fill the box?

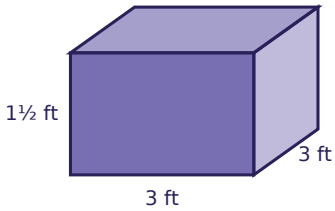

Task card 7 Volume with Fractional Edge Length...

A prism has a base area of $4\frac{3}{4}$ square feet and a height of 5 feet. Use $V = Bh$ to find its volume in cubic feet.

Task card 8 Volume with Fractional Edge Length...

Find the volume of the rectangular prism in cubic meters.

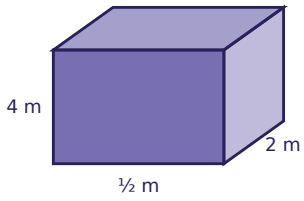

Task card 9 Volume with Fractional Edge Length...

Find the volume of the rectangular prism in cubic meters.

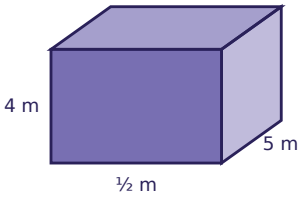

Task card 10 Volume with Fractional Edge Length...

How many cubes with $\frac{1}{2}$-centimeter edges are needed to fill the box?

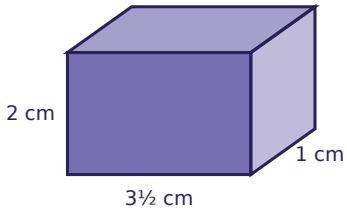

Task card 11 Volume with Fractional Edge Length...

Find the volume of the rectangular prism in cubic inches.

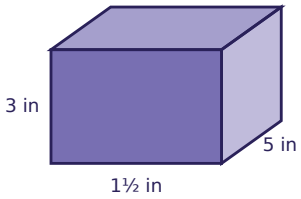

Task card 12 Volume with Fractional Edge Length...

Find the volume of the rectangular prism in cubic centimeters.

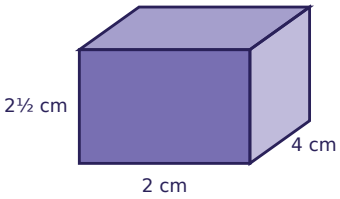

Task card 13 Volume with Fractional Edge Length...

How many cubes with $\frac{1}{2}$-centimeter edges are needed to fill the box?

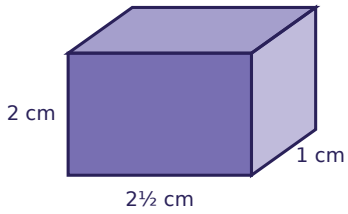

Task card 14 Volume with Fractional Edge Length...

A prism has a base area of $1\frac{1}{2}$ square meters and a height of 5 meters. Use V = Bh to find its volume in cubic meters.

Task card 15 Volume with Fractional Edge Length...

Find the volume of the rectangular prism in cubic centimeters.

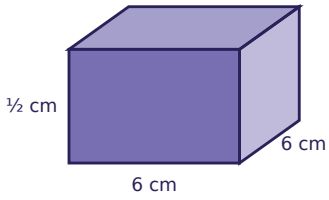

Task card 16 Volume with Fractional Edge Length...

Find the volume of the rectangular prism in cubic meters.

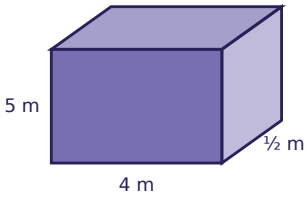

Task card 17 Volume with Fractional Edge Length...

How many cubes with $\frac{1}{2}$-meter edges are needed to fill the box?

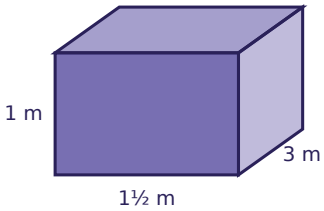

Task card 18 Volume with Fractional Edge Length...

Each edge of the cube is $2\frac{1}{2}$ inches long. Find its volume in cubic inches.

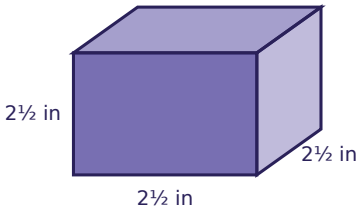

Task card 19 Volume with Fractional Edge Length...

A prism has a base area of $1\frac{1}{2}$ square centimeters and a height of 3 centimeters. Use V = Bh to find its volume in cubic centimeters.

Task card 20 Volume with Fractional Edge Length...

Find the volume of the rectangular prism in cubic inches.

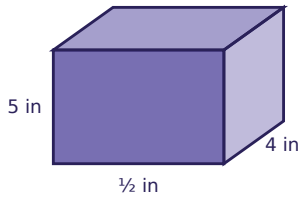

Task card 21 Volume with Fractional Edge Length...

How many cubes with $\frac{1}{2}$-inch edges are needed to fill the box?

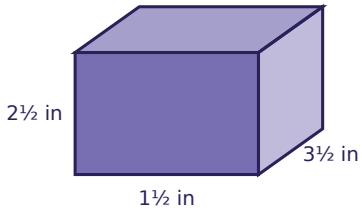

Task card 22 Volume with Fractional Edge Length...

Find the volume of the rectangular prism in cubic inches.

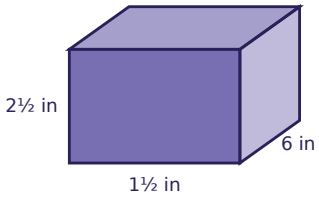

Task card 23 Volume with Fractional Edge Length...

A prism has a base area of $4\frac{3}{4}$ square centimeters and a height of 4 centimeters. Use V = Bh to find its volume in cubic centimeters.

Task card 24 Volume with Fractional Edge Length...

Find the volume of the rectangular prism in cubic feet.

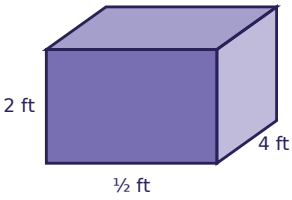

Volume with Fractional Edge Lengths Task Cards

Recording sheet · Grade 6 · Find each volume or missing length. Write fractions in simplest form, using mixed numbers when needed.

Scan to check your answers

Name: _____ Date: _____

1	2	3	4
5	6	7	8
9	10	11	12
13	14	15	16
17	18	19	20
21	22	23	24

Volume with Fractional Edge Lengths Task Cards: Answer Key

Grade 6 · Easy

The answers online

1. 30	**2.** 120	**3.** 30
4. $3\frac{3}{8}$	**5.** 2	**6.** 108
7. $23\frac{3}{4}$	**8.** 4	**9.** 10
10. 56	**11.** $22\frac{1}{2}$	**12.** 20
13. 40	**14.** $7\frac{1}{2}$	**15.** 18
16. 10	**17.** 36	**18.** $15\frac{5}{8}$
19. $4\frac{1}{2}$	**20.** 10	**21.** 105
22. $22\frac{1}{2}$	**23.** 19	**24.** 4