Surface Area of Cubes · 1

Find the surface area of the cube in square feet. Each edge is 4 ft.

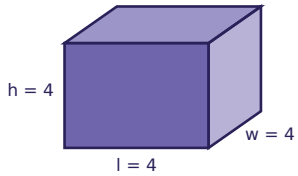


Surface Area of Cubes · 2

A cube has edges of 4 in. What is the area of just one of its faces, in square inches?

Surface Area of Cubes · 3

One face of a cube has an area of 9 square inches. What is the surface area of the whole cube, in square inches?

Surface Area of Cubes · 4

A cube has a surface area of 150 square centimeters. How long is each edge, in centimeters?

Surface Area of Cubes · 5

Every face of a cube-shaped wooden block with edges of 3 cm is painted. How many square centimeters are painted?

Surface Area of Cubes · 6

Cube A has edges of 3 cm. Cube B has edges of 4 cm. How many more square centimeters of surface area does Cube B have?

Surface Area of Cubes · 7

Omar worked out the surface area of a cube with edges of 3 in, but counted only the 4 faces around the sides, and got 36 square inches. What is the correct surface area, in square inches?

Surface Area of Cubes · 8

Find the surface area of the cube in square centimeters. Each edge is 4 cm.

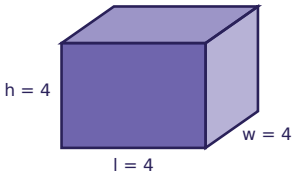

Surface Area of Cubes · 2

**ANSWER**

# 16

Surface Area of Cubes · 1

**ANSWER**

# 96

Surface Area of Cubes · 4

**ANSWER**

# 5

Surface Area of Cubes · 3

**ANSWER**

# 54

Surface Area of Cubes · 6

**ANSWER**

# 42

Surface Area of Cubes · 5

**ANSWER**

# 54

Surface Area of Cubes · 8

**ANSWER**

# 96

Surface Area of Cubes · 7

**ANSWER**

# 54

Surface Area of Cubes · 9

A cube has edges of 9 cm. What is the area of just one of its faces, in square centimeters?

Surface Area of Cubes · 10

One face of a cube has an area of 36 square meters. What is the surface area of the whole cube, in square meters?

Surface Area of Cubes · 11

A cube has a surface area of 24 square meters. How long is each edge, in meters?

Surface Area of Cubes · 12

A cube-shaped water tank has edges of 4 m. Its outside is covered in a thin layer of paint. How many square meters are painted?

Surface Area of Cubes · 13

Cube A has edges of 2 ft. Cube B has edges of 9 ft. How many more square feet of surface area does Cube B have?

Surface Area of Cubes · 14

Omar worked out the surface area of a cube with edges of 8 m, but counted only the 4 faces around the sides, and got 256 square meters. What is the correct surface area, in square meters?

Surface Area of Cubes · 15

Find the surface area of the cube in square centimeters. Each edge is 6 cm.

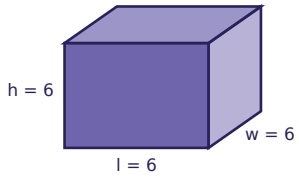


Surface Area of Cubes · 16

Find the surface area of the cube in square meters. Each edge is 9 m.

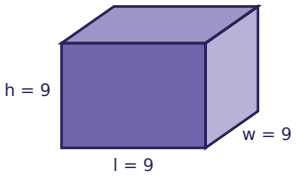

Surface Area of Cubes · 10

**ANSWER**

**216**

Surface Area of Cubes · 9

**ANSWER**

**81**

Surface Area of Cubes · 12

**ANSWER**

**96**

Surface Area of Cubes · 11

**ANSWER**

**2**

Surface Area of Cubes · 14

**ANSWER**

**384**

Surface Area of Cubes · 13

**ANSWER**

**462**

Surface Area of Cubes · 16

**ANSWER**

**486**

Surface Area of Cubes · 15

**ANSWER**

**216**

Surface Area of Cubes · 17

A cube has edges of 4 m. What is the area of just one of its faces, in square meters?

Surface Area of Cubes · 18

One face of a cube has an area of 81 square feet. What is the surface area of the whole cube, in square feet?

Surface Area of Cubes · 19

A cube has a surface area of 864 square centimeters. How long is each edge, in centimeters?

Surface Area of Cubes · 20

Cube A has edges of 7 ft. Cube B has edges of 11 ft. How many more square feet of surface area does Cube B have?

Surface Area of Cubes · 21

Omar worked out the surface area of a cube with edges of 7 m, but stopped after finding the area of one face, and got 49 square meters. What is the correct surface area, in square meters?

Surface Area of Cubes · 22

Find the surface area of the cube in square inches. Each edge is 4 in.

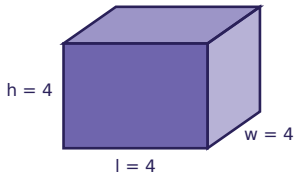


Surface Area of Cubes · 23

A cube has edges of 2 ft. What is the area of just one of its faces, in square feet?

Surface Area of Cubes · 24

One face of a cube has an area of 16 square centimeters. What is the surface area of the whole cube, in square centimeters?

Surface Area of Cubes · 18

**ANSWER**

**486**

Surface Area of Cubes · 17

**ANSWER**

**16**

Surface Area of Cubes · 20

**ANSWER**

**432**

Surface Area of Cubes · 19

**ANSWER**

**12**

Surface Area of Cubes · 22

**ANSWER**

**96**

Surface Area of Cubes · 21

**ANSWER**

**294**

Surface Area of Cubes · 24

**ANSWER**

**96**

Surface Area of Cubes · 23

**ANSWER**

**4**