Finding the Whole & the Percent (Mixed Review) · 1

10 is 10% of what number?

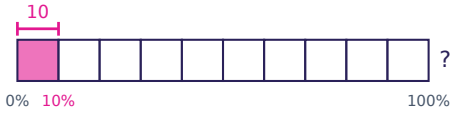

Finding the Whole & the Percent (Mixed Review) · 2

What percent of 20 is 12?

Finding the Whole & the Percent (Mixed Review) · 3

3 is 30% of what number?

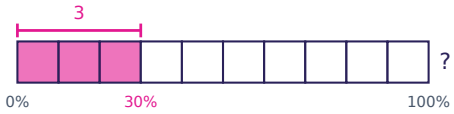

Finding the Whole & the Percent (Mixed Review) · 4

A team won 8 games. That was 50% of the games it played. How many games did the team play?

Finding the Whole & the Percent (Mixed Review) · 5

Leo answered 2 of 20 quiz questions correctly. What percent did he answer correctly?

Finding the Whole & the Percent (Mixed Review) · 6

Ana needs 100 points to win a prize. She has earned 30% of them so far. How many points has she earned?

Finding the Whole & the Percent (Mixed Review) · 7

39 is 30% of what number?

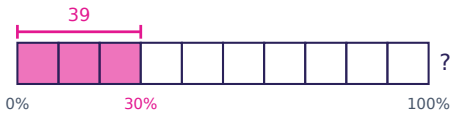

Finding the Whole & the Percent (Mixed Review) · 8

A team won 3 games. That was 5% of the games it played. How many games did the team play?

Finding the Whole & the Percent (Mixed Review) · 2

ANSWER

60%

Finding the Whole & the Percent (Mixed Review) · 1

ANSWER

100

Finding the Whole & the Percent (Mixed Review) · 4

ANSWER

16

Finding the Whole & the Percent (Mixed Review) · 3

ANSWER

10

Finding the Whole & the Percent (Mixed Review) · 6

ANSWER

30

Finding the Whole & the Percent (Mixed Review) · 5

ANSWER

10%

Finding the Whole & the Percent (Mixed Review) · 8

ANSWER

60

Finding the Whole & the Percent (Mixed Review) · 7

ANSWER

130

Finding the Whole & the Percent (Mixed Review) · 9

12 is 40% of what number?

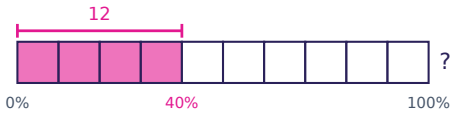

Finding the Whole & the Percent (Mixed Review) · 10

What percent of 130 is 13?

Finding the Whole & the Percent (Mixed Review) · 11

90 is 60% of what number?

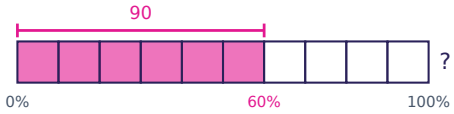

Finding the Whole & the Percent (Mixed Review) · 12

A team won 34 games. That was 25% of the games it played. How many games did the team play?

Finding the Whole & the Percent (Mixed Review) · 13

Leo answered 84 of 140 quiz questions correctly. What percent did he answer correctly?

Finding the Whole & the Percent (Mixed Review) · 14

A 112-page book is 25% pictures. How many pages are pictures?

Finding the Whole & the Percent (Mixed Review) · 15

81 is 60% of what number?

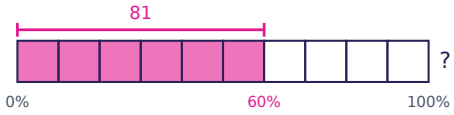

Finding the Whole & the Percent (Mixed Review) · 16

29 students in a class walk to school. That is 50% of the class. How many students are in the class?

Finding the Whole & the Percent (Mixed Review) · 10

ANSWER

10%

Finding the Whole & the Percent (Mixed Review) · 9

ANSWER

30

Finding the Whole & the Percent (Mixed Review) · 12

ANSWER

136

Finding the Whole & the Percent (Mixed Review) · 11

ANSWER

150

Finding the Whole & the Percent (Mixed Review) · 14

ANSWER

28

Finding the Whole & the Percent (Mixed Review) · 13

ANSWER

60%

Finding the Whole & the Percent (Mixed Review) · 16

ANSWER

58

Finding the Whole & the Percent (Mixed Review) · 15

ANSWER

135

Finding the Whole & the Percent (Mixed Review) · 17

63 is 45% of what number?

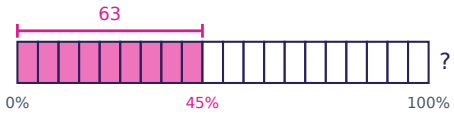

Finding the Whole & the Percent (Mixed Review) · 18

What percent of 60 is 3?

Finding the Whole & the Percent (Mixed Review) · 19

42 is 70% of what number?

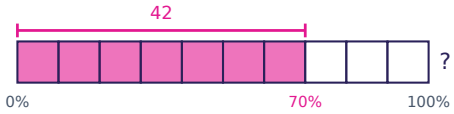

Finding the Whole & the Percent (Mixed Review) · 20

A farmer has planted 3 rows of corn, which is 15% of the rows he plans to plant. How many rows does he plan to plant in all?

Finding the Whole & the Percent (Mixed Review) · 21

Leo answered 48 of 60 quiz questions correctly. What percent did he answer correctly?

Finding the Whole & the Percent (Mixed Review) · 22

A 170-page book is 70% pictures. How many pages are pictures?

Finding the Whole & the Percent (Mixed Review) · 23

54 is 30% of what number?

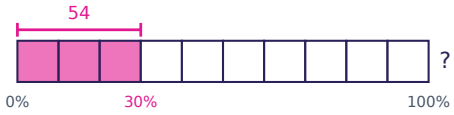

Finding the Whole & the Percent (Mixed Review) · 24

A team won 30 games. That was 30% of the games it played. How many games did the team play?

Finding the Whole & the Percent (Mixed Review) · 18

ANSWER

5%

Finding the Whole & the Percent (Mixed Review) · 17

ANSWER

140

Finding the Whole & the Percent (Mixed Review) · 20

ANSWER

20

Finding the Whole & the Percent (Mixed Review) · 19

ANSWER

60

Finding the Whole & the Percent (Mixed Review) · 22

ANSWER

119

Finding the Whole & the Percent (Mixed Review) · 21

ANSWER

80%

Finding the Whole & the Percent (Mixed Review) · 24

ANSWER

100

Finding the Whole & the Percent (Mixed Review) · 23

ANSWER

180