Finding the Whole & the Percent (Mixed Review) · 1

3 is 5% of what number?

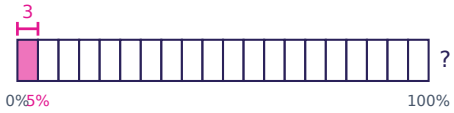

Finding the Whole & the Percent (Mixed Review) · 2

What percent of 40 is 14?

Finding the Whole & the Percent (Mixed Review) · 3

9 is 90% of what number?

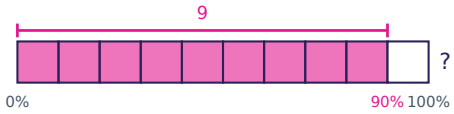

Finding the Whole & the Percent (Mixed Review) · 4

A team won 7 games. That was 35% of the games it played. How many games did the team play?

Finding the Whole & the Percent (Mixed Review) · 5

A library has 160 new books, and 64 of them are mysteries. What percent of the new books are mysteries?

Finding the Whole & the Percent (Mixed Review) · 6

There are 120 students in the school play, and 35% of them are singers. How many singers are there?

Finding the Whole & the Percent (Mixed Review) · 7

123 is 75% of what number?

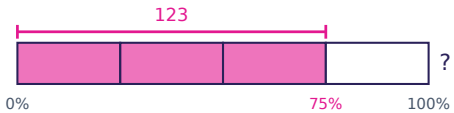

Finding the Whole & the Percent (Mixed Review) · 8

Jen has saved $63. That is 90% of the price of a bike. What is the price of the bike, in dollars?

Finding the Whole & the Percent (Mixed Review) · 2

ANSWER

35%

Finding the Whole & the Percent (Mixed Review) · 1

ANSWER

60

Finding the Whole & the Percent (Mixed Review) · 4

ANSWER

20

Finding the Whole & the Percent (Mixed Review) · 3

ANSWER

10

Finding the Whole & the Percent (Mixed Review) · 6

ANSWER

42

Finding the Whole & the Percent (Mixed Review) · 5

ANSWER

40%

Finding the Whole & the Percent (Mixed Review) · 8

ANSWER

70

Finding the Whole & the Percent (Mixed Review) · 7

ANSWER

164

Finding the Whole & the Percent (Mixed Review) · 9

42 is 35% of what number?

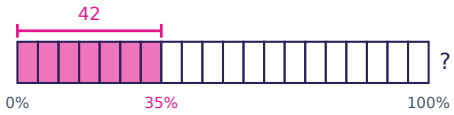

Finding the Whole & the Percent (Mixed Review) · 10

What percent of 40 is 2?

Finding the Whole & the Percent (Mixed Review) · 11

15 is 30% of what number?

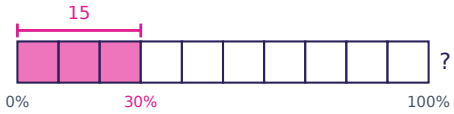

Finding the Whole & the Percent (Mixed Review) · 12

57 students in a class walk to school. That is 75% of the class. How many students are in the class?

Finding the Whole & the Percent (Mixed Review) · 13

A store had 220 shirts and sold 154 of them. What percent of the shirts were sold?

Finding the Whole & the Percent (Mixed Review) · 14

A 70-page book is 30% pictures. How many pages are pictures?

Finding the Whole & the Percent (Mixed Review) · 15

35 is 70% of what number?

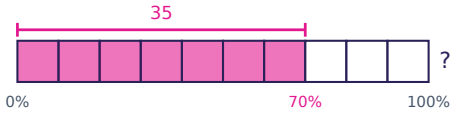

Finding the Whole & the Percent (Mixed Review) · 16

A team won 119 games. That was 50% of the games it played. How many games did the team play?

Finding the Whole & the Percent (Mixed Review) · 10

ANSWER

5%

Finding the Whole & the Percent (Mixed Review) · 9

ANSWER

120

Finding the Whole & the Percent (Mixed Review) · 12

ANSWER

76

Finding the Whole & the Percent (Mixed Review) · 11

ANSWER

50

Finding the Whole & the Percent (Mixed Review) · 14

ANSWER

21

Finding the Whole & the Percent (Mixed Review) · 13

ANSWER

70%

Finding the Whole & the Percent (Mixed Review) · 16

ANSWER

238

Finding the Whole & the Percent (Mixed Review) · 15

ANSWER

50

Finding the Whole & the Percent (Mixed Review) · 17

14 is 35% of what number?

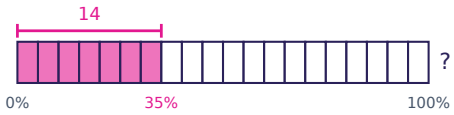

Finding the Whole & the Percent (Mixed Review) · 18

What percent of 120 is 30?

Finding the Whole & the Percent (Mixed Review) · 19

20 is 25% of what number?

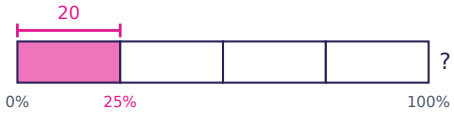

Finding the Whole & the Percent (Mixed Review) · 20

A team won 60 games. That was 60% of the games it played. How many games did the team play?

Finding the Whole & the Percent (Mixed Review) · 21

A store had 212 shirts and sold 53 of them. What percent of the shirts were sold?

Finding the Whole & the Percent (Mixed Review) · 22

There are 140 students in the school play, and 45% of them are singers. How many singers are there?

Finding the Whole & the Percent (Mixed Review) · 23

18 is 30% of what number?

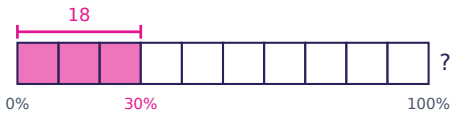

Finding the Whole & the Percent (Mixed Review) · 24

A team won 33 games. That was 50% of the games it played. How many games did the team play?

Finding the Whole & the Percent (Mixed Review) · 18

ANSWER

25%

Finding the Whole & the Percent (Mixed Review) · 17

ANSWER

40

Finding the Whole & the Percent (Mixed Review) · 20

ANSWER

100

Finding the Whole & the Percent (Mixed Review) · 19

ANSWER

80

Finding the Whole & the Percent (Mixed Review) · 22

ANSWER

63

Finding the Whole & the Percent (Mixed Review) · 21

ANSWER

25%

Finding the Whole & the Percent (Mixed Review) · 24

ANSWER

66

Finding the Whole & the Percent (Mixed Review) · 23

ANSWER

60