Task card 1 Nets & Surface Area

The box is measured in feet. Find its surface area in square feet.

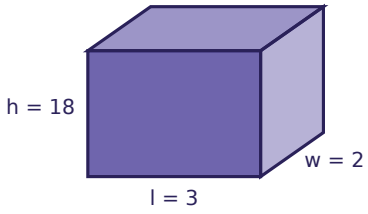

Task card 2 Nets & Surface Area

The triangular prism is measured in inches. Each slanted side of the triangle is 10 inches. Find the surface area in square inches.

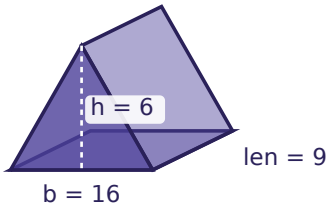

Task card 3 Nets & Surface Area

Find the surface area of the square pyramid in square inches.

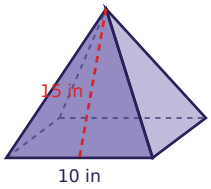

Task card 4 Nets & Surface Area

The net folds into a rectangular prism. Find the surface area in square inches.

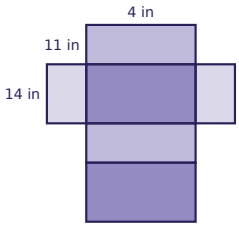

Task card 5 Nets & Surface Area

The triangular prism is measured in meters. Each slanted side of the triangle is 15 meters. Find the surface area in square meters.

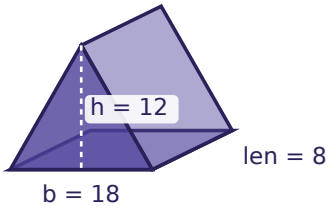

Task card 6 Nets & Surface Area

The box is measured in meters. Find its surface area in square meters.

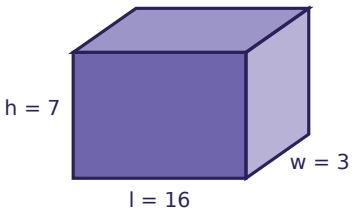

Task card 7 Nets & Surface Area

Find the surface area of the square pyramid in square centimeters.

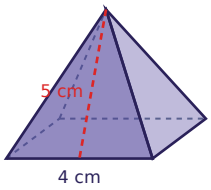

Task card 8 Nets & Surface Area

The cube is measured in feet. Find its surface area in square feet.

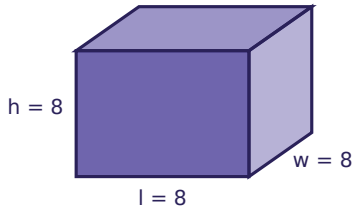

Task card 9 Nets & Surface Area

The box is measured in centimeters. Find its surface area in square centimeters.

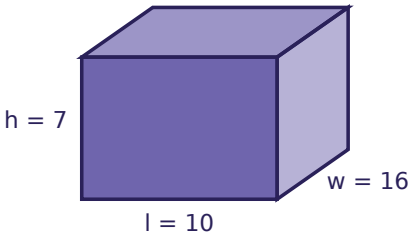

Task card 10 Nets & Surface Area

The triangular prism is measured in meters. Each slanted side of the triangle is 5 meters. Find the surface area in square meters.

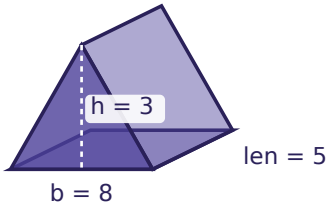

Task card 11 Nets & Surface Area

Find the surface area of the square pyramid in square feet.

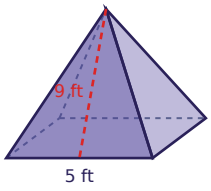

Task card 12 Nets & Surface Area

The net folds into a rectangular prism. Find the surface area in square centimeters.

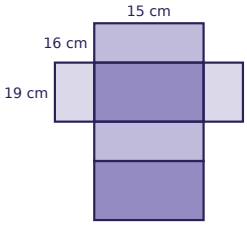

Task card 13 Nets & Surface Area

The triangular prism is measured in meters. Each slanted side of the triangle is 5 meters. Find the surface area in square meters.

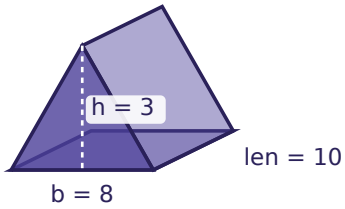

Task card 14 Nets & Surface Area

The box is measured in meters. Find its surface area in square meters.

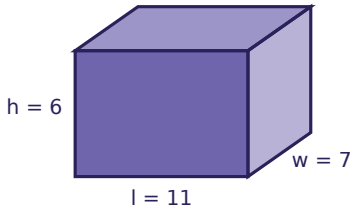

Task card 15 Nets & Surface Area

Find the surface area of the square pyramid in square centimeters.

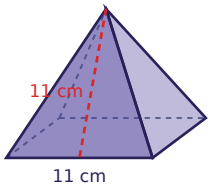

Task card 16 Nets & Surface Area

The cube is measured in centimeters. Find its surface area in square centimeters.

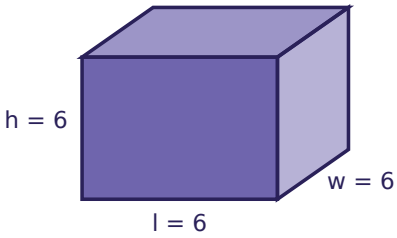

Task card 17 Nets & Surface Area

The box is measured in inches. Find its surface area in square inches.

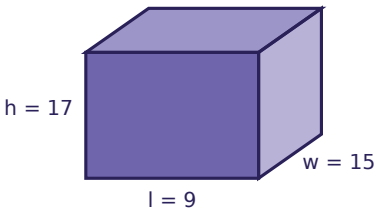

Task card 18 Nets & Surface Area

The triangular prism is measured in feet. Each slanted side of the triangle is 10 feet. Find the surface area in square feet.

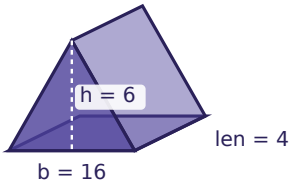

Task card 19 Nets & Surface Area

Find the surface area of the square pyramid in square inches.

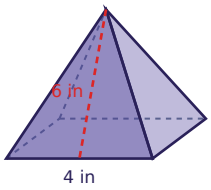

Task card 20 Nets & Surface Area

The net folds into a rectangular prism. Find the surface area in square meters.

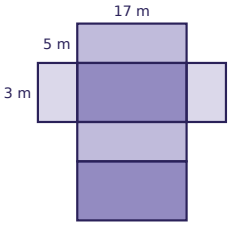

Task card 21 Nets & Surface Area

The triangular prism is measured in feet. Each slanted side of the triangle is 10 feet. Find the surface area in square feet.

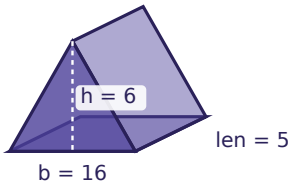

Task card 22 Nets & Surface Area

The box is measured in meters. Find its surface area in square meters.

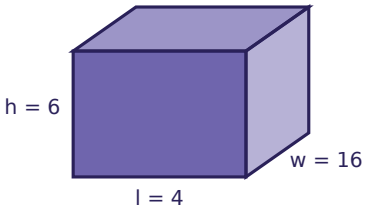

Task card 23 Nets & Surface Area

Find the surface area of the square pyramid in square centimeters.

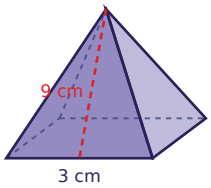

Task card 24 Nets & Surface Area

The cube is measured in feet. Find its surface area in square feet.

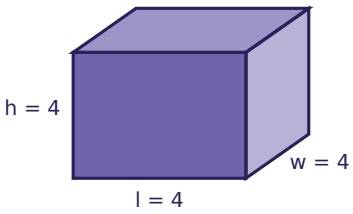

Nets & Surface Area Task Cards

Recording sheet · Grade 6 · Find each surface area, or answer the question about the net.

Name: _____ Date: _____

Scan to check your answers

1	2	3	4
5	6	7	8
9	10	11	12
13	14	15	16
17	18	19	20
21	22	23	24

Nets & Surface Area Task Cards: Answer Key

Grade 6 · Hard

The answers online

1. 192	**2.** 420	**3.** 400
4. 508	**5.** 600	**6.** 362
7. 56	**8.** 384	**9.** 684
10. 114	**11.** 115	**12.** 1658
13. 204	**14.** 370	**15.** 363
16. 216	**17.** 1086	**18.** 240
19. 64	**20.** 302	**21.** 276
22. 368	**23.** 63	**24.** 96