Nets & Surface Area · 1

The net folds into a rectangular prism. Find the surface area in square feet.

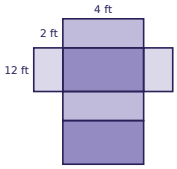

Nets & Surface Area · 2

The box is measured in meters. Find its surface area in square meters.

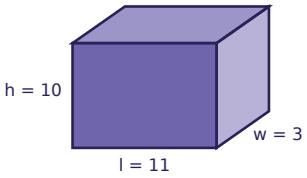

Nets & Surface Area · 3

The cube is measured in meters. Find its surface area in square meters.

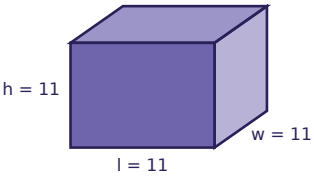

Nets & Surface Area · 4

Find the surface area of the square pyramid in square centimeters.

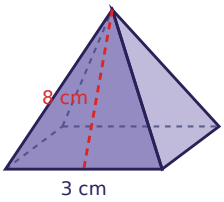

Nets & Surface Area · 5

A net is made of 1 square and 4 triangles. What solid does it fold into? Choose: cube, rectangular prism, triangular prism, square pyramid, triangular pyramid.

Nets & Surface Area · 6

The box is measured in inches. Find its surface area in square inches.

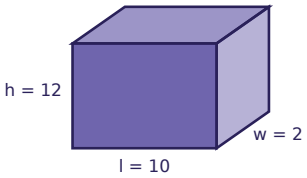

Nets & Surface Area · 7

Find the surface area of the square pyramid in square feet.

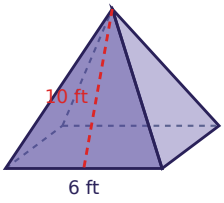

Nets & Surface Area · 8

The net folds into a rectangular prism. Find the surface area in square centimeters.

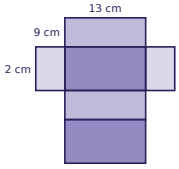

Nets & Surface Area · 2

ANSWER

346

Nets & Surface Area · 1

ANSWER

160

Nets & Surface Area · 4

ANSWER

57

Nets & Surface Area · 3

ANSWER

726

Nets & Surface Area · 6

ANSWER

328

Nets & Surface Area · 5

ANSWER

square pyramid

Nets & Surface Area · 8

ANSWER

322

Nets & Surface Area · 7

ANSWER

156

Nets & Surface Area · 9

The box is measured in inches. Find its surface area in square inches.

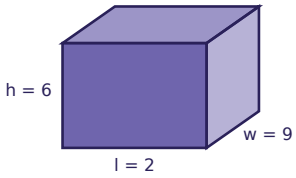

Nets & Surface Area · 10

The triangular prism is measured in centimeters. Each slanted side of the triangle is 5 centimeters. Find the surface area in square centimeters.

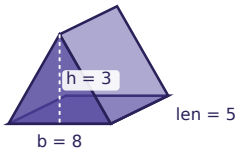

Nets & Surface Area · 11

Find the surface area of the square pyramid in square meters.

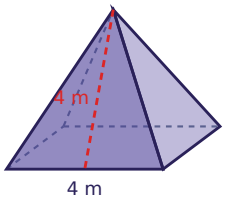

Nets & Surface Area · 12

The net folds into a rectangular prism. Find the surface area in square meters.

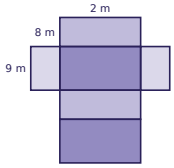

Nets & Surface Area · 13

The triangular prism is measured in centimeters. Each slanted side of the triangle is 13 centimeters. Find the surface area in square centimeters.

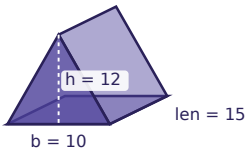

Nets & Surface Area · 14

The box is measured in feet. Find its surface area in square feet.

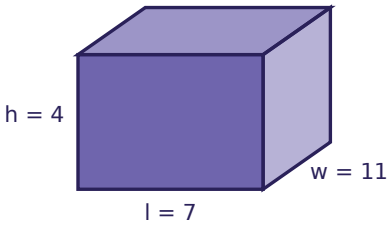

Nets & Surface Area · 15

Find the surface area of the square pyramid in square centimeters.

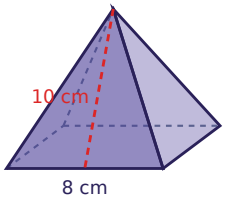

Nets & Surface Area · 16

The cube is measured in feet. Find its surface area in square feet.

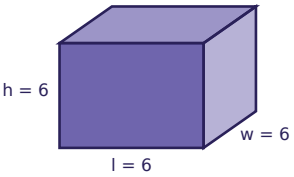

Nets & Surface Area · 10

ANSWER

114

Nets & Surface Area · 9

ANSWER

168

Nets & Surface Area · 12

ANSWER

212

Nets & Surface Area · 11

ANSWER

48

Nets & Surface Area · 14

ANSWER

298

Nets & Surface Area · 13

ANSWER

660

Nets & Surface Area · 16

ANSWER

216

Nets & Surface Area · 15

ANSWER

224

Nets & Surface Area · 17

The box is measured in inches. Find its surface area in square inches.

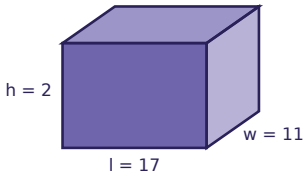

Nets & Surface Area · 18

The triangular prism is measured in feet. Each slanted side of the triangle is 15 feet. Find the surface area in square feet.

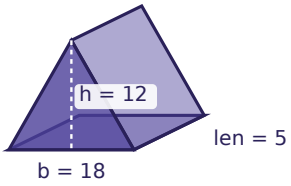

Nets & Surface Area · 19

Find the surface area of the square pyramid in square meters.

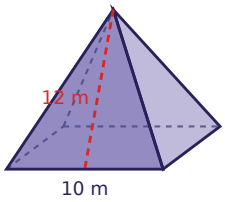

Nets & Surface Area · 20

The net folds into a rectangular prism. Find the surface area in square inches.

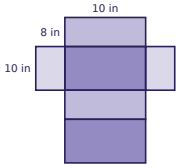

Nets & Surface Area · 21

The triangular prism is measured in feet. Each slanted side of the triangle is 10 feet. Find the surface area in square feet.

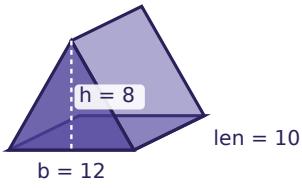

Nets & Surface Area · 22

The box is measured in centimeters. Find its surface area in square centimeters.

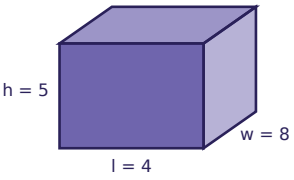

Nets & Surface Area · 23

Find the surface area of the square pyramid in square meters.

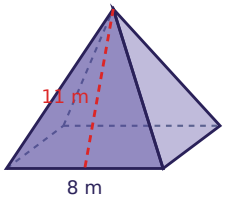

Nets & Surface Area · 24

The cube is measured in meters. Find its surface area in square meters.

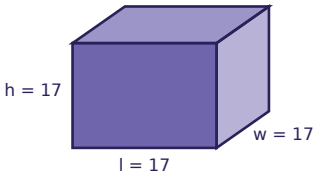

Nets & Surface Area · 18

ANSWER

456

Nets & Surface Area · 17

ANSWER

486

Nets & Surface Area · 20

ANSWER

520

Nets & Surface Area · 19

ANSWER

340

Nets & Surface Area · 22

ANSWER

184

Nets & Surface Area · 21

ANSWER

416

Nets & Surface Area · 24

ANSWER

1734

Nets & Surface Area · 23

ANSWER

240