Nets & Surface Area · 1

The box is measured in feet. Find its surface area in square feet.

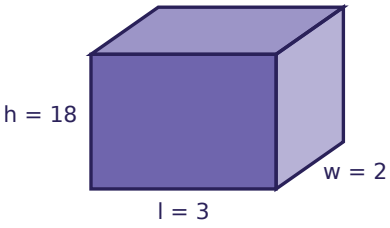

Nets & Surface Area · 2

The triangular prism is measured in inches. Each slanted side of the triangle is 10 inches. Find the surface area in square inches.

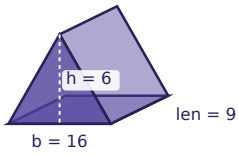

Nets & Surface Area · 3

Find the surface area of the square pyramid in square inches.

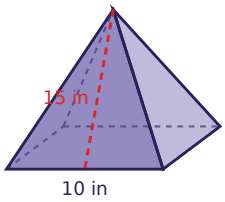

Nets & Surface Area · 4

The net folds into a rectangular prism. Find the surface area in square inches.

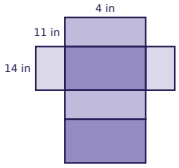

Nets & Surface Area · 5

The triangular prism is measured in meters. Each slanted side of the triangle is 15 meters. Find the surface area in square meters.

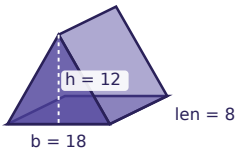

Nets & Surface Area · 6

The box is measured in meters. Find its surface area in square meters.

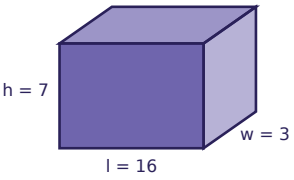

Nets & Surface Area · 7

Find the surface area of the square pyramid in square centimeters.

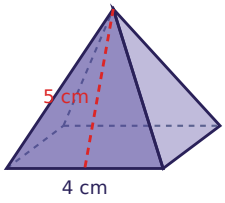

Nets & Surface Area · 8

The cube is measured in feet. Find its surface area in square feet.

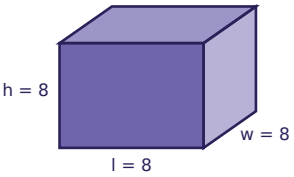

Nets & Surface Area · 2

ANSWER

420

Nets & Surface Area · 1

ANSWER

192

Nets & Surface Area · 4

ANSWER

508

Nets & Surface Area · 3

ANSWER

400

Nets & Surface Area · 6

ANSWER

362

Nets & Surface Area · 5

ANSWER

600

Nets & Surface Area · 8

ANSWER

384

Nets & Surface Area · 7

ANSWER

56

Nets & Surface Area · 9

The box is measured in centimeters. Find its surface area in square centimeters.

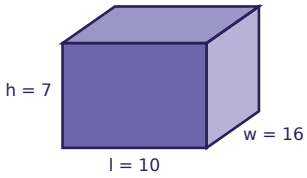

Nets & Surface Area · 10

The triangular prism is measured in meters. Each slanted side of the triangle is 5 meters. Find the surface area in square meters.

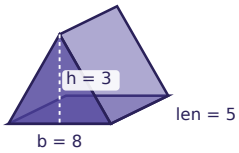

Nets & Surface Area · 11

Find the surface area of the square pyramid in square feet.

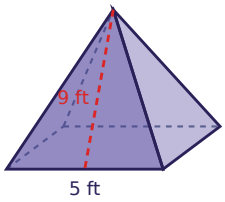

Nets & Surface Area · 12

The net folds into a rectangular prism. Find the surface area in square centimeters.

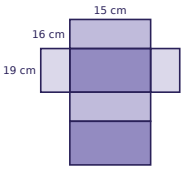

Nets & Surface Area · 13

The triangular prism is measured in meters. Each slanted side of the triangle is 5 meters. Find the surface area in square meters.

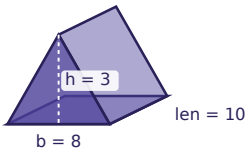

Nets & Surface Area · 14

The box is measured in meters. Find its surface area in square meters.

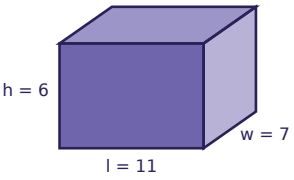

Nets & Surface Area · 15

Find the surface area of the square pyramid in square centimeters.

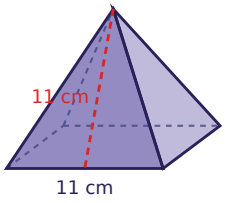

Nets & Surface Area · 16

The cube is measured in centimeters. Find its surface area in square centimeters.

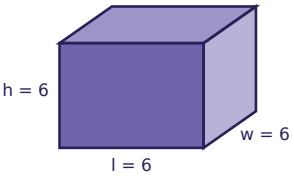

Nets & Surface Area · 10

ANSWER

114

Nets & Surface Area · 9

ANSWER

684

Nets & Surface Area · 12

ANSWER

1658

Nets & Surface Area · 11

ANSWER

115

Nets & Surface Area · 14

ANSWER

370

Nets & Surface Area · 13

ANSWER

204

Nets & Surface Area · 16

ANSWER

216

Nets & Surface Area · 15

ANSWER

363

Nets & Surface Area · 17

The box is measured in inches. Find its surface area in square inches.

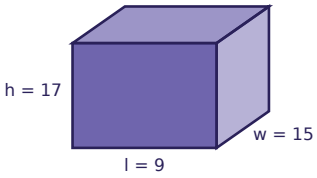

Nets & Surface Area · 18

The triangular prism is measured in feet. Each slanted side of the triangle is 10 feet. Find the surface area in square feet.

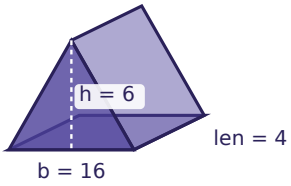

Nets & Surface Area · 19

Find the surface area of the square pyramid in square inches.

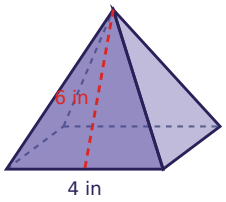

Nets & Surface Area · 20

The net folds into a rectangular prism. Find the surface area in square meters.

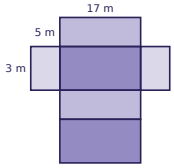

Nets & Surface Area · 21

The triangular prism is measured in feet. Each slanted side of the triangle is 10 feet. Find the surface area in square feet.

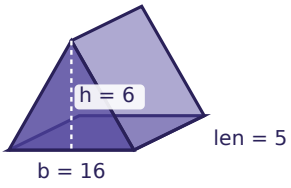

Nets & Surface Area · 22

The box is measured in meters. Find its surface area in square meters.

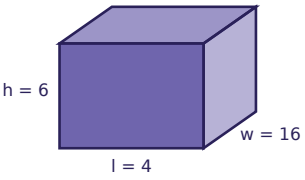

Nets & Surface Area · 23

Find the surface area of the square pyramid in square centimeters.

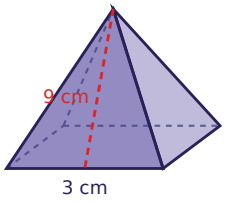

Nets & Surface Area · 24

The cube is measured in feet. Find its surface area in square feet.

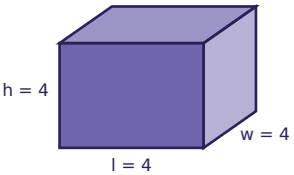

Nets & Surface Area · 18

ANSWER

240

Nets & Surface Area · 17

ANSWER

1086

Nets & Surface Area · 20

ANSWER

302

Nets & Surface Area · 19

ANSWER

64

Nets & Surface Area · 22

ANSWER

368

Nets & Surface Area · 21

ANSWER

276

Nets & Surface Area · 24

ANSWER

96

Nets & Surface Area · 23

ANSWER

63