Nets & Surface Area · 1

The net folds into a rectangular prism. Find the surface area in square inches.

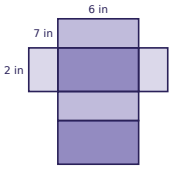

Nets & Surface Area · 2

The cube is measured in feet. Find its surface area in square feet.

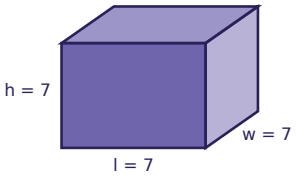

Nets & Surface Area · 3

How many faces does the net of a cube have?

Nets & Surface Area · 4

The box is measured in feet. Find its surface area in square feet.

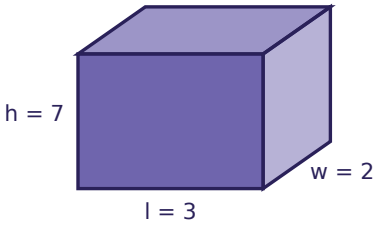

Nets & Surface Area · 5

The net folds into a rectangular prism. Find the surface area in square inches.

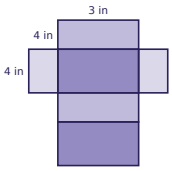

Nets & Surface Area · 6

The cube is measured in inches. Find its surface area in square inches.

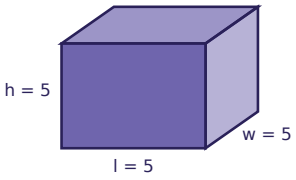

Nets & Surface Area · 7

A net is made of 6 squares. What solid does it fold into? Choose: cube, rectangular prism, triangular prism, square pyramid, triangular pyramid.

Nets & Surface Area · 8

The box is measured in meters. Find its surface area in square meters.

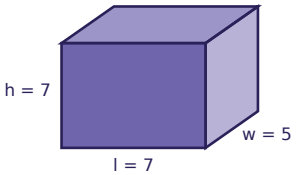

Nets & Surface Area · 2

ANSWER

294

Nets & Surface Area · 1

ANSWER

136

Nets & Surface Area · 4

ANSWER

82

Nets & Surface Area · 3

ANSWER

6

Nets & Surface Area · 6

ANSWER

150

Nets & Surface Area · 5

ANSWER

80

Nets & Surface Area · 8

ANSWER

238

Nets & Surface Area · 7

ANSWER

cube

Nets & Surface Area · 9

The net folds into a rectangular prism. Find the surface area in square centimeters.

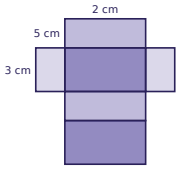

Nets & Surface Area · 10

The cube is measured in meters. Find its surface area in square meters.

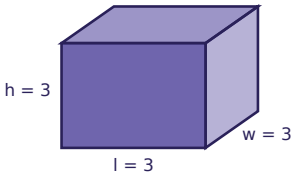

Nets & Surface Area · 11

How many faces does the net of a rectangular prism have?

Nets & Surface Area · 12

The box is measured in meters. Find its surface area in square meters.

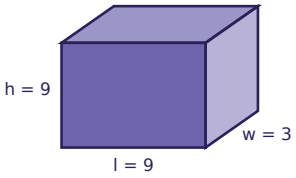

Nets & Surface Area · 13

The net folds into a rectangular prism. Find the surface area in square meters.

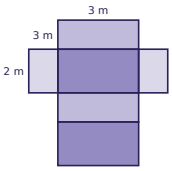

Nets & Surface Area · 14

The cube is measured in centimeters. Find its surface area in square centimeters.

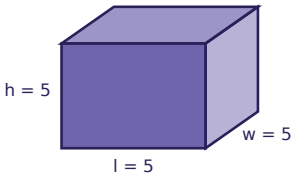

Nets & Surface Area · 15

A net is made of 4 triangles. What solid does it fold into? Choose: cube, rectangular prism, triangular prism, square pyramid, triangular pyramid.

Nets & Surface Area · 16

The box is measured in feet. Find its surface area in square feet.

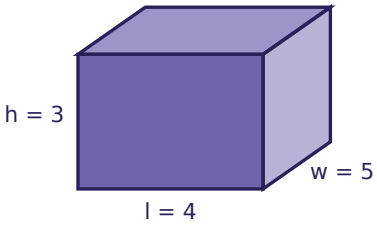

Nets & Surface Area · 10

ANSWER

54

Nets & Surface Area · 9

ANSWER

62

Nets & Surface Area · 12

ANSWER

270

Nets & Surface Area · 11

ANSWER

6

Nets & Surface Area · 14

ANSWER

150

Nets & Surface Area · 13

ANSWER

42

Nets & Surface Area · 16

ANSWER

94

Nets & Surface Area · 15

ANSWER

triangular pyramid

Nets & Surface Area · 17

The net folds into a rectangular prism. Find the surface area in square meters.

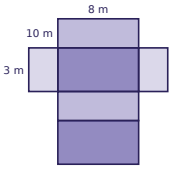

Nets & Surface Area · 18

The box is measured in feet. Find its surface area in square feet.

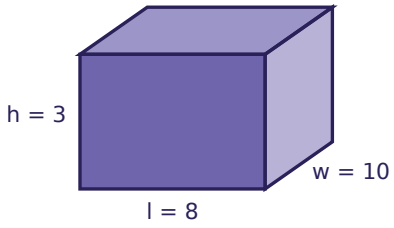

Nets & Surface Area · 19

The cube is measured in feet. Find its surface area in square feet.

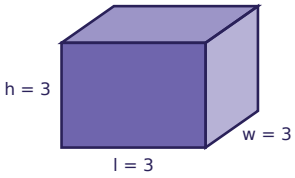

Nets & Surface Area · 20

Find the surface area of the square pyramid in square feet.

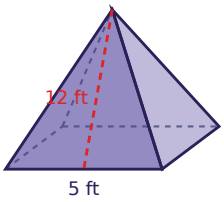

Nets & Surface Area · 21

A net is made of 1 square and 4 triangles. What solid does it fold into? Choose: cube, rectangular prism, triangular prism, square pyramid, triangular pyramid.

Nets & Surface Area · 22

The box is measured in feet. Find its surface area in square feet.

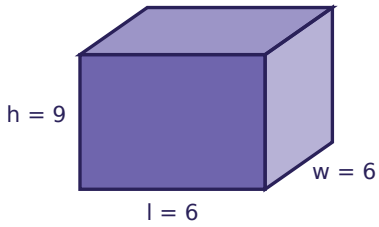

Nets & Surface Area · 23

Find the surface area of the square pyramid in square meters.

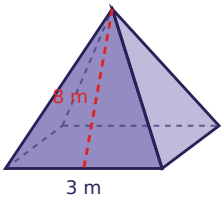

Nets & Surface Area · 24

The net folds into a rectangular prism. Find the surface area in square feet.

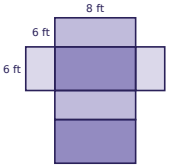

Nets & Surface Area · 18

ANSWER

268

Nets & Surface Area · 17

ANSWER

268

Nets & Surface Area · 20

ANSWER

145

Nets & Surface Area · 19

ANSWER

54

Nets & Surface Area · 22

ANSWER

288

Nets & Surface Area · 21

ANSWER

square pyramid

Nets & Surface Area · 24

ANSWER

264

Nets & Surface Area · 23

ANSWER

57