Dot Plots & Histograms · 1

Each dot stands for one student. How many students are in the dot plot?



Dot Plots & Histograms · 2

How many students are in the 60-69 interval?

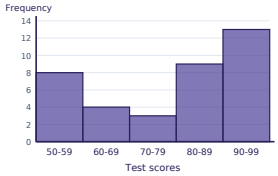

Dot Plots & Histograms · 3

Each dot stands for one student. What is the mode? (The mode is the value with the most dots above it.)

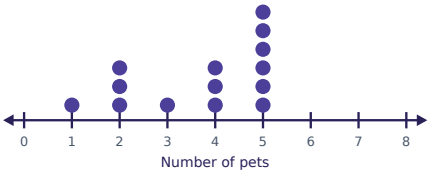

Dot Plots & Histograms · 4

How many games are shown in the histogram in all?

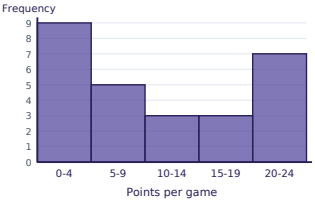

Dot Plots & Histograms · 5

Each dot stands for one student. What is the median number of books read?



Dot Plots & Histograms · 6

How many games had a value of at least 5?

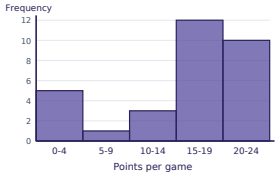

Dot Plots & Histograms · 7

Each dot stands for one student. What is the range of the data? (Range = greatest value − least value.)



Dot Plots & Histograms · 8

Which interval has the most data? Write the interval as it is labeled.

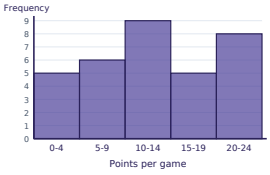

Dot Plots & Histograms · 2

ANSWER

4

Dot Plots & Histograms · 1

ANSWER

18

Dot Plots & Histograms · 4

ANSWER

27

Dot Plots & Histograms · 3

ANSWER

5

Dot Plots & Histograms · 6

ANSWER

26

Dot Plots & Histograms · 5

ANSWER

3

Dot Plots & Histograms · 8

ANSWER

10–14

Dot Plots & Histograms · 7

ANSWER

5

Dot Plots & Histograms · 9

Each dot stands for one student. How many students are in the dot plot?

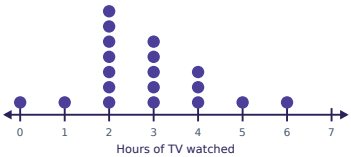

Dot Plots & Histograms · 10

How many plants are in the 30-39 interval?

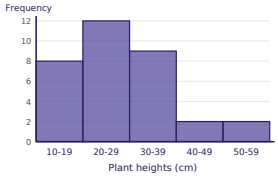

Dot Plots & Histograms · 11

Each dot stands for one student. What is the mode? (The mode is the value with the most dots above it.)

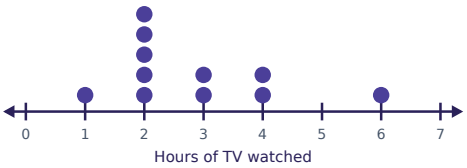

Dot Plots & Histograms · 12

How many visitors are shown in the histogram in all?

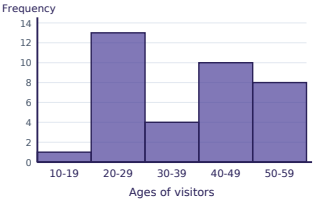

Dot Plots & Histograms · 13

Each dot stands for one student. What is the median shoe size?

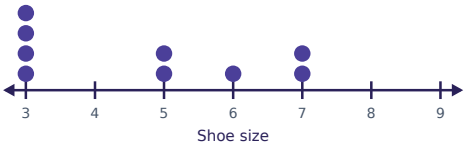

Dot Plots & Histograms · 14

How many students had a value of at least 10?

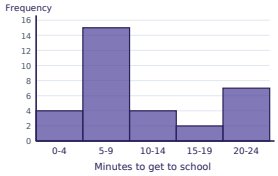

Dot Plots & Histograms · 15

Each dot stands for one student. What is the range of the data? (Range = greatest value − least value.)



Dot Plots & Histograms · 16

Which interval has the most data? Write the interval as it is labeled.

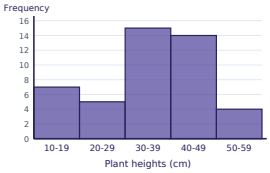

Dot Plots & Histograms · 10

ANSWER

9

Dot Plots & Histograms · 9

ANSWER

19

Dot Plots & Histograms · 12

ANSWER

36

Dot Plots & Histograms · 11

ANSWER

2

Dot Plots & Histograms · 14

ANSWER

13

Dot Plots & Histograms · 13

ANSWER

5

Dot Plots & Histograms · 16

ANSWER

30–39

Dot Plots & Histograms · 15

ANSWER

4

Dot Plots & Histograms · 17

Each dot stands for one student. How many students are in the dot plot?



Dot Plots & Histograms · 18

How many visitors are in the 40-49 interval?

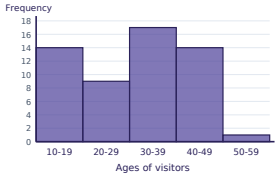

Dot Plots & Histograms · 19

Each dot stands for one student. What is the mode? (The mode is the value with the most dots above it.)



Dot Plots & Histograms · 20

How many games are shown in the histogram in all?

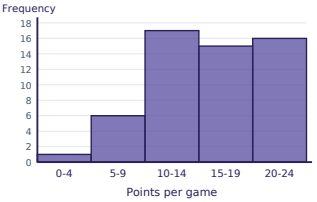

Dot Plots & Histograms · 21

Each dot stands for one student. What is the median number of hours of TV watched?

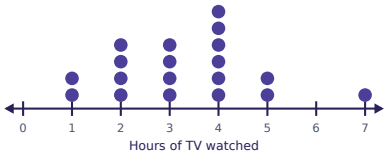

Dot Plots & Histograms · 22

How many games had a value of at least 10?

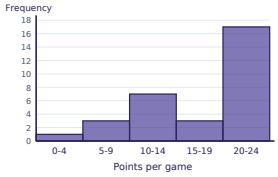

Dot Plots & Histograms · 23

Each dot stands for one student. What is the range of the data? (Range = greatest value − least value.)

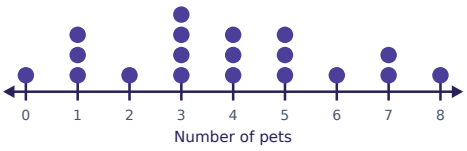

Dot Plots & Histograms · 24

Which interval has the most data? Write the interval as it is labeled.

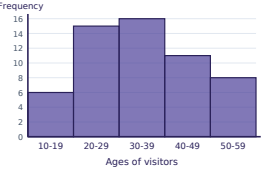

Dot Plots & Histograms · 18

ANSWER

14

Dot Plots & Histograms · 17

ANSWER

14

Dot Plots & Histograms · 20

ANSWER

55

Dot Plots & Histograms · 19

ANSWER

2

Dot Plots & Histograms · 22

ANSWER

27

Dot Plots & Histograms · 21

ANSWER

3

Dot Plots & Histograms · 24

ANSWER

30–39

Dot Plots & Histograms · 23

ANSWER

8