Dot Plots & Histograms · 1

Each dot stands for one student. How many students are in the dot plot?

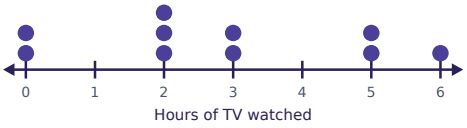

Dot Plots & Histograms · 2

How many plants are in the 30-39 interval?

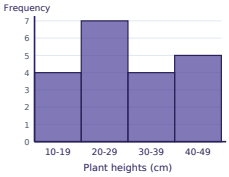

Dot Plots & Histograms · 3

Each dot stands for one student. What is the mode? (The mode is the value with the most dots above it.)

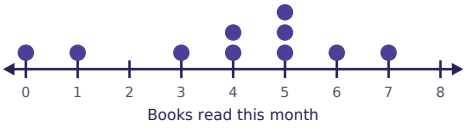

Dot Plots & Histograms · 4

How many games are shown in the histogram in all?

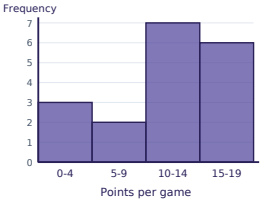

Dot Plots & Histograms · 5

Each dot stands for one student. How many students have exactly 5 siblings?

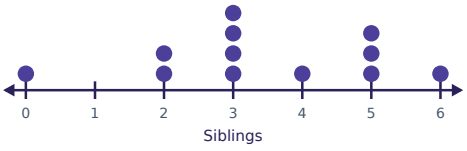

Dot Plots & Histograms · 6

Which interval has the most data? Write the interval as it is labeled.

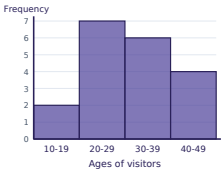

Dot Plots & Histograms · 7

Each dot stands for one student. How many students watched more than 3 hours of TV?

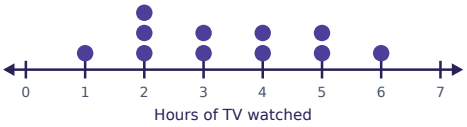

Dot Plots & Histograms · 8

How many students are in the 50-59 interval?

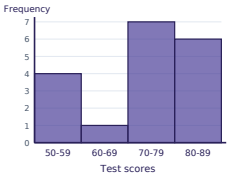

Dot Plots & Histograms · 2

ANSWER

4

Dot Plots & Histograms · 1

ANSWER

10

Dot Plots & Histograms · 4

ANSWER

18

Dot Plots & Histograms · 3

ANSWER

5

Dot Plots & Histograms · 6

ANSWER

20–29

Dot Plots & Histograms · 5

ANSWER

3

Dot Plots & Histograms · 8

ANSWER

4

Dot Plots & Histograms · 7

ANSWER

5

Dot Plots & Histograms · 9

Each dot stands for one student. How many students are in the dot plot?



Dot Plots & Histograms · 10

How many games are in the 5-9 interval?

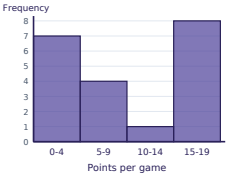

Dot Plots & Histograms · 11

Each dot stands for one student. What is the mode? (The mode is the value with the most dots above it.)

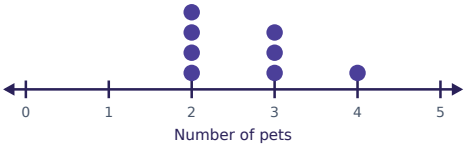

Dot Plots & Histograms · 12

How many students are shown in the histogram in all?

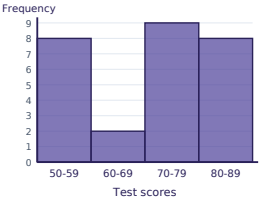

Dot Plots & Histograms · 13

Each dot stands for one student. How many students read exactly 6 books this month?



Dot Plots & Histograms · 14

Which interval has the most data? Write the interval as it is labeled.

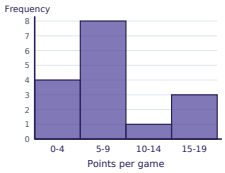

Dot Plots & Histograms · 15

Each dot stands for one student. How many students read more than 3 books this month?



Dot Plots & Histograms · 16

How many plants are in the 30-39 interval?

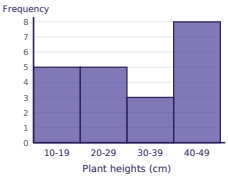

Dot Plots & Histograms · 10

ANSWER

4

Dot Plots & Histograms · 9

ANSWER

12

Dot Plots & Histograms · 12

ANSWER

27

Dot Plots & Histograms · 11

ANSWER

2

Dot Plots & Histograms · 14

ANSWER

5-9

Dot Plots & Histograms · 13

ANSWER

2

Dot Plots & Histograms · 16

ANSWER

3

Dot Plots & Histograms · 15

ANSWER

6

Each dot stands for one student. How many students are in the dot plot?

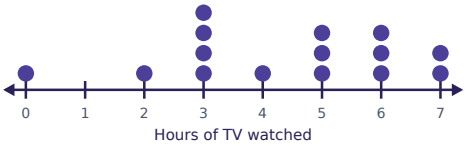

How many students are in the 0-4 interval?

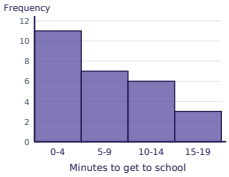

Each dot stands for one student. What is the mode? (The mode is the value with the most dots above it.)



How many games are shown in the histogram in all?

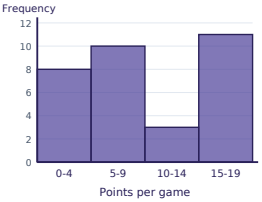

Each dot stands for one student. What is the median number of books read?



How many students had a value of at least 10?

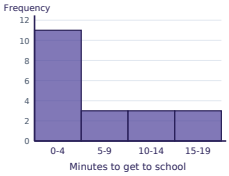

Each dot stands for one student. What is the range of the data? (Range = greatest value − least value.)



Which interval has the most data? Write the interval as it is labeled.

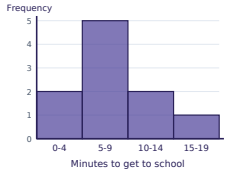

Dot Plots & Histograms · 18

ANSWER

11

Dot Plots & Histograms · 17

ANSWER

15

Dot Plots & Histograms · 20

ANSWER

32

Dot Plots & Histograms · 19

ANSWER

1

Dot Plots & Histograms · 22

ANSWER

6

Dot Plots & Histograms · 21

ANSWER

1

Dot Plots & Histograms · 24

ANSWER

5-9

Dot Plots & Histograms · 23

ANSWER

8