Task card 1 Area of Triangles, Parallelograms...

Find the area of the parallelogram in square meters.

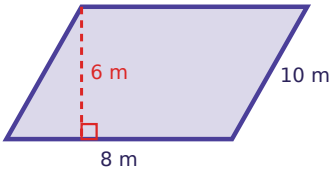

Task card 2 Area of Triangles, Parallelograms...

Find the area of the triangle in square centimeters.

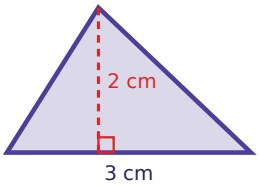

Task card 3 Area of Triangles, Parallelograms...

Find the area of the parallelogram in square meters.

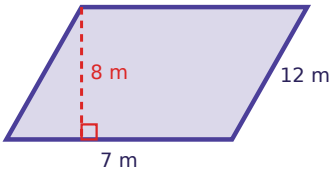

Task card 4 Area of Triangles, Parallelograms...

Find the area of the triangle in square inches.

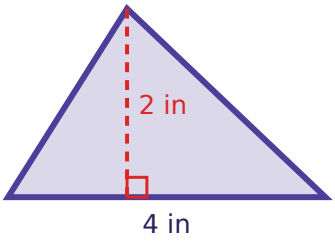

Task card 5 Area of Triangles, Parallelograms...

Find the area of the trapezoid in square inches.

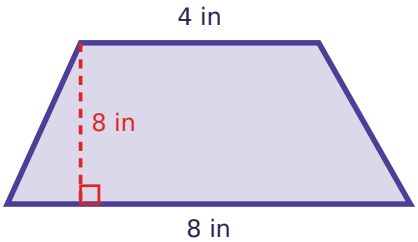

Task card 6 Area of Triangles, Parallelograms...

Find the area of the triangle in square feet.

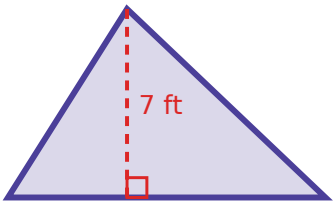

Task card 7 Area of Triangles, Parallelograms...

Find the area of the parallelogram in square yards.

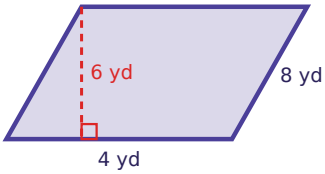

Task card 8 Area of Triangles, Parallelograms...

Find the area of the trapezoid in square meters.

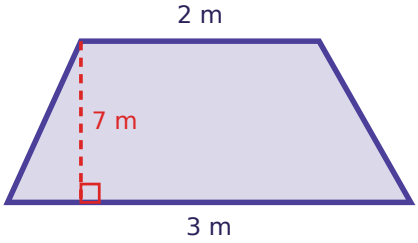

Task card 9 Area of Triangles, Parallelograms...

Find the area of the parallelogram in square meters.

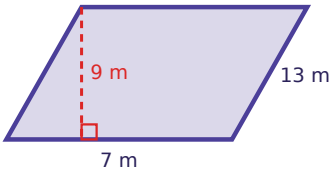

Task card 10 Area of Triangles, Parallelograms...

Find the area of the triangle in square yards.

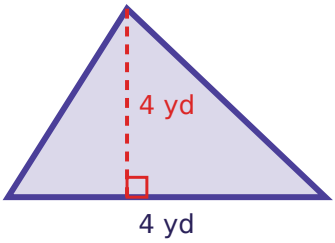

Task card 11 Area of Triangles, Parallelograms...

Find the area of the parallelogram in square inches.

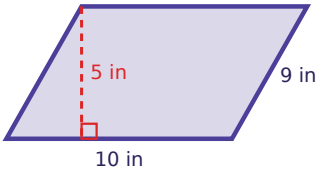

Task card 12 Area of Triangles, Parallelograms...

Find the area of the triangle in square yards.

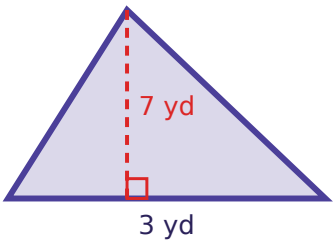

Task card 13 Area of Triangles, Parallelograms...

Find the area of the trapezoid in square meters.

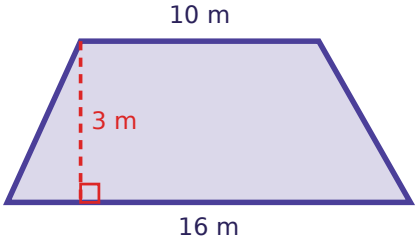

Task card 14 Area of Triangles, Parallelograms...

Find the area of the triangle in square inches.

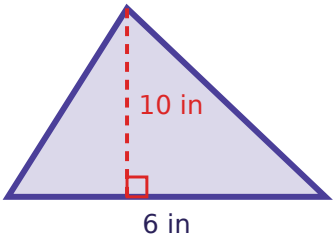

Task card 15 Area of Triangles, Parallelograms...

Find the area of the parallelogram in square feet.

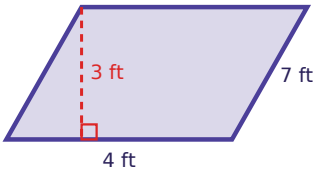

Task card 16 Area of Triangles, Parallelograms...

Find the area of the trapezoid in square feet.

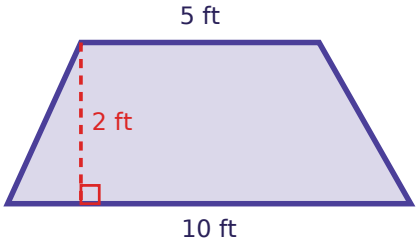

Task card 17 Area of Triangles, Parallelograms...

Find the area of the triangle in square inches.

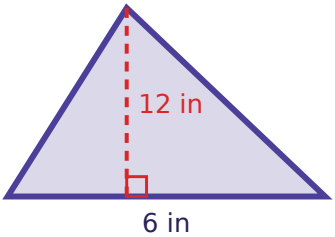

Task card 18 Area of Triangles, Parallelograms...

Find the area of the parallelogram in square meters.

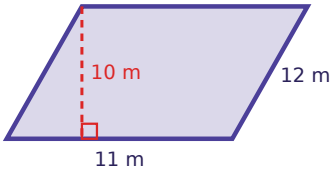

Task card 19 Area of Triangles, Parallelograms...

Find the area of the trapezoid in square meters.

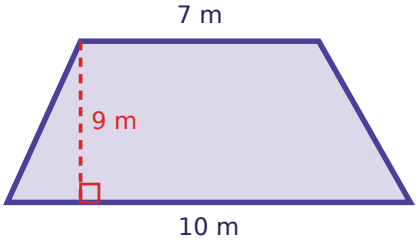

Task card 20 Area of Triangles, Parallelograms...

Find the area of the triangle in square feet.

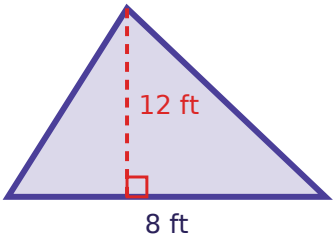

Task card 21 Area of Triangles, Parallelograms...

Find the area of the trapezoid in square centimeters.

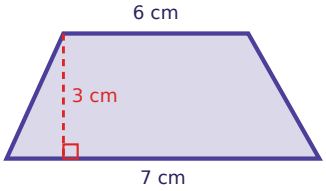

Task card 22 Area of Triangles, Parallelograms...

Find the area of the parallelogram in square centimeters.

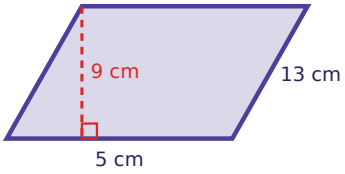

Task card 23 Area of Triangles, Parallelograms...

Find the area of the trapezoid in square centimeters.

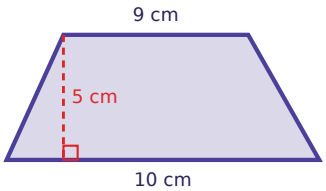

Task card 24 Area of Triangles, Parallelograms...

Find the area of the triangle in square centimeters.

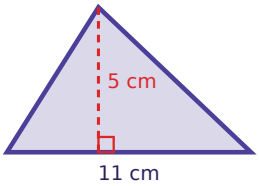

Area of Triangles, Parallelograms & Trapezoids Task Cards

Recording sheet · Grade 6 · Find each area or missing length. Use the height, not the slanted side.

Scan to check your answers

Name: _____ Date: _____

1	2	3	4
5	6	7	8
9	10	11	12
13	14	15	16
17	18	19	20
21	22	23	24

Area of Triangles, Parallelograms & Trapezoids Task Cards: Answer Key

Grade 6 · Easy

The answers online

1. 48	**2.** 3	**3.** 56
4. 4	**5.** 48	**6.** 17.5
7. 24	**8.** 17.5	**9.** 63
10. 8	**11.** 50	**12.** 10.5
13. 39	**14.** 30	**15.** 12
16. 15	**17.** 36	**18.** 110
19. 76.5	**20.** 48	**21.** 19.5
22. 45	**23.** 47.5	**24.** 27.5