Area of Triangles, Parallelograms & Trapezoids · 1

Find the area of the triangle in square feet.

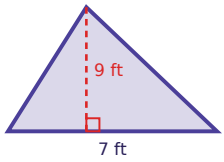

Area of Triangles, Parallelograms & Trapezoids · 2

Find the area of the parallelogram in square yards.

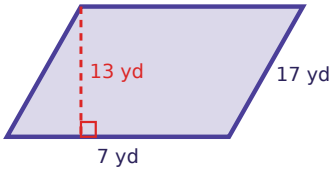

Area of Triangles, Parallelograms & Trapezoids · 3

Find the area of the trapezoid in square yards.

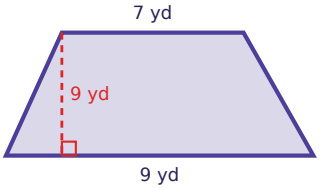

Area of Triangles, Parallelograms & Trapezoids · 4

Find the area of the triangle in square yards.

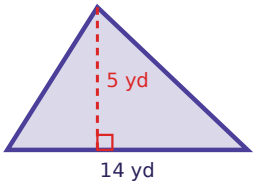

Area of Triangles, Parallelograms & Trapezoids · 5

Find the area of the trapezoid in square yards.

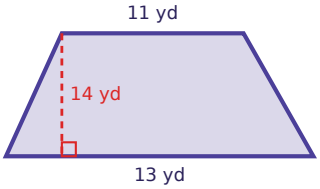

Area of Triangles, Parallelograms & Trapezoids · 6

Find the area of the parallelogram in square centimeters.

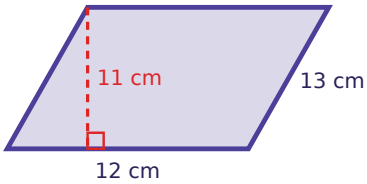

Area of Triangles, Parallelograms & Trapezoids · 7

Find the area of the trapezoid in square inches.

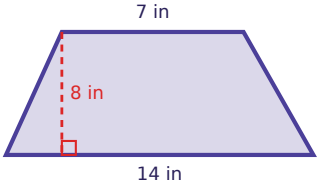

Area of Triangles, Parallelograms & Trapezoids · 8

Find the area of the triangle in square meters.

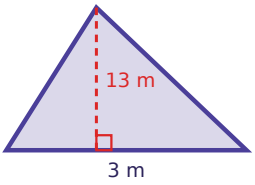

Area of Triangles, Parallelograms & Trapezoids · 2

ANSWER

91

Area of Triangles, Parallelograms & Trapezoids · 1

ANSWER

31.5

Area of Triangles, Parallelograms & Trapezoids · 4

ANSWER

35

Area of Triangles, Parallelograms & Trapezoids · 3

ANSWER

72

Area of Triangles, Parallelograms & Trapezoids · 6

ANSWER

132

Area of Triangles, Parallelograms & Trapezoids · 5

ANSWER

168

Area of Triangles, Parallelograms & Trapezoids · 8

ANSWER

19.5

Area of Triangles, Parallelograms & Trapezoids · 7

ANSWER

84

Find the area of the triangle in square meters.

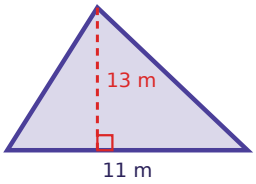

Find the area of the parallelogram in square yards.

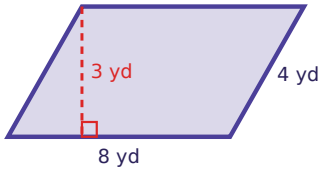

Find the area of the trapezoid in square feet.

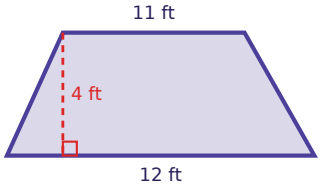

Find the area of the triangle in square meters.

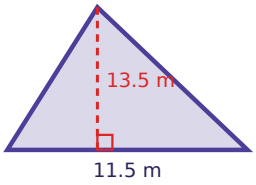

Find the area of the trapezoid in square yards.

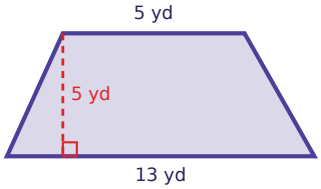

Find the area of the parallelogram in square centimeters.

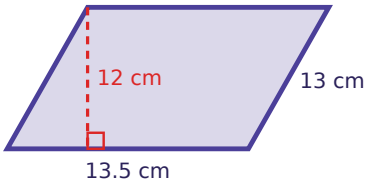

Find the area of the trapezoid in square feet.

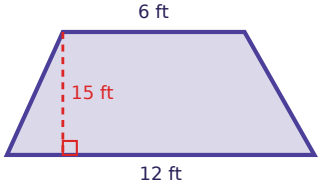

Find the area of the triangle in square inches.

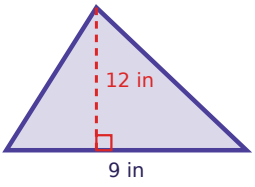

Area of Triangles, Parallelograms & Trapezoids · 10

ANSWER

24

Area of Triangles, Parallelograms & Trapezoids · 9

ANSWER

71.5

Area of Triangles, Parallelograms & Trapezoids · 12

ANSWER

77.625

Area of Triangles, Parallelograms & Trapezoids · 11

ANSWER

46

Area of Triangles, Parallelograms & Trapezoids · 14

ANSWER

162

Area of Triangles, Parallelograms & Trapezoids · 13

ANSWER

45

Area of Triangles, Parallelograms & Trapezoids · 16

ANSWER

54

Area of Triangles, Parallelograms & Trapezoids · 15

ANSWER

135

Find the area of the triangle in square meters.

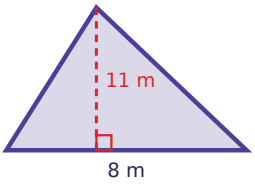

Find the area of the parallelogram in square inches.

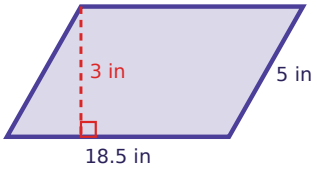

Find the area of the trapezoid in square centimeters.

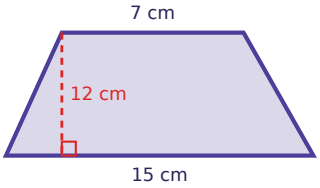

The triangle has an area of 60.5 square feet. What is its height h, in feet?

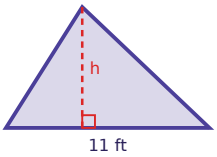

Find the area of the trapezoid in square inches.

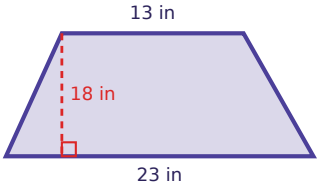

Find the area of the triangle in square meters.

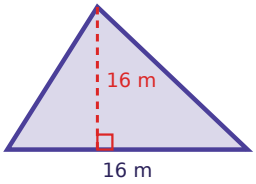

The trapezoid has an area of 168 square inches. What is the length of the bottom base b, in inches?

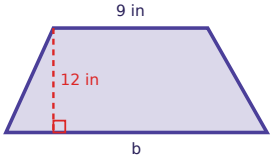

The parallelogram has an area of 30 square yards. What is its height h, in yards?

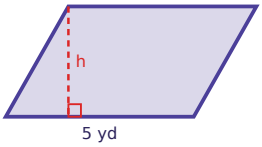

Area of Triangles, Parallelograms & Trapezoids · 18

ANSWER

55.5

Area of Triangles, Parallelograms & Trapezoids · 17

ANSWER

44

Area of Triangles, Parallelograms & Trapezoids · 20

ANSWER

11

Area of Triangles, Parallelograms & Trapezoids · 19

ANSWER

132

Area of Triangles, Parallelograms & Trapezoids · 22

ANSWER

128

Area of Triangles, Parallelograms & Trapezoids · 21

ANSWER

324

Area of Triangles, Parallelograms & Trapezoids · 24

ANSWER

6

Area of Triangles, Parallelograms & Trapezoids · 23

ANSWER

19