Area of Triangles, Parallelograms & Trapezoids · 1

Find the area of the triangle in square centimeters.

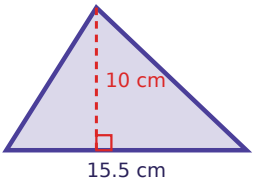

Area of Triangles, Parallelograms & Trapezoids · 2

Find the area of the parallelogram in square centimeters.

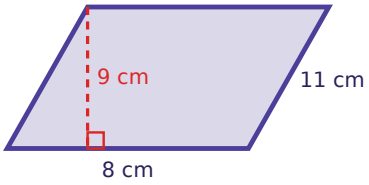

Area of Triangles, Parallelograms & Trapezoids · 3

Find the area of the trapezoid in square yards.

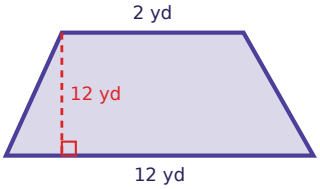

Area of Triangles, Parallelograms & Trapezoids · 4

The parallelogram has an area of 9 square feet. What is its height h, in feet?

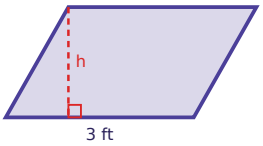

Area of Triangles, Parallelograms & Trapezoids · 5

Find the area of the trapezoid in square meters.

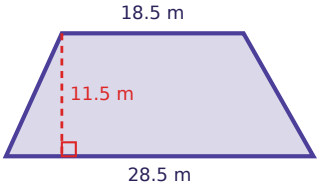

Area of Triangles, Parallelograms & Trapezoids · 6

Find the area of the triangle in square meters.

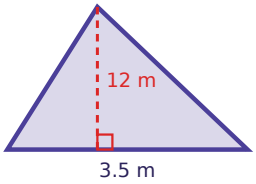

Area of Triangles, Parallelograms & Trapezoids · 7

The trapezoid has an area of 9 square feet. What is the length of the bottom base b, in feet?

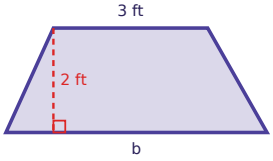

Area of Triangles, Parallelograms & Trapezoids · 8

The triangle has an area of 15 square yards. What is its height h, in yards?

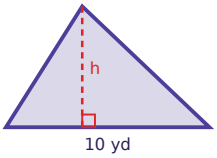

Area of Triangles, Parallelograms & Trapezoids · 2

ANSWER

72

Area of Triangles, Parallelograms & Trapezoids · 1

ANSWER

77.5

Area of Triangles, Parallelograms & Trapezoids · 4

ANSWER

3

Area of Triangles, Parallelograms & Trapezoids · 3

ANSWER

84

Area of Triangles, Parallelograms & Trapezoids · 6

ANSWER

21

Area of Triangles, Parallelograms & Trapezoids · 5

ANSWER

270.25

Area of Triangles, Parallelograms & Trapezoids · 8

ANSWER

3

Area of Triangles, Parallelograms & Trapezoids · 7

ANSWER

6

Find the area of the triangle in square meters.

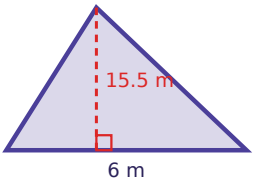

Find the area of the parallelogram in square meters.

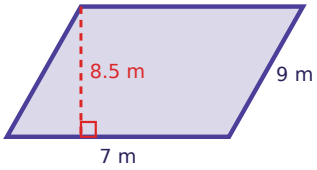

Find the area of the trapezoid in square feet.

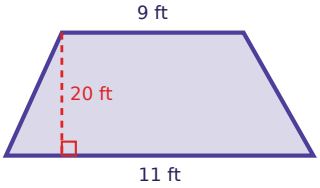

The parallelogram has an area of 24 square inches. What is its height h, in inches?

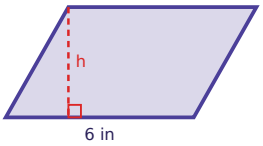

Find the area of the trapezoid in square inches.

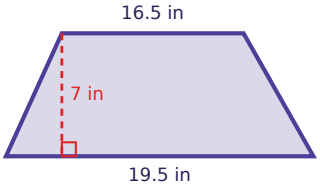

Find the area of the triangle in square meters.

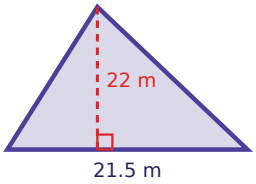

The trapezoid has an area of 103.5 square centimeters. What is the length of the bottom base b, in centimeters?

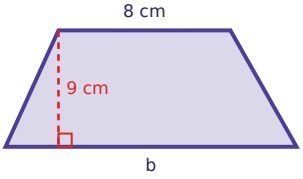

The triangle has an area of 90 square yards. What is its height h, in yards?

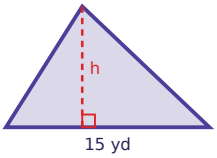

Area of Triangles, Parallelograms & Trapezoids · 10

ANSWER

59.5

Area of Triangles, Parallelograms & Trapezoids · 9

ANSWER

46.5

Area of Triangles, Parallelograms & Trapezoids · 12

ANSWER

4

Area of Triangles, Parallelograms & Trapezoids · 11

ANSWER

200

Area of Triangles, Parallelograms & Trapezoids · 14

ANSWER

236.5

Area of Triangles, Parallelograms & Trapezoids · 13

ANSWER

126

Area of Triangles, Parallelograms & Trapezoids · 16

ANSWER

12

Area of Triangles, Parallelograms & Trapezoids · 15

ANSWER

15

Area of Triangles, Parallelograms & Trapezoids · 17

Find the area of the triangle in square meters.

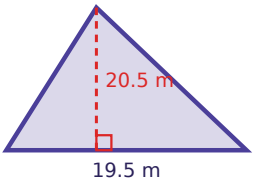

Area of Triangles, Parallelograms & Trapezoids · 18

Find the area of the parallelogram in square meters.

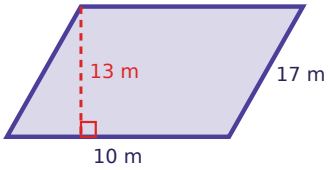

Area of Triangles, Parallelograms & Trapezoids · 19

Find the area of the trapezoid in square centimeters.

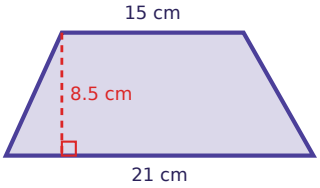

Area of Triangles, Parallelograms & Trapezoids · 20

The parallelogram has an area of 45 square yards. What is its height h, in yards?

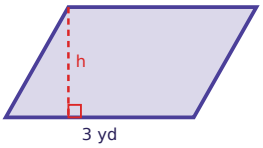

Area of Triangles, Parallelograms & Trapezoids · 21

Find the area of the trapezoid in square meters.

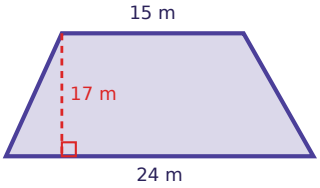

Area of Triangles, Parallelograms & Trapezoids · 22

Find the area of the triangle in square feet.

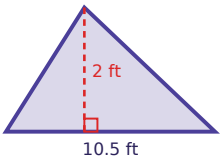

Area of Triangles, Parallelograms & Trapezoids · 23

The trapezoid has an area of 156 square meters. What is the length of the bottom base b, in meters?

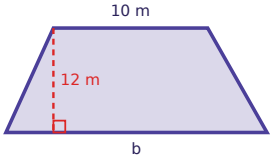

Area of Triangles, Parallelograms & Trapezoids · 24

The parallelogram has an area of 42 square yards. What is its height h, in yards?

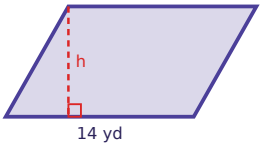

Area of Triangles, Parallelograms & Trapezoids · 18

ANSWER

130

Area of Triangles, Parallelograms & Trapezoids · 17

ANSWER

199.875

Area of Triangles, Parallelograms & Trapezoids · 20

ANSWER

15

Area of Triangles, Parallelograms & Trapezoids · 19

ANSWER

153

Area of Triangles, Parallelograms & Trapezoids · 22

ANSWER

10.5

Area of Triangles, Parallelograms & Trapezoids · 21

ANSWER

331.5

Area of Triangles, Parallelograms & Trapezoids · 24

ANSWER

3

Area of Triangles, Parallelograms & Trapezoids · 23

ANSWER

16