Task card 1 Area of Composite Figures

Find the area of the figure in square feet.

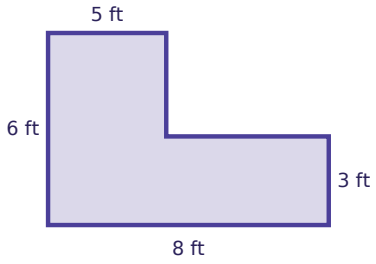

Task card 2 Area of Composite Figures

Find the area of the shaded region in square meters.

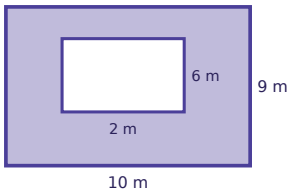

Task card 3 Area of Composite Figures

Find the area of the figure in square centimeters.

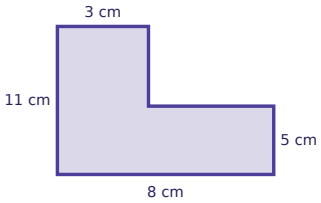

Task card 4 Area of Composite Figures

Find the area of the figure in square feet.

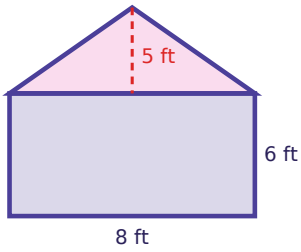

Task card 5 Area of Composite Figures

Find the area of the shaded region in square meters.

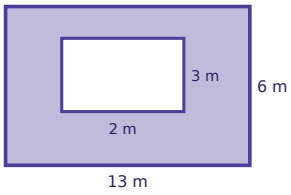

Task card 6 Area of Composite Figures

Find the area of the figure in square inches.

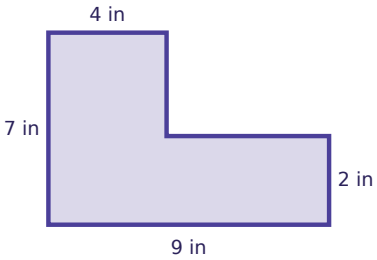

Task card 7 Area of Composite Figures

Find the area of the figure in square inches.

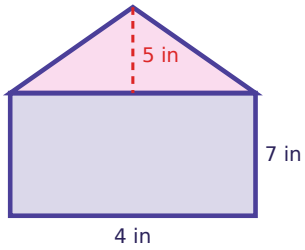

Task card 8 Area of Composite Figures

Find the area of the shaded region in square centimeters.

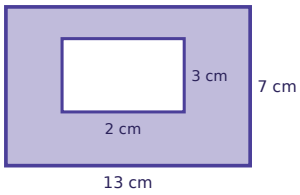

Task card 9 Area of Composite Figures

Find the area of the figure in square meters.

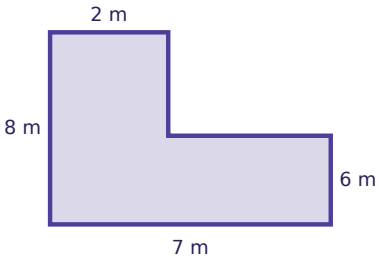

Task card 10 Area of Composite Figures

Find the area of the shaded region in square yards.

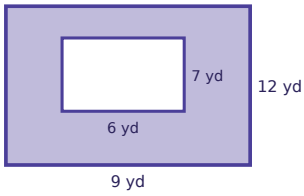

Task card 11 Area of Composite Figures

Find the area of the figure in square inches.

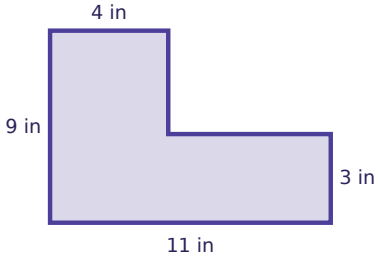

Task card 12 Area of Composite Figures

Find the area of the figure in square inches.

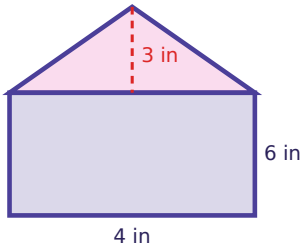

Task card 13 Area of Composite Figures

Find the area of the shaded region in square meters.

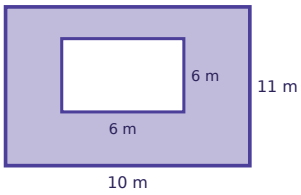

Task card 14 Area of Composite Figures

Find the area of the figure in square inches.

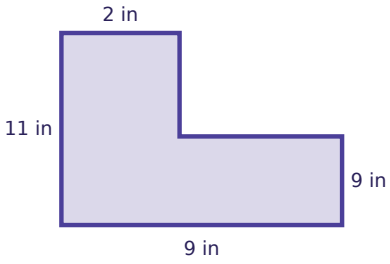

Task card 15 Area of Composite Figures

Find the area of the figure in square meters.

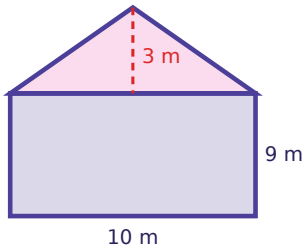

Task card 16 Area of Composite Figures

Find the area of the shaded region in square centimeters.

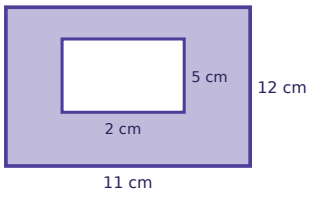

Task card 17 Area of Composite Figures

Find the area of the figure in square feet.

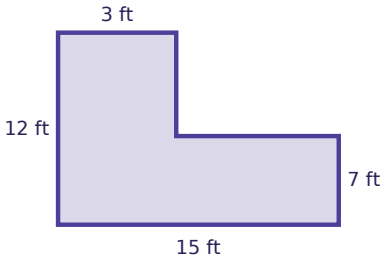

Task card 18 Area of Composite Figures

Find the area of the figure in square feet.

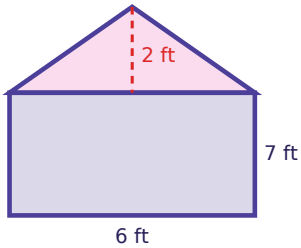

Task card 19 Area of Composite Figures

Find the area of the shaded region in square inches.

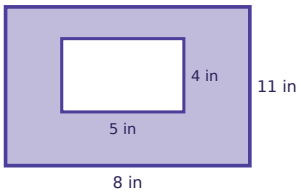

Task card 20 Area of Composite Figures

Find the area of the figure in square meters.

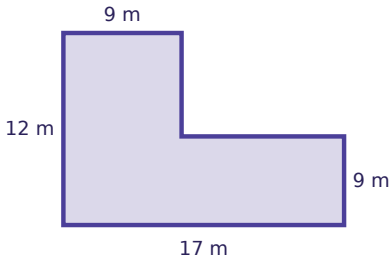

Task card 21 Area of Composite Figures

Find the area of the figure in square centimeters.

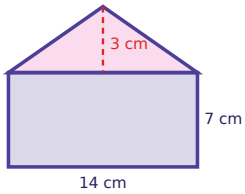

Task card 22 Area of Composite Figures

Find the area of the shaded region in square yards.

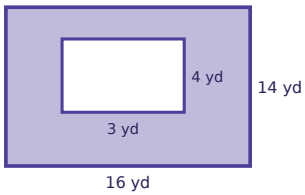

Task card 23 Area of Composite Figures

Find the perimeter of the figure in yards.

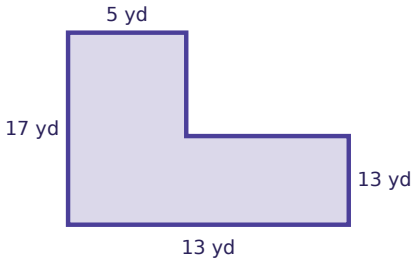

Task card 24 Area of Composite Figures

Find the area of the figure in square centimeters.

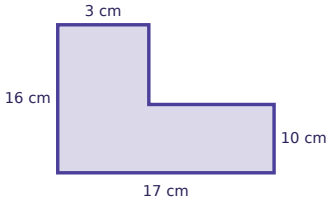

Area of Composite Figures Task Cards

Recording sheet · Grade 6 · Find the area (or perimeter) of each figure. Figures are not drawn to scale.

Name: _____ Date: _____

Scan to check your answers

1	2	3	4
5	6	7	8
9	10	11	12
13	14	15	16
17	18	19	20
21	22	23	24

Area of Composite Figures Task Cards: Answer Key

Grade 6 · Easy

The answers online

1. 39	**2.** 78	**3.** 58
4. 68	**5.** 72	**6.** 38
7. 38	**8.** 85	**9.** 46
10. 66	**11.** 57	**12.** 30
13. 74	**14.** 85	**15.** 105
16. 122	**17.** 120	**18.** 48
19. 68	**20.** 180	**21.** 119
22. 212	**23.** 60	**24.** 188