Area of Composite Figures · 1

Find the area of the figure in square meters.

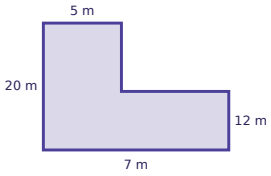

Area of Composite Figures · 2

Find the area of the figure in square meters.

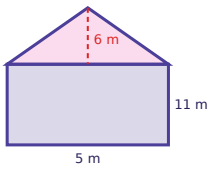

Area of Composite Figures · 3

Find the area of the shaded region in square yards.

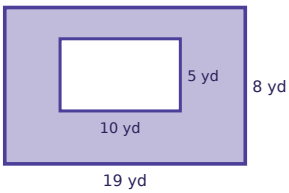

Area of Composite Figures · 4

Find the area of the figure in square centimeters.

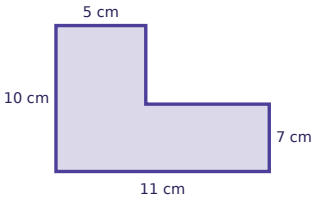

Area of Composite Figures · 5

Find the area of the figure in square yards.

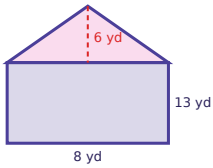

Area of Composite Figures · 6

Find the area of the shaded region in square meters.

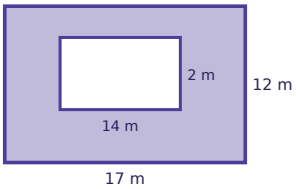

Area of Composite Figures · 7

Find the perimeter of the figure in meters.

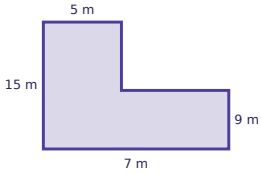

Area of Composite Figures · 8

Find the area of the figure in square meters.

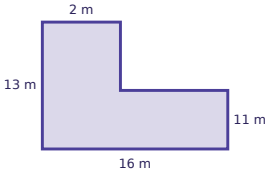

Area of Composite Figures · 2

ANSWER

70

Area of Composite Figures · 1

ANSWER

124

Area of Composite Figures · 4

ANSWER

92

Area of Composite Figures · 3

ANSWER

102

Area of Composite Figures · 6

ANSWER

176

Area of Composite Figures · 5

ANSWER

128

Area of Composite Figures · 8

ANSWER

180

Area of Composite Figures · 7

ANSWER

44

Area of Composite Figures · 9

Find the area of the figure in square feet.

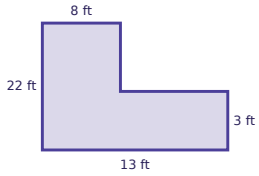

Area of Composite Figures · 10

Find the area of the figure in square meters.

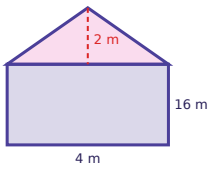

Area of Composite Figures · 11

Find the area of the shaded region in square yards.

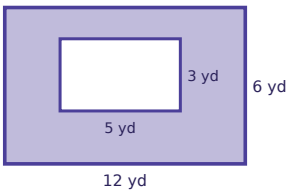

Area of Composite Figures · 12

Find the perimeter of the figure in meters.

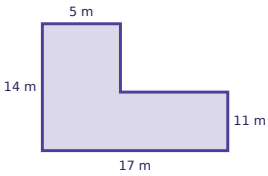

Area of Composite Figures · 13

Find the area of the figure in square centimeters.

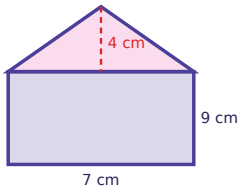

Area of Composite Figures · 14

Find the area of the figure in square centimeters.

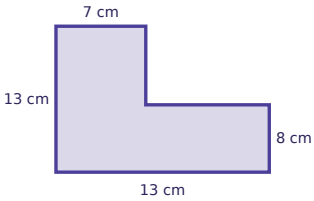

Area of Composite Figures · 15

Find the area of the shaded region in square yards.

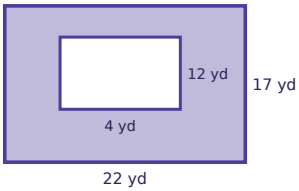

Area of Composite Figures · 16

Find the area of the figure in square yards.

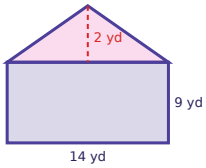

Area of Composite Figures · 10

ANSWER

68

Area of Composite Figures · 9

ANSWER

191

Area of Composite Figures · 12

ANSWER

62

Area of Composite Figures · 11

ANSWER

57

Area of Composite Figures · 14

ANSWER

139

Area of Composite Figures · 13

ANSWER

77

Area of Composite Figures · 16

ANSWER

140

Area of Composite Figures · 15

ANSWER

326

Area of Composite Figures · 17

Find the area of the figure in square meters.

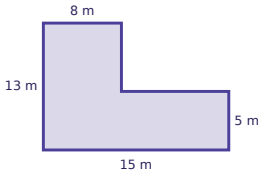

Area of Composite Figures · 18

Find the area of the figure in square feet.

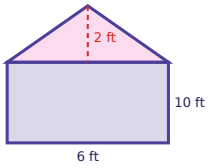

Area of Composite Figures · 19

Find the area of the shaded region in square meters.

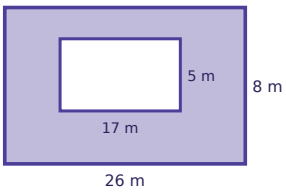

Area of Composite Figures · 20

Find the perimeter of the figure in feet.

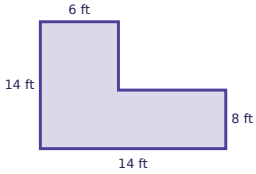

Area of Composite Figures · 21

Find the area of the figure in square meters.

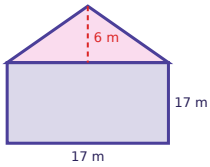

Area of Composite Figures · 22

Find the area of the figure in square centimeters.

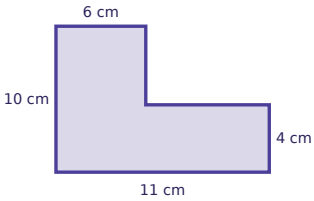

Area of Composite Figures · 23

Find the area of the shaded region in square yards.

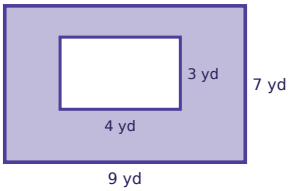

Area of Composite Figures · 24

Find the area of the figure in square inches.

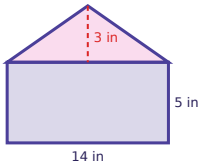

Area of Composite Figures · 18

ANSWER

66

Area of Composite Figures · 17

ANSWER

139

Area of Composite Figures · 20

ANSWER

56

Area of Composite Figures · 19

ANSWER

123

Area of Composite Figures · 22

ANSWER

80

Area of Composite Figures · 21

ANSWER

340

Area of Composite Figures · 24

ANSWER

91

Area of Composite Figures · 23

ANSWER

51