Area of Composite Figures · 1

Find the area of the figure in square feet.

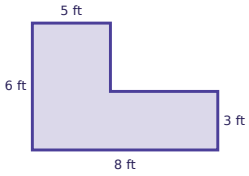

Area of Composite Figures · 2

Find the area of the shaded region in square meters.

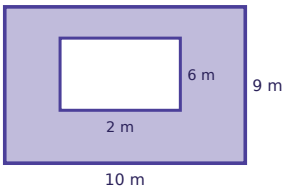

Area of Composite Figures · 3

Find the area of the figure in square centimeters.

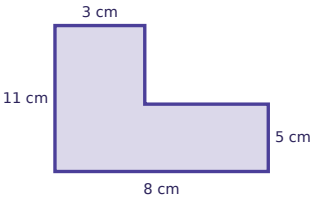

Area of Composite Figures · 4

Find the area of the figure in square feet.

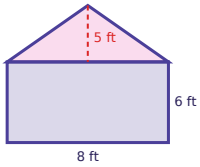

Area of Composite Figures · 5

Find the area of the shaded region in square meters.

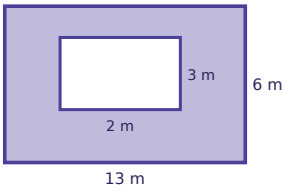

Area of Composite Figures · 6

Find the area of the figure in square inches.

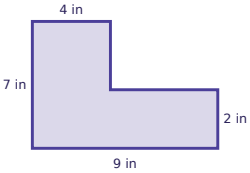

Area of Composite Figures · 7

Find the area of the figure in square inches.

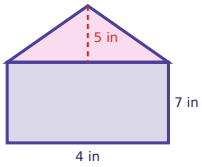

Area of Composite Figures · 8

Find the area of the shaded region in square centimeters.

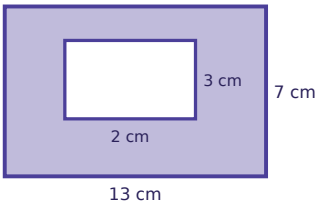

Area of Composite Figures · 2

ANSWER

78

Area of Composite Figures · 1

ANSWER

39

Area of Composite Figures · 4

ANSWER

68

Area of Composite Figures · 3

ANSWER

58

Area of Composite Figures · 6

ANSWER

38

Area of Composite Figures · 5

ANSWER

72

Area of Composite Figures · 8

ANSWER

85

Area of Composite Figures · 7

ANSWER

38

Area of Composite Figures · 9

Find the area of the figure in square meters.

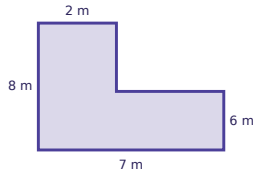

Area of Composite Figures · 10

Find the area of the shaded region in square yards.

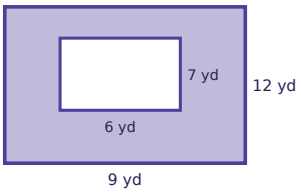

Area of Composite Figures · 11

Find the area of the figure in square inches.

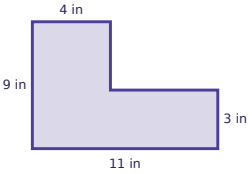

Area of Composite Figures · 12

Find the area of the figure in square inches.

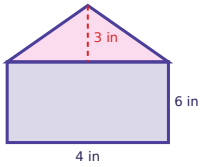

Area of Composite Figures · 13

Find the area of the shaded region in square meters.

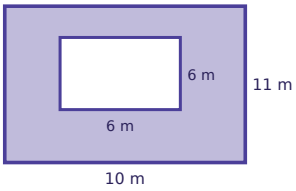

Area of Composite Figures · 14

Find the area of the figure in square inches.

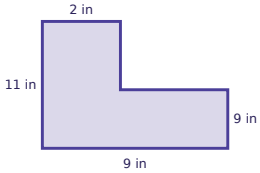

Area of Composite Figures · 15

Find the area of the figure in square meters.

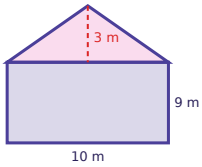

Area of Composite Figures · 16

Find the area of the shaded region in square centimeters.

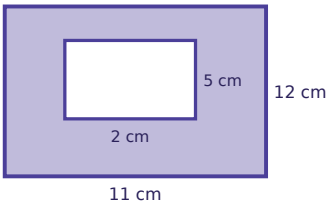

Area of Composite Figures · 10

ANSWER

66

Area of Composite Figures · 9

ANSWER

46

Area of Composite Figures · 12

ANSWER

30

Area of Composite Figures · 11

ANSWER

57

Area of Composite Figures · 14

ANSWER

85

Area of Composite Figures · 13

ANSWER

74

Area of Composite Figures · 16

ANSWER

122

Area of Composite Figures · 15

ANSWER

105

Area of Composite Figures · 17

Find the area of the figure in square feet.

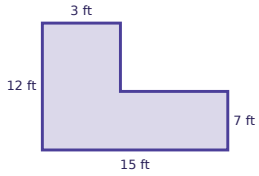

Area of Composite Figures · 18

Find the area of the figure in square feet.

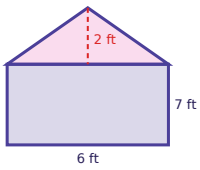

Area of Composite Figures · 19

Find the area of the shaded region in square inches.

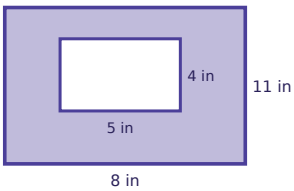

Area of Composite Figures · 20

Find the area of the figure in square meters.

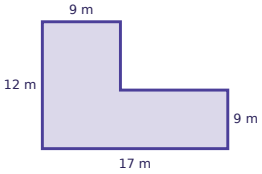

Area of Composite Figures · 21

Find the area of the figure in square centimeters.

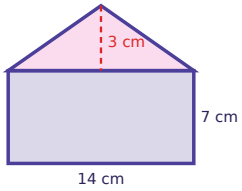

Area of Composite Figures · 22

Find the area of the shaded region in square yards.

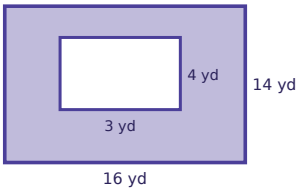

Area of Composite Figures · 23

Find the perimeter of the figure in yards.

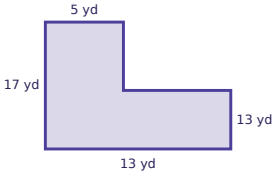

Area of Composite Figures · 24

Find the area of the figure in square centimeters.

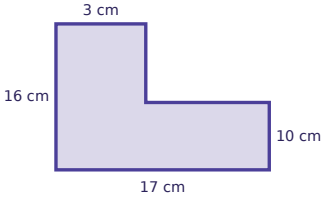

Area of Composite Figures · 18

ANSWER

48

Area of Composite Figures · 17

ANSWER

120

Area of Composite Figures · 20

ANSWER

180

Area of Composite Figures · 19

ANSWER

68

Area of Composite Figures · 22

ANSWER

212

Area of Composite Figures · 21

ANSWER

119

Area of Composite Figures · 24

ANSWER

188

Area of Composite Figures · 23

ANSWER

60