Task card 1 Winter Math

One winter hat costs $12.80. Ben buys 2 winter hats. How much does Ben spend?

Task card 2 Winter Math

One batch of a recipe uses $\frac{3}{4}$ cup of mini marshmallows. Zoe makes 3 batches. How many cups of mini marshmallows does Zoe use?

Task card 3 Winter Math

A cookie box is 4 inches long, 4 inches wide and 7 inches tall. What is its volume in cubic inches?

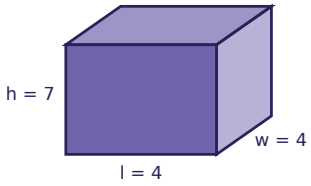

Task card 4 Winter Math

A cookie box is 9 inches long, 8 inches wide and 3 inches tall. What is its volume in cubic inches?

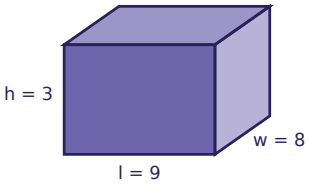

Task card 5 Winter Math

One cup of hot cocoa costs $3.50. Omar buys 3 cups of hot cocoa. How much does Omar spend?

Task card 6 Winter Math

One batch of a recipe uses $\frac{1}{4}$ cup of mini marshmallows. Ava makes 5 batches. How many cups of mini marshmallows does Ava use?

Task card 7 Winter Math

Sam buys a winter hat for $9.60 and pays with a $10 bill. How much change does Sam get?

Task card 8 Winter Math

Noah buys a pair of mittens for $7.90 and pays with a $10 bill. How much change does Noah get?

Task card 9 Winter Math

One batch of a recipe uses $\frac{3}{4}$ cup of mini marshmallows. Ava makes 2 batches. How many cups of mini marshmallows does Ava use?

Task card 10 Winter Math

One cup of hot cocoa costs $3.25. Ava buys 8 cups of hot cocoa. How much does Ava spend?

Task card 11 Winter Math

A cookie box is 10 inches long, 3 inches wide and 5 inches tall. What is its volume in cubic inches?

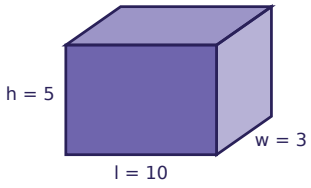

Task card 12 Winter Math

Lily buys a winter hat for $8.56 and pays with a $10 bill. How much change does Lily get?

Task card 13 Winter Math

A cookie box is 11 inches long, 6 inches wide and 7 inches tall. What is its volume in cubic inches?

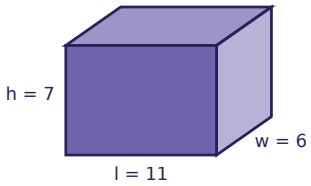

Task card 14 Winter Math

Omar buys a winter hat for $6.75 and pays with a $10 bill. How much change does Omar get?

Task card 15 Winter Math

One batch of a recipe uses $\frac{5}{6}$ cup of mini marshmallows. Ella makes 4 batches. How many cups of mini marshmallows does Ella use?

Task card 16 Winter Math

One pair of mittens costs $5.15. Zoe buys 3 pairs of mittens. How much does Zoe spend?

Task card 17 Winter Math

A cookie box is 8 inches long, 8 inches wide and 7 inches tall. What is its volume in cubic inches?

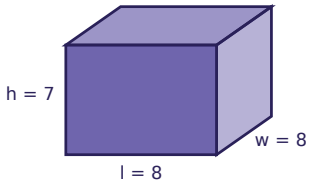

Task card 18 Winter Math

Ben buys a cup of hot cocoa for $3.37 and pays with a $10 bill. How much change does Ben get?

Task card 19 Winter Math

Mia buys a cup of hot cocoa for $3.57 and pays with a $10 bill. How much change does Mia get?

Task card 20 Winter Math

A cookie box is 8 inches long, 7 inches wide and 4 inches tall. What is its volume in cubic inches?

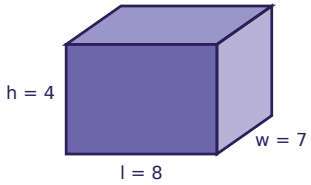

Task card 21 Winter Math

One batch of a recipe uses $\frac{5}{6}$ cup of mini marshmallows. Sam makes 3 batches. How many cups of mini marshmallows does Sam use?

Task card 22 Winter Math

One batch of a recipe uses $\frac{5}{8}$ cup of mini marshmallows. Noah makes 5 batches. How many cups of mini marshmallows does Noah use?

Task card 23 Winter Math

One winter hat costs $11.35. Ben buys 4 winter hats. How much does Ben spend?

Task card 24 Winter Math

One winter hat costs $8.50. Mia buys 2 winter hats. How much does Mia spend?

Winter Math Task Cards

Recording sheet · Grade 5 · Read each story and solve. Write money like $4.50 and fractions like 1 1/2.

Scan to check your answers

Name: _____ Date: _____

1	2	3	4
5	6	7	8
9	10	11	12
13	14	15	16
17	18	19	20
21	22	23	24

Winter Math Task Cards: Answer Key

Grade 5 · Medium

The answers online

1. $25.60	**2.** $2\frac{1}{4}$	**3.** 112
4. 216	**5.** $10.50	**6.** $1\frac{1}{4}$
7. $0.40	**8.** $2.10	**9.** $1\frac{1}{2}$
10. $26.00	**11.** 150	**12.** $1.44
13. 462	**14.** $3.25	**15.** $3\frac{1}{3}$
16. $15.45	**17.** 448	**18.** $6.63
19. $6.43	**20.** 224	**21.** $2\frac{1}{2}$
22. $3\frac{1}{8}$	**23.** $45.40	**24.** $17.00